Subtraction Within 10

Exit Ticket 7.1: Take away

Name _____ **Exit Ticket 7.1**

1. Cupcakes with an X are gone. How many are left?

2. Pineapples with an X are gone. How many are left?



I can tell how many are left.

Name _____ **Exit Ticket 7.1**

1. Cupcakes with an X are gone. How many are left?

2. Pineapples with an X are gone. How many are left?



I can tell how many are left.

© 2026 Eggroll Games

Subtraction Within 10

Exit Ticket 7.2: Take from stories

Name _____ **Exit Ticket 7.2**

1. 8 frogs sit on a log. 6 frogs hop into the pond. Cross out 6. How many frogs are left?



2. 10 penguins stand on the ice. 5 jump in the water. Cross out 5. How many penguins are left?



I can act out a take away story.

Name _____ **Exit Ticket 7.2**

1. 8 frogs sit on a log. 6 frogs hop into the pond. Cross out 6. How many frogs are left?



2. 10 penguins stand on the ice. 5 jump in the water. Cross out 5. How many penguins are left?



I can act out a take away story.

© 2026 Eggroll Games

Subtraction Within 10

Exit Ticket 7.3: Minus and equals

Name _____ **Exit Ticket 7.3**

1. Write the number sentence. How many eggs are left?

☐ − ☐ = ☐

2. Write the number sentence. How many ice cream cones are left?

☐ − ☐ = ☐

I can write a number sentence with minus and equals.

Name _____ **Exit Ticket 7.3**

1. Write the number sentence. How many eggs are left?

☐ − ☐ = ☐

2. Write the number sentence. How many ice cream cones are left?

☐ − ☐ = ☐

I can write a number sentence with minus and equals.

© 2026 Eggroll Games

Subtraction Within 10

Exit Ticket 7.4: Take away in a ten frame

Name _____ **Exit Ticket 7.4**

1. Cross out 5 dots. How many are left?



9 – 5 = ☐

2. Cross out 2 dots. How many are left?



7 – 2 = ☐

I can take away in a ten frame.

Name _____ **Exit Ticket 7.4**

1. Cross out 5 dots. How many are left?



9 – 5 = ☐

2. Cross out 2 dots. How many are left?



7 – 2 = ☐

I can take away in a ten frame.

© 2026 Eggroll Games

Subtraction Within 10

Exit Ticket 7.5: Subtract on a number path

Name _____ **Exit Ticket 7.5**

1. Start at 6. Hop back 4 times. Where do you land?

6 − 4 = ☐

0	1	2	3	4	5	6	7	8	9	10

2. Start at 9. Hop back 3 times. Where do you land?

9 − 3 = ☐

0	1	2	3	4	5	6	7	8	9	10

I can subtract by hopping back on a number path.

Name _____ **Exit Ticket 7.5**

1. Start at 6. Hop back 4 times. Where do you land?

6 − 4 = ☐

0	1	2	3	4	5	6	7	8	9	10

2. Start at 9. Hop back 3 times. Where do you land?

9 − 3 = ☐

0	1	2	3	4	5	6	7	8	9	10

I can subtract by hopping back on a number path.

ANIMAL MATH

Find worksheets, teacher tools, and more at animalmath.com

© 2026 Eggroll Games

Subtraction Within 10

Exit Ticket 7.6: Draw to solve

Name _____ **Exit Ticket 7.6**

1. Dad makes 10 burgers. The family eats 3. Draw dots, then cross out. How many are left?

2. There are 8 acorns. A squirrel takes 4. Draw dots, then cross out. How many are left?

I can draw to solve a take away story.

Name _____ **Exit Ticket 7.6**

1. Dad makes 10 burgers. The family eats 3. Draw dots, then cross out. How many are left?

2. There are 8 acorns. A squirrel takes 4. Draw dots, then cross out. How many are left?

I can draw to solve a take away story.

© 2026 Eggroll Games

Subtraction Within 10

Exit Ticket 7.7: Add or subtract

Name _____ **Exit Ticket 7.7**

1. **7** dolphins swim in the sea. **1** more dolphin comes. How many dolphins now? Circle plus or minus. Then write the answer.

7 + − **1** = ☐

2. **9** snakes rest on a rock. **2** snakes go away. How many snakes now? Circle plus or minus. Then write the answer.

9 + − **2** = ☐

I can tell if a story adds or takes away.

Name _____ Exit Ticket 7.7

1. 7 dolphins swim in the sea. 1 more dolphin comes. How many dolphins now? Circle plus or minus. Then write the answer.

7 + − 1 = ☐

2. 9 snakes rest on a rock. 2 snakes go away. How many snakes now? Circle plus or minus. Then write the answer.

9 + − 2 = ☐

I can tell if a story adds or takes away.

© 2026 Eggroll Games

Subtraction Within 10

Exit Ticket 7.8: Subtraction facts to 5

Name _____ **Exit Ticket 7.8**

1. Subtract. Write each answer.

5 − 1 = ☐

4 − 3 = ☐

2. Subtract. Write each answer.

3 − 2 = ☐

2 − 0 = ☐

I can subtract within 5 quickly.

Name _____ **Exit Ticket 7.8**

1. Subtract. Write each answer.

5 − 1 = ☐

4 − 3 = ☐

2. Subtract. Write each answer.

3 − 2 = ☐

2 − 0 = ☐

I can subtract within 5 quickly.

© 2026 Eggroll Games

Subtraction Within 10

Exit Ticket 7.9: Add and subtract to 5

Name _____ **Exit Ticket 7.9**

1. Add or subtract.

2 + 3 = ☐

4 − 1 = ☐

2. Add or subtract.

5 − 3 = ☐

2 + 2 = ☐

I can add and subtract within 5.

Name _____ **Exit Ticket 7.9**

1. Add or subtract.

2 + 3 = ☐

4 − 1 = ☐

2. Add or subtract.

5 − 3 = ☐

2 + 2 = ☐

I can add and subtract within 5.

© 2026 Eggroll Games

Subtraction Within 10

Exit Ticket 7.10: Subtraction facts to 10

Name _____ **Exit Ticket 7.10**

1. Subtract. Write each answer.

8 − 6 = ☐

7 − 1 = ☐

2. Subtract. Write each answer.

6 − 2 = ☐

9 − 8 = ☐

I can subtract within **10**.

Name _____ **Exit Ticket 7.10**

1. Subtract. Write each answer.

8 − 6 = ☐

7 − 1 = ☐

2. Subtract. Write each answer.

6 − 2 = ☐

9 − 8 = ☐

I can subtract within **10**.

ANIMAL MATH

Find worksheets, teacher tools, and more at animalmath.com

© 2026 Eggroll Games

ANSWER KEY

Subtraction Within 10

Exit Ticket 7.1: Take away

Name _____ Exit Ticket 7.1

1. Cupcakes with an X are gone. How many are left?

6

2. Pineapples with an X are gone. How many are left?



3

I can tell how many are left.

Name _____ Exit Ticket 7.1

1. Cupcakes with an X are gone. How many are left?

6

2. Pineapples with an X are gone. How many are left?



3

I can tell how many are left.

© 2026 Eggroll Games

Subtraction Within 10

Exit Ticket 7.2: Take from stories

Name _____ **Exit Ticket 7.2**

1. **8** frogs sit on a log. **6** frogs hop into the pond. Cross out **6**. How many frogs are left?

2

2. **10** penguins stand on the ice. **5** jump in the water. Cross out **5**. How many penguins are left?



5

I can act out a take away story.

Name _____ **Exit Ticket 7.2**

1. **8** frogs sit on a log. **6** frogs hop into the pond. Cross out **6**. How many frogs are left?

2

2. **10** penguins stand on the ice. **5** jump in the water. Cross out **5**. How many penguins are left?



5

I can act out a take away story.

© 2026 Eggroll Games

Subtraction Within 10

Exit Ticket 7.3: Minus and equals

Name _____ **Exit Ticket 7.3**

1. Write the number sentence. How many eggs are left?

5 – 2 = 3

2. Write the number sentence. How many ice cream cones are left?

3 – 1 = 2

I can write a number sentence with minus and equals.

Name _____ Exit Ticket 7.3

1. Write the number sentence. How many eggs are left?

5 – 2 = 3

2. Write the number sentence. How many ice cream cones are left?

3 – 1 = 2

I can write a number sentence with minus and equals.

© 2026 Eggroll Games

ANSWER KEY

Subtraction Within 10

Exit Ticket 7.4: Take away in a ten frame

Name _____ Exit Ticket 7.4

1. Cross out 5 dots. How many are left?



9 – 5 = 4

2. Cross out 2 dots. How many are left?

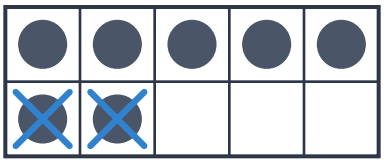

7 – 2 = 5

I can take away in a ten frame.

Name _____ Exit Ticket 7.4

1. Cross out 5 dots. How many are left?



9 – 5 = 4

2. Cross out 2 dots. How many are left?

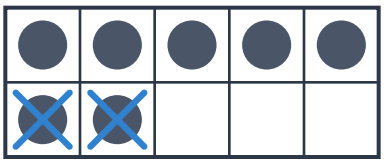

7 – 2 = 5

I can take away in a ten frame.

© 2026 Eggroll Games

ANSWER KEY

Subtraction Within 10

Exit Ticket 7.5: Subtract on a number path

Name _____ Exit Ticket 7.5

1. Start at 6. Hop back 4 times. Where do you land?

6 − 4 = 2

0 1 2 3 4 5 6 7 8 9 10

2. Start at 9. Hop back 3 times. Where do you land?

9 − 3 = 6

0 1 2 3 4 5 6 7 8 9 10

I can subtract by hopping back on a number path.

Name _____ Exit Ticket 7.5

1. Start at 6. Hop back 4 times. Where do you land?

6 − 4 = 2

0 1 2 3 4 5 6 7 8 9 10

2. Start at 9. Hop back 3 times. Where do you land?

9 − 3 = 6

0 1 2 3 4 5 6 7 8 9 10

I can subtract by hopping back on a number path.

© 2026 Eggroll Games

Subtraction Within 10

Exit Ticket 7.6: Draw to solve

Name _____ **Exit Ticket 7.6**

1. Dad makes **10** burgers. The family eats **3**. Draw dots, then cross out. How many are left?

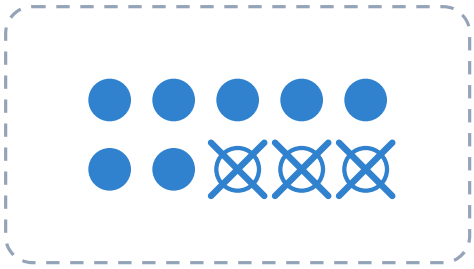

7

2. There are **8** acorns. A squirrel takes **4**. Draw dots, then cross out. How many are left?



4

I can draw to solve a take away story.

Name _____ Exit Ticket 7.6

1. Dad makes 10 burgers. The family eats 3. Draw dots, then cross out. How many are left?

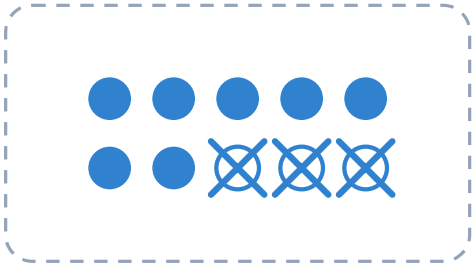

7

2. There are 8 acorns. A squirrel takes 4. Draw dots, then cross out. How many are left?



4

I can draw to solve a take away story.

© 2026 Eggroll Games

ANSWER KEY

Subtraction Within 10

Exit Ticket 7.7: Add or subtract

Name _____ Exit Ticket 7.7

1. **7** dolphins swim in the sea. **1** more dolphin comes. How many dolphins now? Circle plus or minus. Then write the answer.

7 (+) (−) 1 = 8

2. **9** snakes rest on a rock. **2** snakes go away. How many snakes now? Circle plus or minus. Then write the answer.

9 + (−) 2 = 7

I can tell if a story adds or takes away.

Name _____ Exit Ticket 7.7

1. **7** dolphins swim in the sea. **1** more dolphin comes. How many dolphins now? Circle plus or minus. Then write the answer.

7 (+) (−) 1 = 8

2. **9** snakes rest on a rock. **2** snakes go away. How many snakes now? Circle plus or minus. Then write the answer.

9 + (−) 2 = 7

I can tell if a story adds or takes away.

© 2026 Eggroll Games

ANSWER KEY

Subtraction Within 10

Exit Ticket 7.8: Subtraction facts to 5

Name _____ Exit Ticket 7.8

1. Subtract. Write each answer.

5 − 1 = 4

4 − 3 = 1

2. Subtract. Write each answer.

3 − 2 = 1

2 − 0 = 2

I can subtract within **5** quickly.

Name _____ Exit Ticket 7.8

1. Subtract. Write each answer.

5 − 1 = 4

4 − 3 = 1

2. Subtract. Write each answer.

3 − 2 = 1

2 − 0 = 2

I can subtract within **5** quickly.

© 2026 Eggroll Games

ANSWER KEY

Subtraction Within 10

Exit Ticket 7.9: Add and subtract to 5

Name _____ Exit Ticket 7.9

1. Add or subtract.

$2 + 3 = 5$

$4 - 1 = 3$

2. Add or subtract.

$5 - 3 = 2$

$2 + 2 = 4$

I can add and subtract within 5.

Name _____ Exit Ticket 7.9

1. Add or subtract.

$2 + 3 = 5$

$4 - 1 = 3$

2. Add or subtract.

$5 - 3 = 2$

$2 + 2 = 4$

I can add and subtract within 5.

© 2026 Eggroll Games

ANSWER KEY

Subtraction Within 10

Exit Ticket 7.10: Subtraction facts to 10

Name _____ Exit Ticket 7.10

1. Subtract. Write each answer.

8 − 6 = 2

7 − 1 = 6

2. Subtract. Write each answer.

6 − 2 = 4

9 − 8 = 1

I can subtract within **10**.

Name _____ Exit Ticket 7.10

1. Subtract. Write each answer.

8 − 6 = 2

7 − 1 = 6

2. Subtract. Write each answer.

6 − 2 = 4

9 − 8 = 1

I can subtract within **10**.

© 2026 Eggroll Games