Sort, Count and Graph

Exit Ticket 3.1: Sort by one rule

Name _____ **Exit Ticket 3.1**

1. Circle all the small cats.



2. Is it food or a toy? Draw a line to its group.

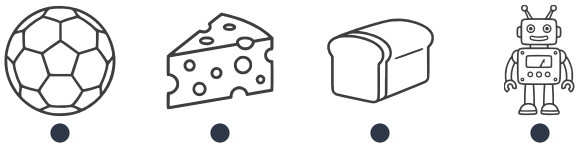

Food **Toys**

I can sort things by one rule.

Name _____ **Exit Ticket 3.1**

1. Circle all the small cats.



2. Is it food or a toy? Draw a line to its group.

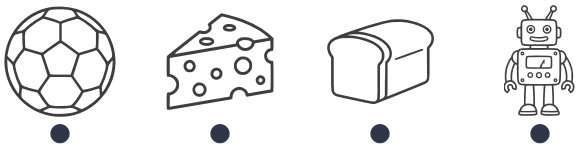

Food **Toys**

I can sort things by one rule.

© 2026 Eggroll Games

Sort, Count and Graph

Exit Ticket 3.2: Which one does not belong?

Name _____ **Exit Ticket 3.2**

1. Circle the one that does not belong.

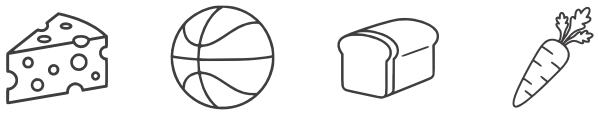

2. Circle the one that does not belong.

I can find the one that does not belong.

Name _____ **Exit Ticket 3.2**

1. Circle the one that does not belong.

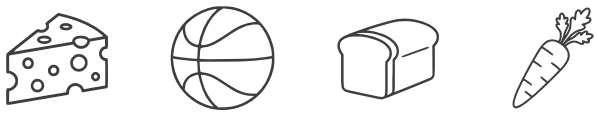

2. Circle the one that does not belong.

I can find the one that does not belong.

© 2026 Eggroll Games

Sort, Count and Graph

Exit Ticket 3.3: Sort, then count each group

Name _____ **Exit Ticket 3.3**

1. Write how many of each.



2. How many animals? How many toys? Write the numbers.



Animals **Toys**

I can sort things and count each group.

Name _____ **Exit Ticket 3.3**

1. Write how many of each.



2. How many animals? How many toys? Write the numbers.

Animals **Toys**

I can sort things and count each group.

© 2026 Eggroll Games

Sort, Count and Graph

Exit Ticket 3.4: Which group has the most?

Name _____ **Exit Ticket 3.4**

1. Count each group. Circle the group with the most.

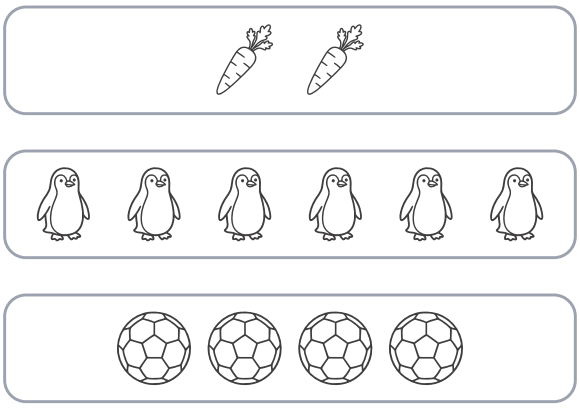

2. Count each group. Circle the group with the fewest.

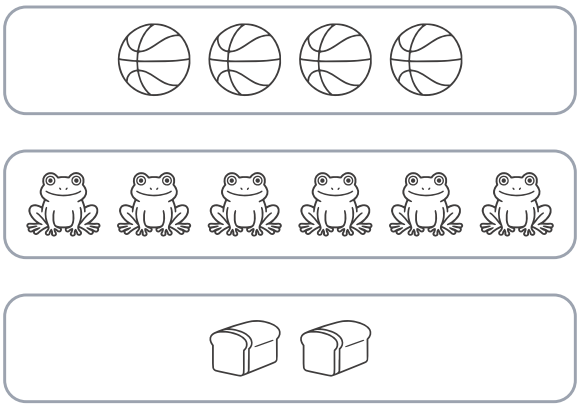

I can find the group with the most and the fewest.

Name _____ **Exit Ticket 3.4**

1. Count each group. Circle the group with the most.

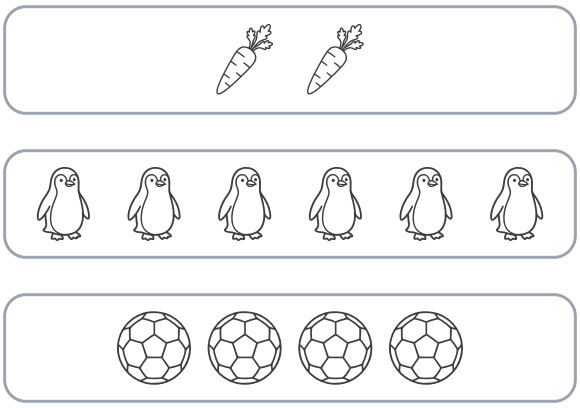

2. Count each group. Circle the group with the fewest.

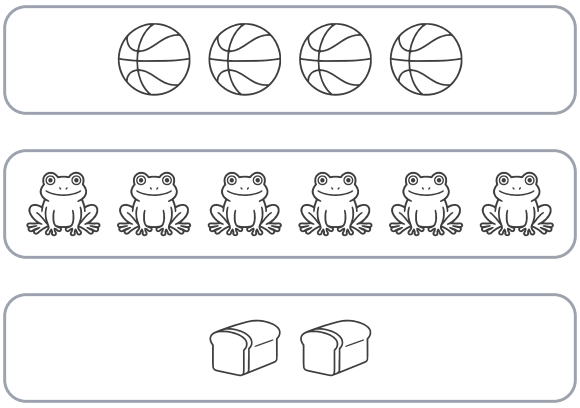

I can find the group with the most and the fewest.

© 2026 Eggroll Games

Sort, Count and Graph

Exit Ticket 3.5: Read a picture graph

Name _____ **Exit Ticket 3.5**

1. Read the graph. How many carrots are there?

Our Snacks



2. Which row has the most? Circle it.

Animals We Like

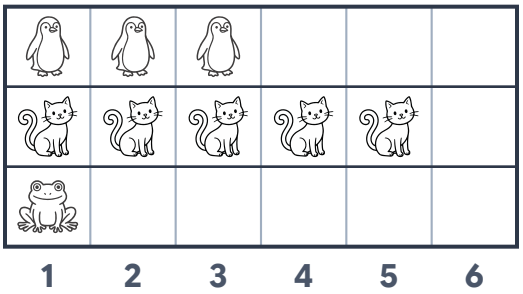

I can read a picture graph.

Name _____ **Exit Ticket 3.5**

1. Read the graph. How many carrots are there?

Our Snacks

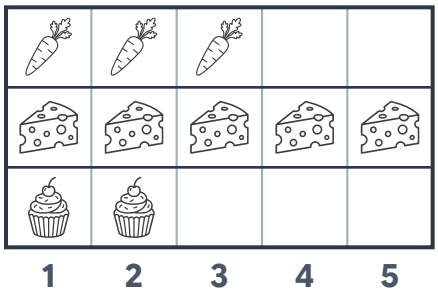



2. Which row has the most? Circle it.

Animals We Like

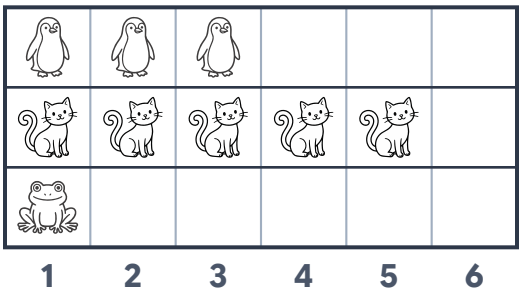

I can read a picture graph.

© 2026 Eggroll Games

Sort, Count and Graph

Exit Ticket 3.6: Make a picture graph

Name _____ **Exit Ticket 3.6**

1. Draw an X in the graph for each picture.



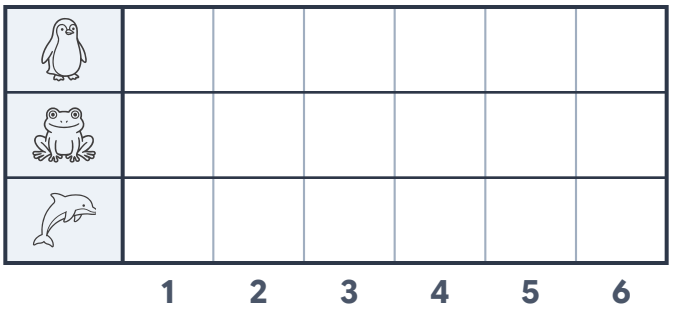

I can make a picture graph.

Name _____ **Exit Ticket 3.6**

1. Draw an X in the graph for each picture.



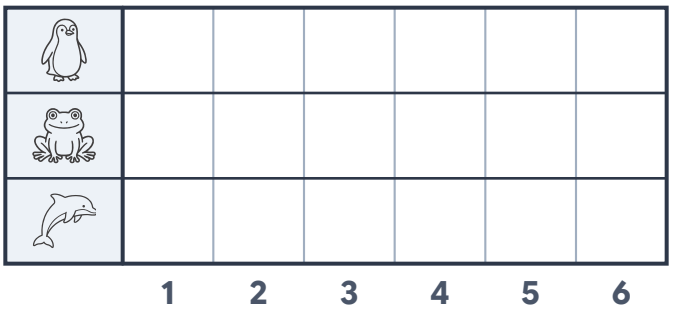

I can make a picture graph.

© 2026 Eggroll Games

Sort, Count and Graph

Exit Ticket 3.7: Collect the answers

Name _____ **Exit Ticket 3.7**

1. How many chose penguins?

Which animal do you like best?



2. Which did more children choose? Circle it.

Which treat do you like best?



I can count the answers to a question.

Name _____ **Exit Ticket 3.7**

1. How many chose penguins?

Which animal do you like best?



2. Which did more children choose? Circle it.

Which treat do you like best?



I can count the answers to a question.

© 2026 Eggroll Games

Sort, Count and Graph

Exit Ticket 3.8: Read a T-chart

Name _____ **Exit Ticket 3.8**

1. How many chose carrots?

Which snack do you like?

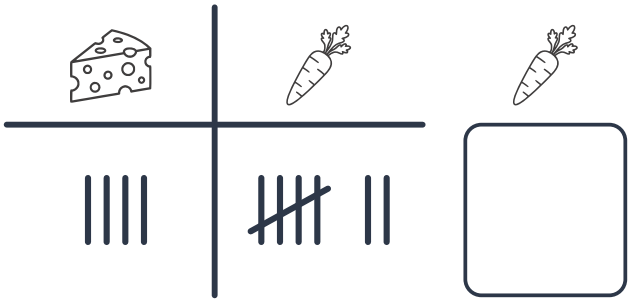

2. Which did more children choose? Circle it.

Which pet do you like?



I can read a T-chart.

Name _____ **Exit Ticket 3.8**

1. How many chose carrots?

Which snack do you like?

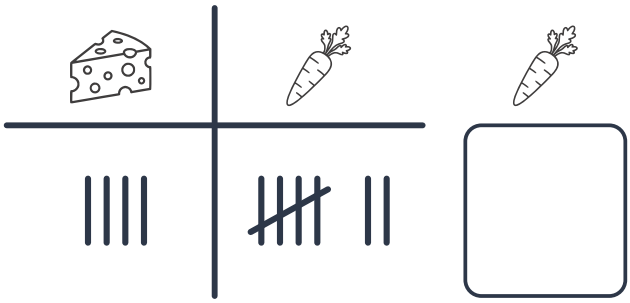

2. Which did more children choose? Circle it.

Which pet do you like?



I can read a T-chart.

© 2026 Eggroll Games

ANSWER KEY

Sort, Count and Graph

Exit Ticket 3.1: Sort by one rule

Name _____ Exit Ticket 3.1

1. Circle all the small cats.



2. Is it food or a toy? Draw a line to its group.

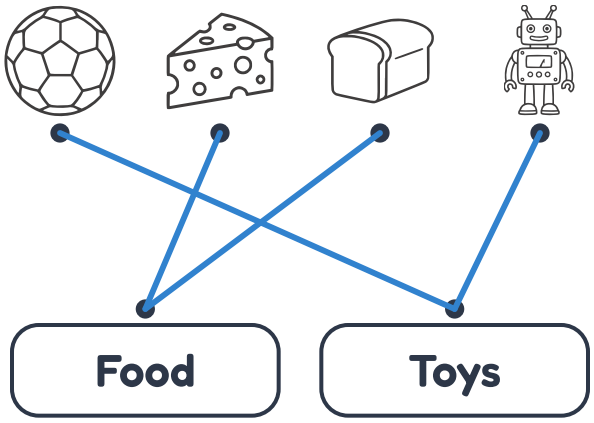

I can sort things by one rule.

Name _____ Exit Ticket 3.1

1. Circle all the small cats.



2. Is it food or a toy? Draw a line to its group.

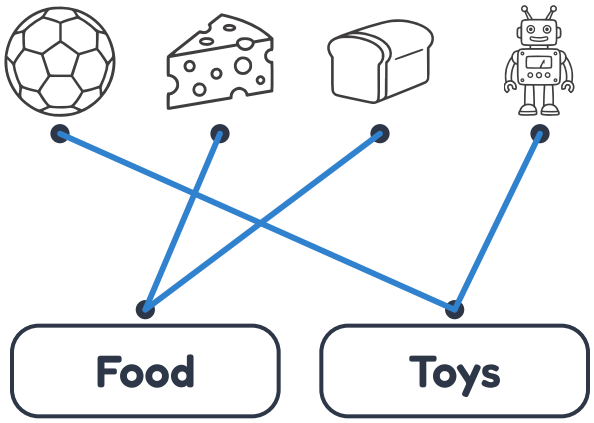

I can sort things by one rule.

© 2026 Eggroll Games

Sort, Count and Graph

Exit Ticket 3.2: Which one does not belong?

Name _____ **Exit Ticket 3.2**

1. Circle the one that does not belong.

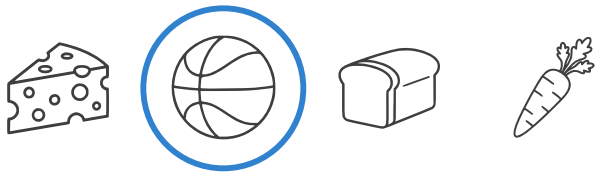

2. Circle the one that does not belong.



I can find the one that does not belong.

Name _____ **Exit Ticket 3.2**

1. Circle the one that does not belong.

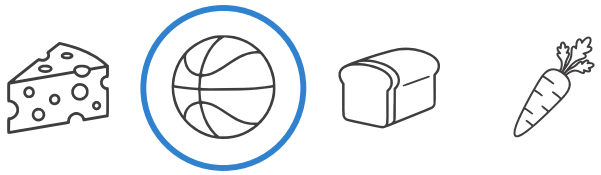

2. Circle the one that does not belong.



I can find the one that does not belong.

© 2026 Eggroll Games

ANSWER KEY

Sort, Count and Graph

Exit Ticket 3.3: Sort, then count each group

Name _____ Exit Ticket 3.3

1. Write how many of each.



5

2

2. How many animals? How many toys? Write the numbers.



Animals	Toys
5	3

I can sort things and count each group.

Name _____ Exit Ticket 3.3

1. Write how many of each.



5

2

2. How many animals? How many toys? Write the numbers.

Animals	Toys
5	3

I can sort things and count each group.

© 2026 Eggroll Games

Sort, Count and Graph

Exit Ticket 3.4: Which group has the most?

Name _____ **Exit Ticket 3.4**

1. Count each group. Circle the group with the most.

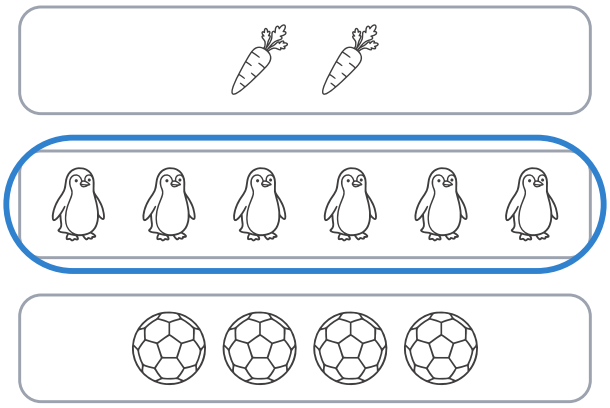

2. Count each group. Circle the group with the fewest.

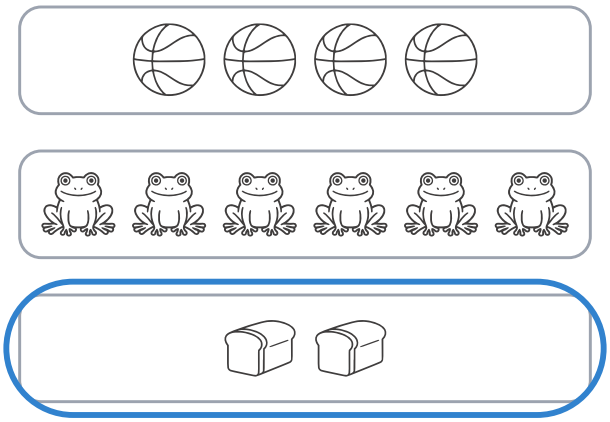

I can find the group with the most and the fewest.

Name _____ **Exit Ticket 3.4**

1. Count each group. Circle the group with the most.

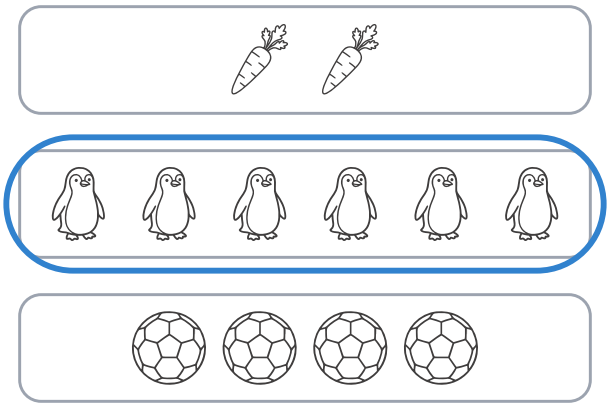

2. Count each group. Circle the group with the fewest.

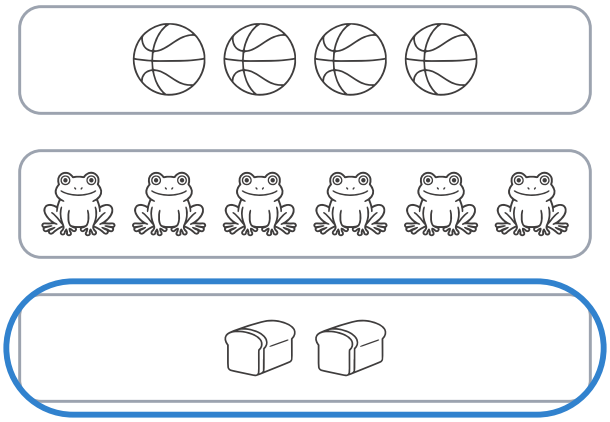

I can find the group with the most and the fewest.

© 2026 Eggroll Games

ANSWER KEY

Sort, Count and Graph

Exit Ticket 3.5: Read a picture graph

Name _____ **Exit Ticket 3.5**

1. Read the graph. How many carrots are there?

Our Snacks

3

2. Which row has the most? Circle it.

Animals We Like

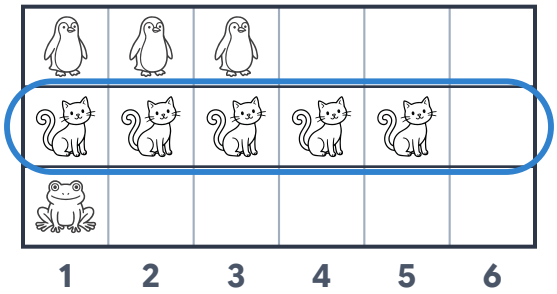

I can read a picture graph.

Name _____ **Exit Ticket 3.5**

1. Read the graph. How many carrots are there?

Our Snacks

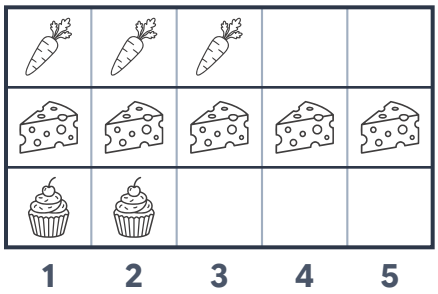

3

2. Which row has the most? Circle it.

Animals We Like

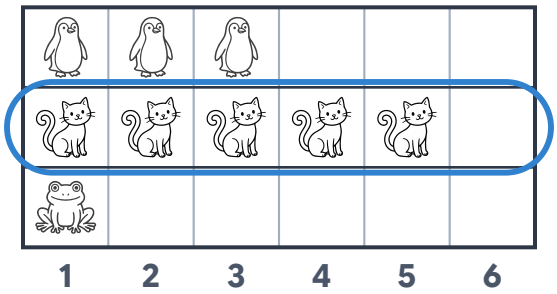

I can read a picture graph.

© 2026 Eggroll Games

Sort, Count and Graph

Exit Ticket 3.6: Make a picture graph

Name _____ **Exit Ticket 3.6**

1. Draw an X in the graph for each picture.



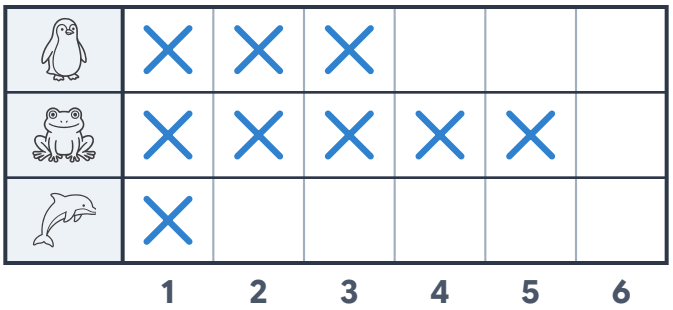

I can make a picture graph.

Name _____ **Exit Ticket 3.6**

1. Draw an X in the graph for each picture.



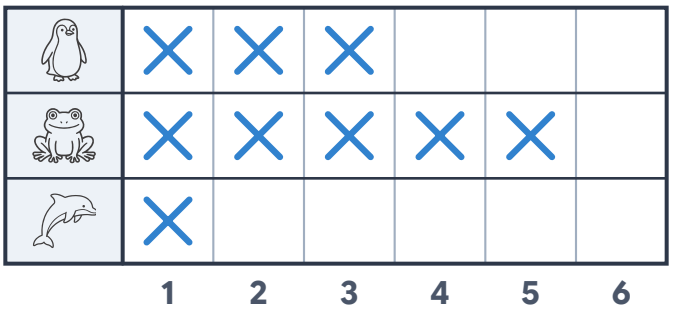

I can make a picture graph.

© 2026 Eggroll Games

Sort, Count and Graph

Exit Ticket 3.7: Collect the answers

Name _____ Exit Ticket 3.7

1. How many chose penguins?

Which animal do you like best?



2. Which did more children choose? Circle it.

Which treat do you like best?



I can count the answers to a question.

Name _____ Exit Ticket 3.7

1. How many chose penguins?

Which animal do you like best?



2. Which did more children choose? Circle it.

Which treat do you like best?

I can count the answers to a question.

© 2026 Eggroll Games

ANSWER KEY

Sort, Count and Graph

Exit Ticket 3.8: Read a T-chart

Name _____ **Exit Ticket 3.8**

1. How many chose carrots?

Which snack do you like?

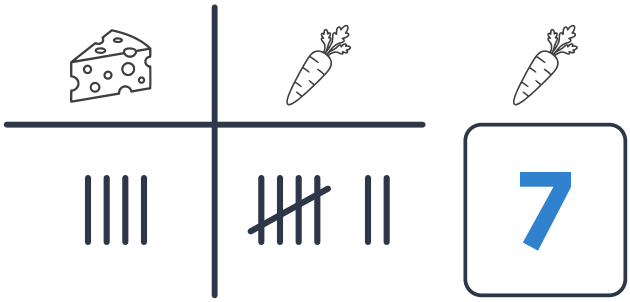

2. Which did more children choose? Circle it.

Which pet do you like?

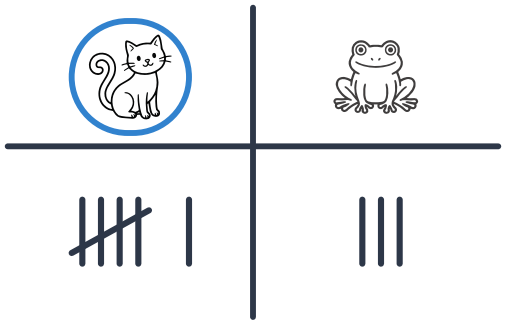

I can read a T-chart.

Name _____ Exit Ticket 3.8

1. How many chose carrots?

Which snack do you like?

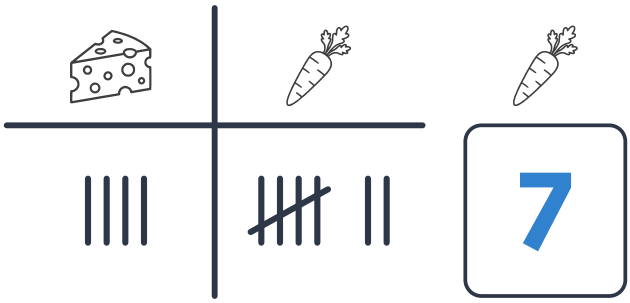

2. Which did more children choose? Circle it.

Which pet do you like?

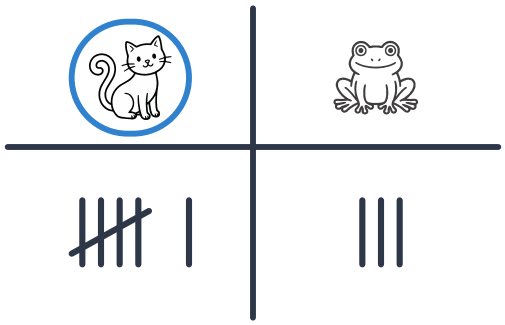

I can read a T-chart.

© 2026 Eggroll Games