Numbers to 10

Exit Ticket 2.1: Count 6 to 10 things

Name _____ **Exit Ticket 2.1**

1. Count the snakes. Circle the number.

6 7 8 9 10

2. Count the whales. Circle the number.



6 7 8 9 10

I can count 6 to 10 things.

Name _____ **Exit Ticket 2.1**

1. Count the snakes. Circle the number.

6 7 8 9 10

2. Count the whales. Circle the number.



6 7 8 9 10

I can count 6 to 10 things.

ANIMAL MATH

Find worksheets, teacher tools, and more at animalmath.com

© 2026 Eggroll Games

Numbers to 10

Exit Ticket 2.2: Write 6 to 10

Name _____ **Exit Ticket 2.2**

1. Trace each number. Then write it in the box.

6 ☐ 9 ☐

2. How many hot dogs? Write the number.

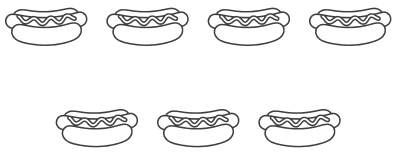

☐

I can write the numbers **6** to **10**.

Name _____ **Exit Ticket 2.2**

1. Trace each number. Then write it in the box.

6 ☐ 9 ☐

2. How many hot dogs? Write the number.

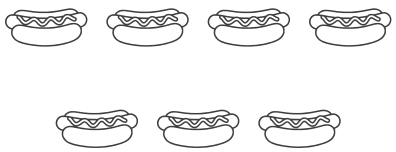

☐

I can write the numbers **6** to **10**.

© 2026 Eggroll Games

Numbers to 10

Exit Ticket 2.3: Five and some more

Name _____ **Exit Ticket 2.3**

1. Circle the ten frame that shows 8.

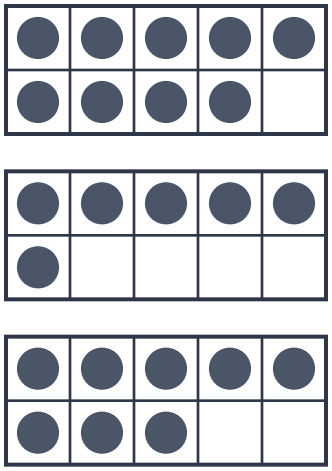

2. There are 5 dots. Draw more dots to make 9.

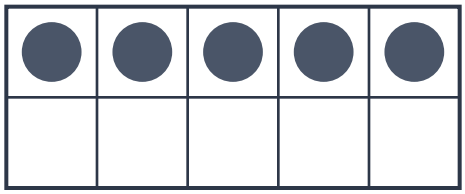

I can see 5 and some more in a ten frame.

Name _____ **Exit Ticket 2.3**

1. Circle the ten frame that shows 8.

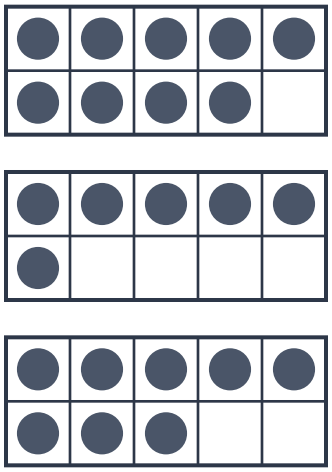

2. There are 5 dots. Draw more dots to make 9.

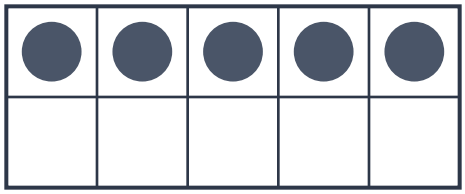

I can see 5 and some more in a ten frame.

© 2026 Eggroll Games

Numbers to 10

Exit Ticket 2.4: Count out up to 10

Name _____ **Exit Ticket 2.4**

1. Circle 7 butterflies.



2. Draw 10 dots in the ten frame.

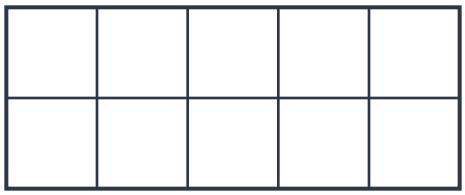

I can count out up to 10 things.

Name _____ **Exit Ticket 2.4**

1. Circle 7 butterflies.



2. Draw 10 dots in the ten frame.



I can count out up to 10 things.

ANIMAL MATH

Find worksheets, teacher tools, and more at animalmath.com

© 2026 Eggroll Games

Numbers to 10

Exit Ticket 2.5: Count scattered things

Name _____ **Exit Ticket 2.5**

1. How many eggs? Write the number.

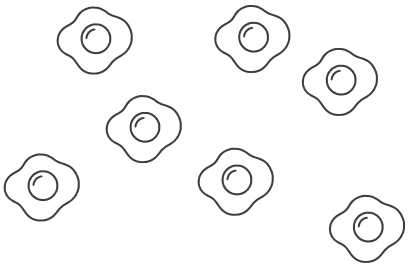

2. How many pinecones? Write the number.



I can count things that are spread out.

Name _____ **Exit Ticket 2.5**

1. How many eggs? Write the number.

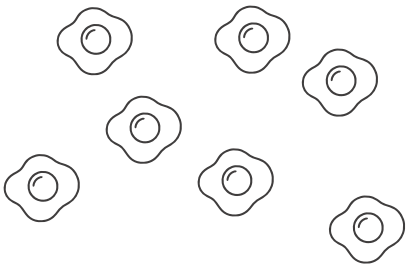

2. How many pinecones? Write the number.



I can count things that are spread out.

© 2026 Eggroll Games

Numbers to 10

Exit Ticket 2.6: Match numbers to groups

Name _____ **Exit Ticket 2.6**

1. Count each group. Draw a line to its number.



I can match a number to a group of up to 10.

Name _____ **Exit Ticket 2.6**

1. Count each group. Draw a line to its number.



I can match a number to a group of up to 10.

© 2026 Eggroll Games

Numbers to 10

Exit Ticket 2.7: One more

Name _____ **Exit Ticket 2.7**

1. There are 6 cats. 1 more comes. How many cats now?

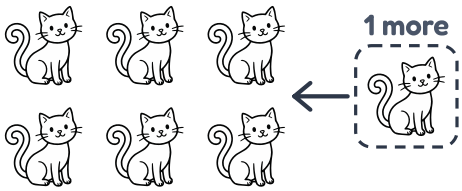

2. There are 9 dots. Draw 1 more dot. How many dots now?



I can tell the number that is one more.

Name _____ **Exit Ticket 2.7**

1. There are 6 cats. 1 more comes. How many cats now?

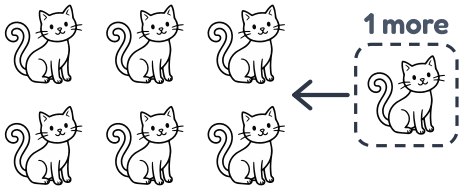

2. There are 9 dots. Draw 1 more dot. How many dots now?



I can tell the number that is one more.

© 2026 Eggroll Games

Numbers to 10

Exit Ticket 2.8: One less

Name _____ **Exit Ticket 2.8**

1. There are 10 dots. 1 is taken away. How many dots now?



2. There are 9 burgers. 1 is eaten. How many burgers now?



I can tell the number that is one less.

Name _____ **Exit Ticket 2.8**

1. There are 10 dots. 1 is taken away. How many dots now?



2. There are 9 burgers. 1 is eaten. How many burgers now?



I can tell the number that is one less.

© 2026 Eggroll Games

Numbers to 10

Exit Ticket 2.9: Before, after and between

Name _____ **Exit Ticket 2.9**

1. Write the numbers just before and just after 7.

[ ] **7** [ ]

2. Write the number that comes between 8 and 10.

8 [ ] **10**

I can write the numbers before, after and between.

Name _____ **Exit Ticket 2.9**

1. Write the numbers just before and just after 7.

[ ] **7** [ ]

2. Write the number that comes between 8 and 10.

8 [ ] **10**

I can write the numbers before, after and between.

© 2026 Eggroll Games

Numbers to 10

Exit Ticket 2.10: Count back from 10

Name _____ **Exit Ticket 2.10**

1. Count back from 10. Write the missing numbers.

10	9		7			4

I can count back from 10.

Name _____ **Exit Ticket 2.10**

1. Count back from 10. Write the missing numbers.

10	9		7			4

I can count back from 10.

ANIMAL MATH

Find worksheets, teacher tools, and more at animalmath.com

© 2026 Eggroll Games

ANSWER KEY

Numbers to 10

Exit Ticket 2.1: Count 6 to 10 things

Name _____ Exit Ticket 2.1

1. Count the snakes. Circle the number.

6 7 8 9 10

2. Count the whales. Circle the number.



6 7 8 9 **10**

I can count **6** to **10** things.

Name _____ Exit Ticket 2.1

1. Count the snakes. Circle the number.

6 7 8 9 10

2. Count the whales. Circle the number.



6 7 8 9 **10**

I can count **6** to **10** things.

© 2026 Eggroll Games

Numbers to 10

Exit Ticket 2.2: Write 6 to 10

Name _____ **Exit Ticket 2.2**

1. Trace each number. Then write it in the box.

6 **6** 9 **9**

2. How many hot dogs? Write the number.

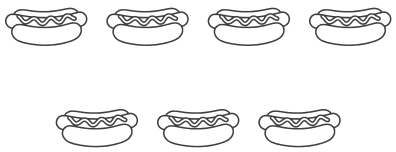

7

I can write the numbers **6** to **10**.

Name _____ **Exit Ticket 2.2**

1. Trace each number. Then write it in the box.

6 **6** 9 **9**

2. How many hot dogs? Write the number.

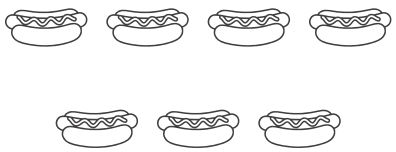

7

I can write the numbers **6** to **10**.

© 2026 Eggroll Games

Numbers to 10

Exit Ticket 2.3: Five and some more

Name _____ **Exit Ticket 2.3**

1. Circle the ten frame that shows 8.

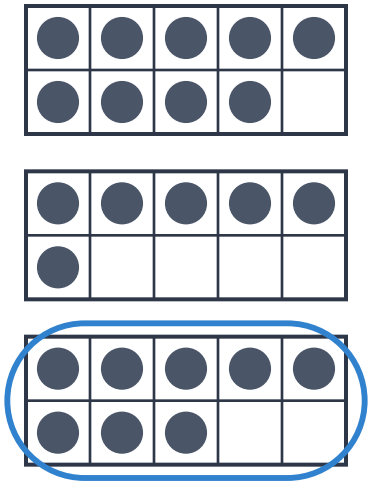

2. There are 5 dots. Draw more dots to make 9.



I can see **5** and some more in a ten frame.

Name _____ **Exit Ticket 2.3**

1. Circle the ten frame that shows 8.

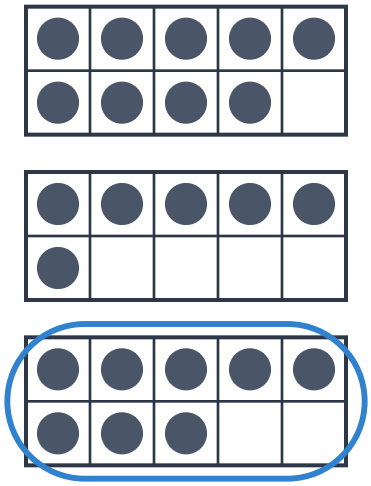

2. There are 5 dots. Draw more dots to make 9.



I can see **5** and some more in a ten frame.

© 2026 Eggroll Games

ANSWER KEY

Numbers to 10

Exit Ticket 2.4: Count out up to 10

Name _____ Exit Ticket 2.4

1. Circle 7 butterflies.

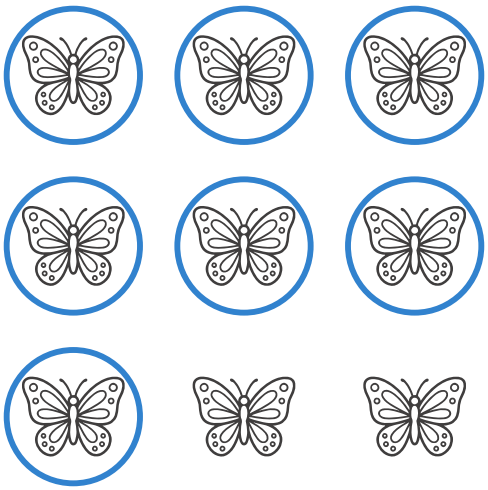

2. Draw 10 dots in the ten frame.

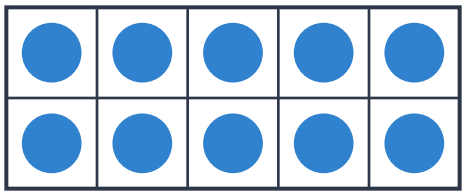

I can count out up to **10** things.

Name _____ Exit Ticket 2.4

1. Circle 7 butterflies.

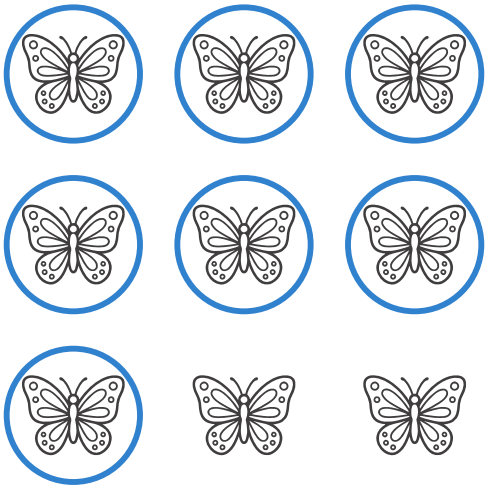

2. Draw 10 dots in the ten frame.

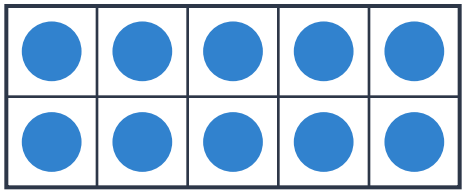

I can count out up to **10** things.

© 2026 Eggroll Games

Numbers to 10

Exit Ticket 2.5: Count scattered things

Name _____ **Exit Ticket 2.5**

1. How many eggs? Write the number.

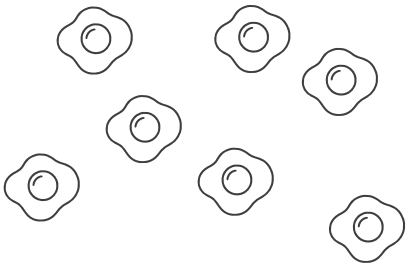

7

2. How many pinecones? Write the number.



9

I can count things that are spread out.

Name _____ **Exit Ticket 2.5**

1. How many eggs? Write the number.

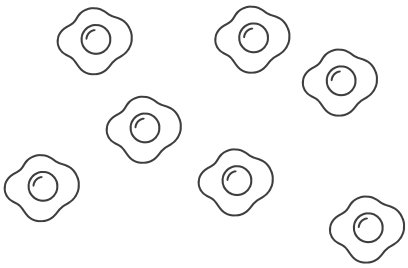

7

2. How many pinecones? Write the number.



9

I can count things that are spread out.

© 2026 Eggroll Games

Numbers to 10

Exit Ticket 2.6: Match numbers to groups

Name _____ **Exit Ticket 2.6**

1. Count each group. Draw a line to its number.



I can match a number to a group of up to **10**.

Name _____ **Exit Ticket 2.6**

1. Count each group. Draw a line to its number.



I can match a number to a group of up to **10**.

© 2026 Eggroll Games

Numbers to 10

Exit Ticket 2.7: One more

Name _____ **Exit Ticket 2.7**

1. **There are 6 cats. 1 more comes. How many cats now?**

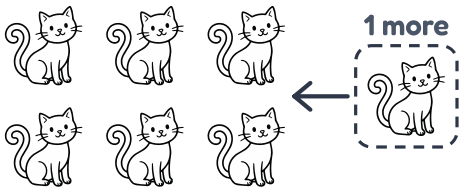

7

2. **There are 9 dots. Draw 1 more dot. How many dots now?**



10

I can tell the number that is one more.

Name _____ Exit Ticket 2.7

1. There are 6 cats. 1 more comes. How many cats now?

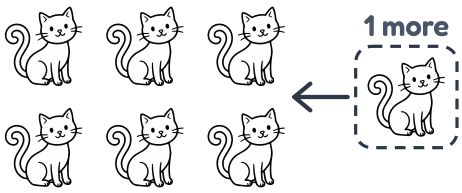

7

2. There are 9 dots. Draw 1 more dot. How many dots now?



10

I can tell the number that is one more.

© 2026 Eggroll Games

Numbers to 10

Exit Ticket 2.8: One less

Name _____ **Exit Ticket 2.8**

1. **There are 10 dots. 1 is taken away. How many dots now?**



9

2. **There are 9 burgers. 1 is eaten. How many burgers now?**



8

I can tell the number that is one less.

Name _____ **Exit Ticket 2.8**

1. **There are 10 dots. 1 is taken away. How many dots now?**



9

2. **There are 9 burgers. 1 is eaten. How many burgers now?**



8

I can tell the number that is one less.

© 2026 Eggroll Games

ANSWER KEY

Numbers to 10

Exit Ticket 2.9: Before, after and between

Name _____ **Exit Ticket 2.9**

1. Write the numbers just before and just after 7.

6 7 8

2. Write the number that comes between 8 and 10.

8 9 10

I can write the numbers before, after and between.

Name _____ **Exit Ticket 2.9**

1. Write the numbers just before and just after 7.

6 7 8

2. Write the number that comes between 8 and 10.

8 9 10

I can write the numbers before, after and between.

© 2026 Eggroll Games

ANSWER KEY

Numbers to 10

Exit Ticket 2.10: Count back from 10

Name _____ **Exit Ticket 2.10**

1. Count back from 10. Write the missing numbers.

10	9	8	7	6	5	4

I can count back from 10.

Name _____ **Exit Ticket 2.10**

1. Count back from 10. Write the missing numbers.

10	9	8	7	6	5	4

I can count back from 10.

ANIMAL MATH

Find worksheets, teacher tools, and more at animalmath.com

© 2026 Eggroll Games