Numbers 11 to 20

Exit Ticket 9.1: Count to 20

Name _____ **Exit Ticket 9.1**

1. Count on. Write the next two numbers.

10 ☐ ☐

2. Count on. Write the next two numbers.

15 ☐ ☐

I can count to 20.

Name _____ **Exit Ticket 9.1**

1. Count on. Write the next two numbers.

10 ☐ ☐

2. Count on. Write the next two numbers.

15 ☐ ☐

I can count to 20.

© 2026 Eggroll Games

Numbers 11 to 20

Exit Ticket 9.2: Count 11 to 20 things

Name _____ **Exit Ticket 9.2**

1. How many doughnuts? Write the number.



2. How many tomatoes? Write the number.



I can count 11 to 20 things.

Name _____ **Exit Ticket 9.2**

1. How many doughnuts? Write the number.



2. How many tomatoes? Write the number.



I can count 11 to 20 things.

© 2026 Eggroll Games

Numbers 11 to 20

Exit Ticket 9.3: Write 11 to 20

Name _____ **Exit Ticket 9.3**

1. Trace each number. Then write it in the box.

12

19

2. Listen. Write the number sixteen.

I can write the numbers **11** to **20**.

Name _____ **Exit Ticket 9.3**

1. Trace each number. Then write it in the box.

12

19

2. Listen. Write the number sixteen.

I can write the numbers **11** to **20**.

© 2026 Eggroll Games

Numbers 11 to 20

Exit Ticket 9.4: Ten ones and some more

Name _____ **Exit Ticket 9.4**

1. 10 dots and some more. How many dots in all?

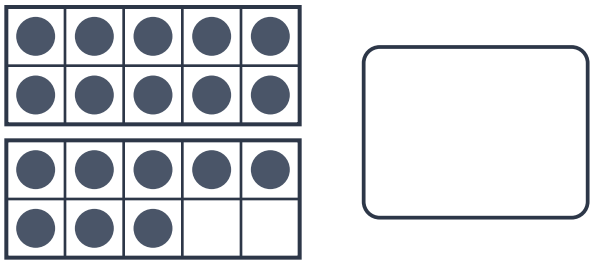

2. The top frame is 10. Draw more dots to make 14.

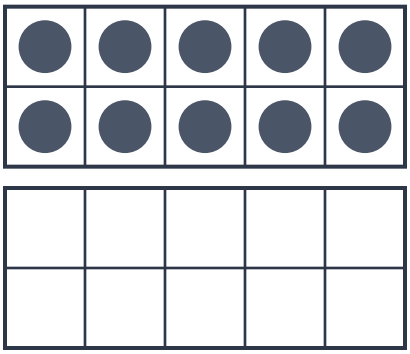

I can see **10** and some more in a teen number.

Name _____ **Exit Ticket 9.4**

1. 10 dots and some more. How many dots in all?

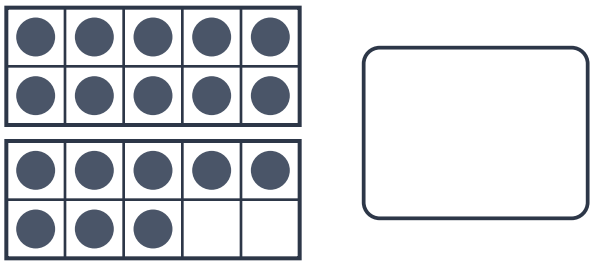

2. The top frame is 10. Draw more dots to make 14.

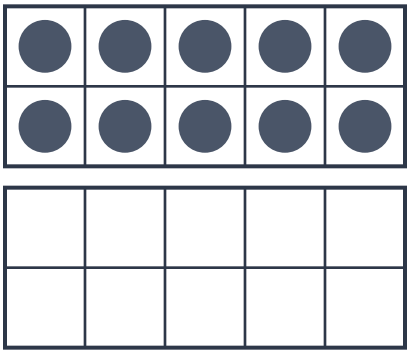

I can see **10** and some more in a teen number.

© 2026 Eggroll Games

Numbers 11 to 20

Exit Ticket 9.5: Build a teen number

Name _____ **Exit Ticket 9.5**

1. 10 cubes and 6 more. How many cubes in all?

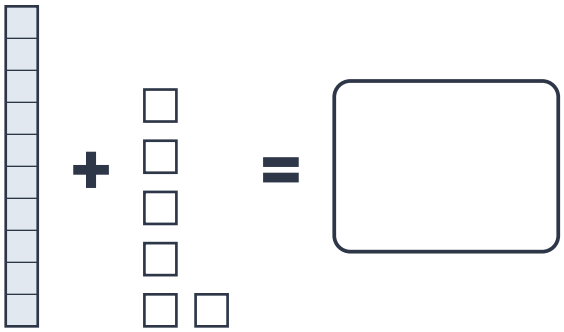

2. What is 10 + 3? Write the number.

10 + 3 = ☐

I can build a teen number from **10** and some more.

Name _____ **Exit Ticket 9.5**

1. 10 cubes and 6 more. How many cubes in all?

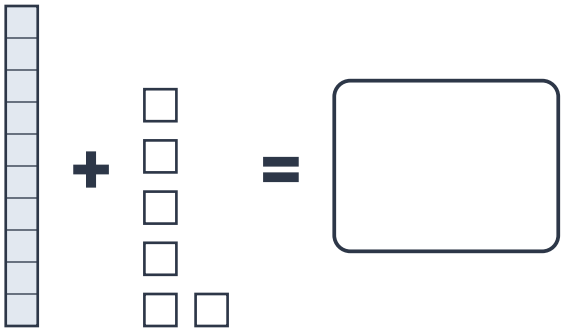

2. What is 10 + 3? Write the number.

10 + 3 = ☐

I can build a teen number from **10** and some more.

© 2026 Eggroll Games

Numbers 11 to 20

Exit Ticket 9.6: Break apart a teen number

Name _____ **Exit Ticket 9.6**

1. 15 is 10 and how many more? Write the number.

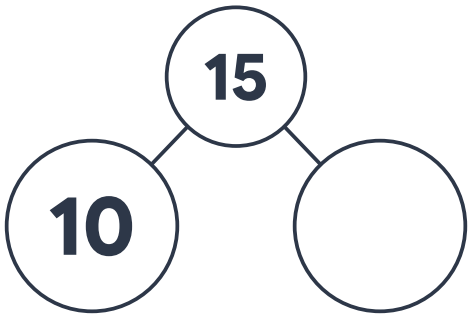

2. 17 cubes. Circle 10. How many more are there?

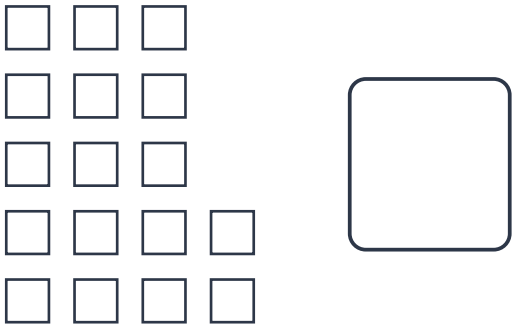

I can break a teen number into **10** and some more.

Name _____ **Exit Ticket 9.6**

1. 15 is 10 and how many more? Write the number.

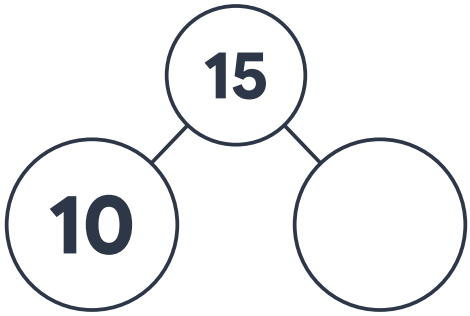

2. 17 cubes. Circle 10. How many more are there?

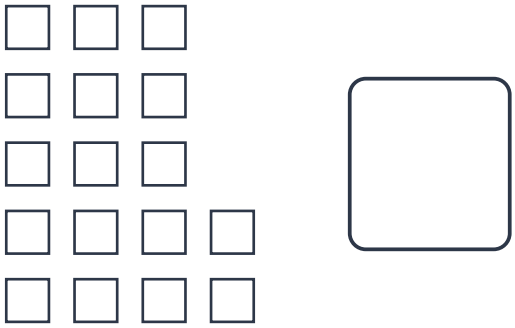

I can break a teen number into **10** and some more.

© 2026 Eggroll Games

Numbers 11 to 20

Exit Ticket 9.7: Compare to 20

Name _____ **Exit Ticket 9.7**

1. Circle the greater number in each pair.

12 15

18 11

2. Count the dots. Circle the one with more.

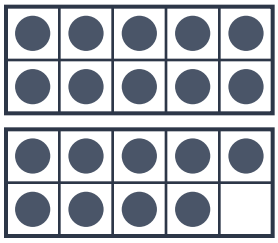

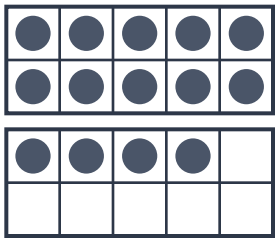

I can compare numbers to 20.

Name _____ **Exit Ticket 9.7**

1. Circle the greater number in each pair.

12 15

18 11

2. Count the dots. Circle the one with more.

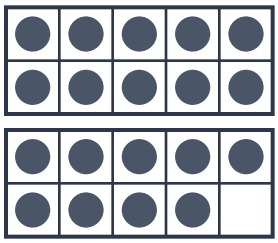

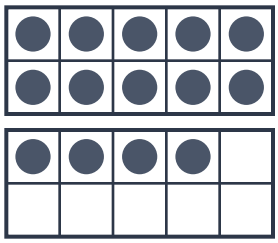

I can compare numbers to 20.

© 2026 Eggroll Games

Numbers 11 to 20

Exit Ticket 9.8: One more and one less

Name _____ **Exit Ticket 9.8**

1. Write 1 less than 13 and 1 more than 13.

1 less than 13 ☐

1 more than 13 ☐

2. Circle the number that is 1 less than 17.

18 **16** **15**

I can find 1 more and 1less.

Name _____ **Exit Ticket 9.8**

1. Write 1 less than 13 and 1 more than 13.

1 less than 13 ☐

1 more than 13 ☐

2. Circle the number that is 1 less than 17.

18 **16** **15**

I can find 1 more and 1less.

© 2026 Eggroll Games

Numbers 11 to 20

Exit Ticket 9.9: Numbers on a number line

Name _____ **Exit Ticket 9.9**

1. Write the missing numbers on the number line.

11 12 ☐ 14 15 ☐ 17

2. Write the missing numbers on the number line.

14 ☐ 16 17 ☐ 19 20

I can find numbers to 20 on a number line.

Name _____ **Exit Ticket 9.9**

1. Write the missing numbers on the number line.

11 12 ☐ 14 15 ☐ 17

2. Write the missing numbers on the number line.

14 ☐ 16 17 ☐ 19 20

I can find numbers to 20 on a number line.

© 2026 Eggroll Games

Numbers 11 to 20

Exit Ticket 9.10: Count back from 20

Name _____ **Exit Ticket 9.10**

1. Count back. Write the next two numbers.

19 ☐ ☐

2. Count back. Write the next two numbers.

13 ☐ ☐

I can count back from 20.

Name _____ **Exit Ticket 9.10**

1. Count back. Write the next two numbers.

19 ☐ ☐

2. Count back. Write the next two numbers.

13 ☐ ☐

I can count back from 20.

© 2026 Eggroll Games

Numbers 11 to 20

Exit Ticket 9.11: Number words

Name _____ **Exit Ticket 9.11**

1. Draw a line from each word to its number.

five •	• **1**
eight •	• **5**
one •	• **8**

2. Read the word. Write its number.

four → ☐

I can read the number words zero to ten.

Name _____ **Exit Ticket 9.11**

1. Draw a line from each word to its number.

five •	• **1**
eight •	• **5**
one •	• **8**

2. Read the word. Write its number.

four → ☐

I can read the number words zero to ten.

© 2026 Eggroll Games

Numbers 11 to 20

Exit Ticket 9.12: Numbers to 30

Name _____ **Exit Ticket 9.12**

1. Count the dots. Write the number.

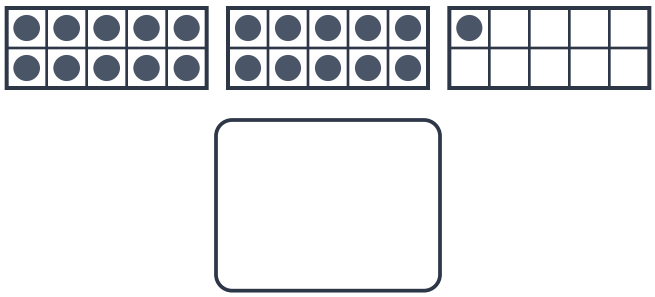

2. Count on. Write the next two numbers.

27 ☐ ☐

I can count and write numbers to **30**.

Name _____ **Exit Ticket 9.12**

1. Count the dots. Write the number.

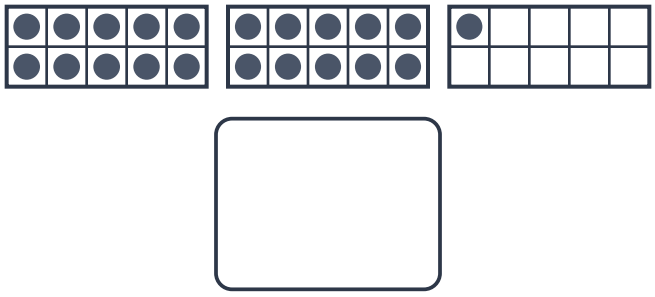

2. Count on. Write the next two numbers.

27 ☐ ☐

I can count and write numbers to **30**.

© 2026 Eggroll Games

ANSWER KEY

Numbers 11 to 20

Exit Ticket 9.1: Count to 20

Name _____ **Exit Ticket 9.1**

1. **Count on. Write the next two numbers.**

10 | 11 | 12

2. **Count on. Write the next two numbers.**

15 | 16 | 17

I can count to 20.

Name _____ **Exit Ticket 9.1**

1. **Count on. Write the next two numbers.**

10 | 11 | 12

2. **Count on. Write the next two numbers.**

15 | 16 | 17

I can count to 20.

© 2026 Eggroll Games

Numbers 11 to 20

Exit Ticket 9.2: Count 11 to 20 things

Name _____ **Exit Ticket 9.2**

1. How many doughnuts? Write the number.



16

2. How many tomatoes? Write the number.



11

I can count **11** to **20** things.

Name _____ **Exit Ticket 9.2**

1. How many doughnuts? Write the number.



16

2. How many tomatoes? Write the number.



11

I can count **11** to **20** things.

© 2026 Eggroll Games

Numbers 11 to 20

Exit Ticket 9.3: Write 11 to 20

Name _____ **Exit Ticket 9.3**

1. Trace each number. Then write it in the box.

12 **12**

19 **19**

2. Listen. Write the number sixteen.

16

I can write the numbers **11** to **20**.

Name _____ **Exit Ticket 9.3**

1. Trace each number. Then write it in the box.

12 **12**

19 **19**

2. Listen. Write the number sixteen.

16

I can write the numbers **11** to **20**.

© 2026 Eggroll Games

Numbers 11 to 20

Exit Ticket 9.4: Ten ones and some more

Name _____ **Exit Ticket 9.4**

1. 10 dots and some more. How many dots in all?



18

2. The top frame is 10. Draw more dots to make 14.

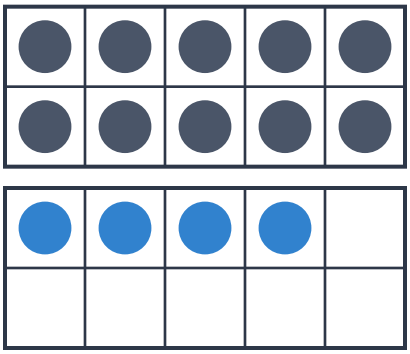

I can see **10** and some more in a teen number.

Name _____ **Exit Ticket 9.4**

1. 10 dots and some more. How many dots in all?



18

2. The top frame is 10. Draw more dots to make 14.

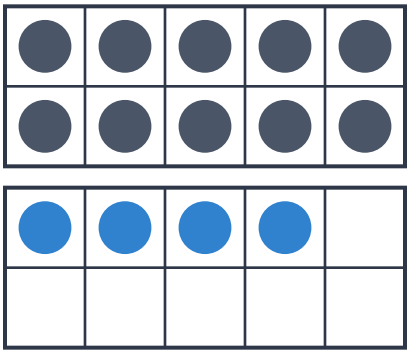

I can see **10** and some more in a teen number.

© 2026 Eggroll Games

Numbers 11 to 20

Exit Ticket 9.5: Build a teen number

Name _____ **Exit Ticket 9.5**

1. **10** cubes and **6** more. How many cubes in all?

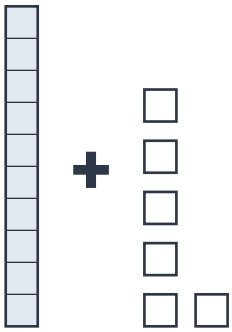

+ = **16**

2. What is **10 + 3**? Write the number.

10 + 3 = 13

I can build a teen number from **10** and some more.

Name _____ **Exit Ticket 9.5**

1. **10** cubes and **6** more. How many cubes in all?

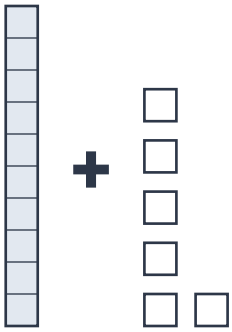

+ = **16**

2. What is **10 + 3**? Write the number.

10 + 3 = 13

I can build a teen number from **10** and some more.

© 2026 Eggroll Games

Numbers 11 to 20

Exit Ticket 9.6: Break apart a teen number

Name _____ **Exit Ticket 9.6**

1. 15 is 10 and how many more? Write the number.

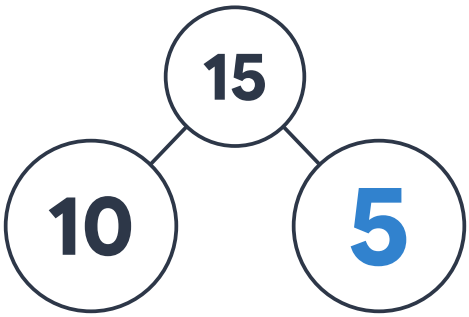

2. 17 cubes. Circle 10. How many more are there?

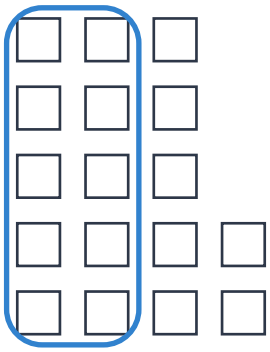

7

I can break a teen number into **10** and some more.

Name _____ **Exit Ticket 9.6**

1. 15 is 10 and how many more? Write the number.

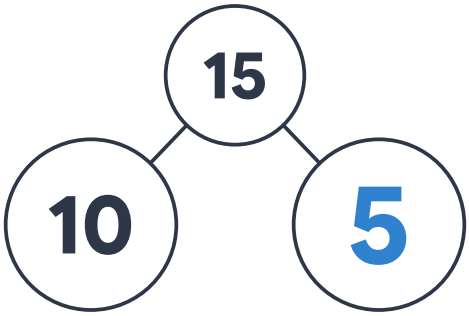

2. 17 cubes. Circle 10. How many more are there?

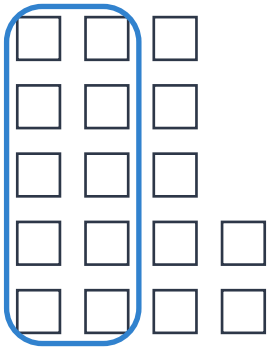

7

I can break a teen number into **10** and some more.

© 2026 Eggroll Games

Numbers 11 to 20

Exit Ticket 9.7: Compare to 20

Name _____ **Exit Ticket 9.7**

1. Circle the greater number in each pair.

12 **15**

18 11

2. Count the dots. Circle the one with more.

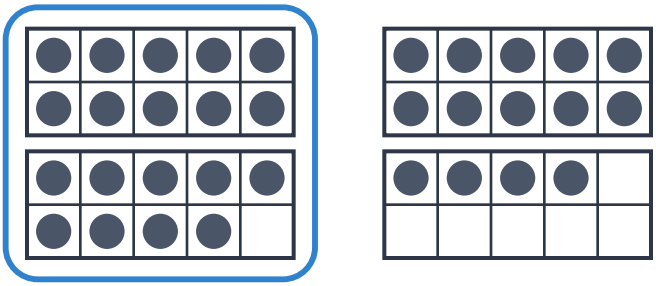

I can compare numbers to **20**.

Name _____ **Exit Ticket 9.7**

1. Circle the greater number in each pair.

12 **15**

18 11

2. Count the dots. Circle the one with more.

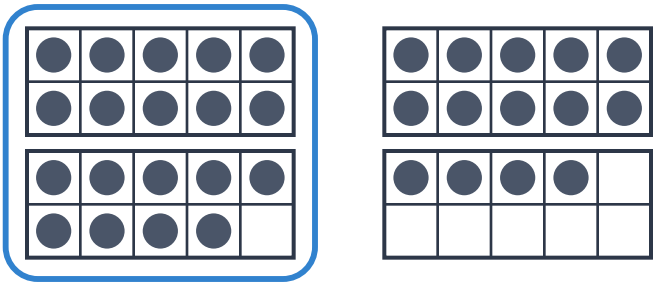

I can compare numbers to **20**.

© 2026 Eggroll Games

Numbers 11 to 20

Exit Ticket 9.8: One more and one less

Name _____ **Exit Ticket 9.8**

1. Write 1 less than 13 and 1 more than 13.

1 less than 13: **12**

1 more than 13: **14**

2. Circle the number that is 1 less than 17.

18 **16** 15

I can find 1 more and 1 less.

Name _____ **Exit Ticket 9.8**

1. Write 1 less than 13 and 1 more than 13.

1 less than 13: **12**

1 more than 13: **14**

2. Circle the number that is 1 less than 17.

18 **16** 15

I can find 1 more and 1 less.

© 2026 Eggroll Games

Numbers 11 to 20

Exit Ticket 9.9: Numbers on a number line

Name _____ **Exit Ticket 9.9**

1. Write the missing numbers on the number line.

11 12 **13** 14 15 **16** 17

2. Write the missing numbers on the number line.

14 **15** 16 17 **18** 19 20

I can find numbers to **20** on a number line.

Name _____ **Exit Ticket 9.9**

1. Write the missing numbers on the number line.

11 12 **13** 14 15 **16** 17

2. Write the missing numbers on the number line.

14 **15** 16 17 **18** 19 20

I can find numbers to **20** on a number line.

© 2026 Eggroll Games

Numbers 11 to 20

Exit Ticket 9.10: Count back from 20

Name _____ **Exit Ticket 9.10**

1. Count back. Write the next two numbers.

19 | 18 | 17

2. Count back. Write the next two numbers.

13 | 12 | 11

I can count back from 20.

Name _____ **Exit Ticket 9.10**

1. Count back. Write the next two numbers.

19 | 18 | 17

2. Count back. Write the next two numbers.

13 | 12 | 11

I can count back from 20.

© 2026 Eggroll Games

Numbers 11 to 20

Exit Ticket 9.11: Number words

Name _____ **Exit Ticket 9.11**

1. Draw a line from each word to its number.

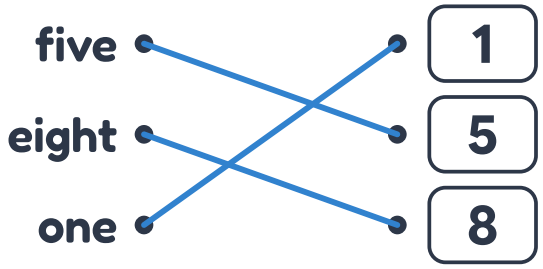

2. Read the word. Write its number.

four → 4

I can read the number words zero to ten.

Name _____ **Exit Ticket 9.11**

1. Draw a line from each word to its number.

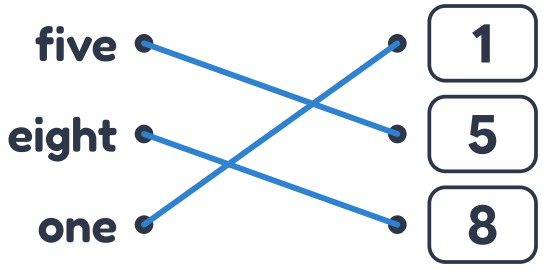

2. Read the word. Write its number.

four → 4

I can read the number words zero to ten.

© 2026 Eggroll Games

Numbers 11 to 20

Exit Ticket 9.12: Numbers to 30

Name _____ **Exit Ticket 9.12**

1. Count the dots. Write the number.



21

2. Count on. Write the next two numbers.

27 **28** **29**

I can count and write numbers to **30**.

Name _____ **Exit Ticket 9.12**

1. Count the dots. Write the number.



21

2. Count on. Write the next two numbers.

27 **28** **29**

I can count and write numbers to **30**.

© 2026 Eggroll Games