Number Pairs to 10

Exit Ticket 8.1: Ways to make 5

Name _____ **Exit Ticket 8.1**

1. How many more dots make 5? Write the number.

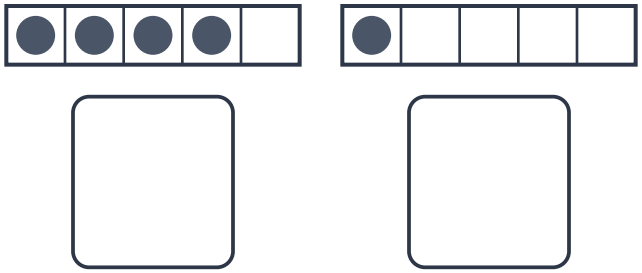

2. There are 5 pineapples. Some are in the box. How many are in the box?

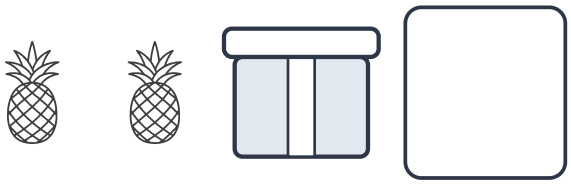

I can find ways to make 5.

Name _____ **Exit Ticket 8.1**

1. How many more dots make 5? Write the number.

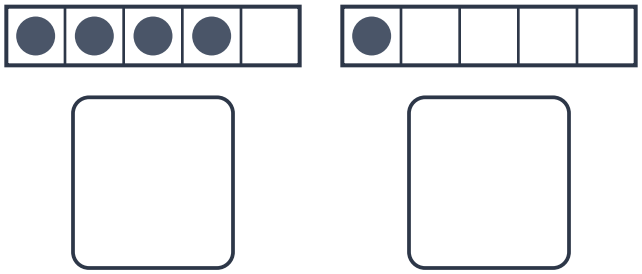

2. There are 5 pineapples. Some are in the box. How many are in the box?

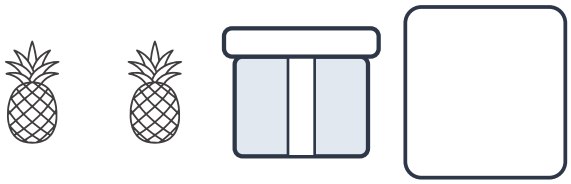

I can find ways to make 5.

© 2026 Eggroll Games

Number Pairs to 10

Exit Ticket 8.2: Number bonds to 5

Name _____ **Exit Ticket 8.2**

1. Write the missing part in the number bond.

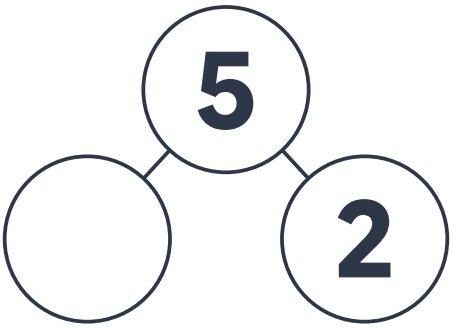

2. Write the whole in the number bond.

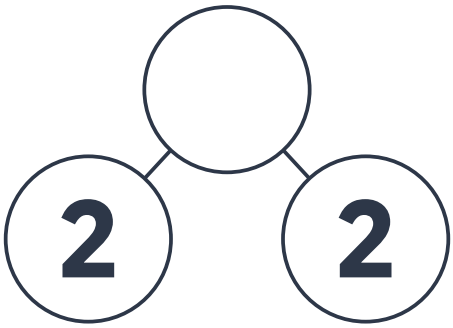

I can find a missing part or the whole.

Name _____ **Exit Ticket 8.2**

1. Write the missing part in the number bond.

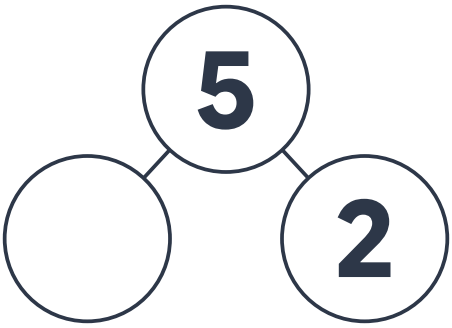

2. Write the whole in the number bond.

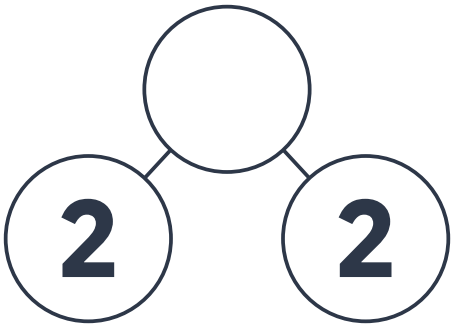

I can find a missing part or the whole.

© 2026 Eggroll Games

Number Pairs to 10

Exit Ticket 8.3: Ways to make 6, 7 and 8

Name _____ **Exit Ticket 8.3**

1. Count the dots. Circle the domino that makes 8.



2. 7 counters. How many are gray? How many are white? Write each number.

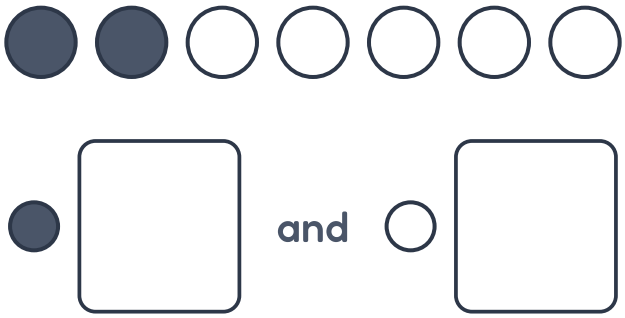

I can find ways to make **6**, **7** and **8**.

Name _____ **Exit Ticket 8.3**

1. Count the dots. Circle the domino that makes 8.



2. 7 counters. How many are gray? How many are white? Write each number.

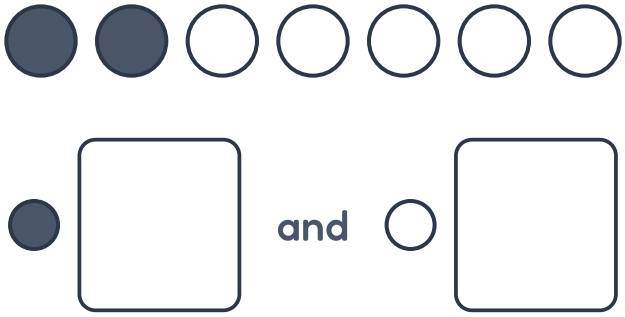

I can find ways to make **6**, **7** and **8**.

© 2026 Eggroll Games

Number Pairs to 10

Exit Ticket 8.4: Ways to make 9 and 10

Name _____ **Exit Ticket 8.4**

1. There are 10 carrots. Some are in the box. How many are in the box?

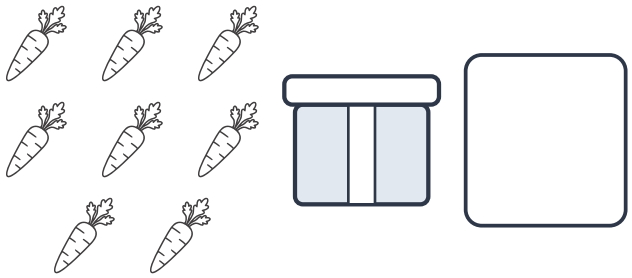

2. Write the missing part in the number bond.



I can find ways to make 9 and 10.

Name _____ **Exit Ticket 8.4**

1. There are 10 carrots. Some are in the box. How many are in the box?

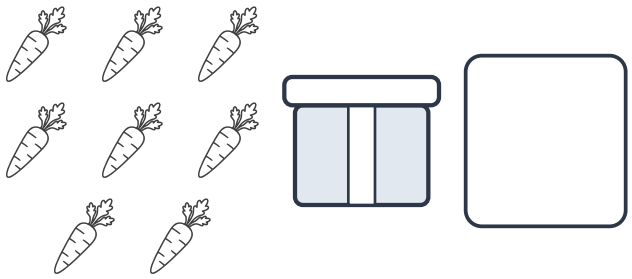

2. Write the missing part in the number bond.



I can find ways to make 9 and 10.

ANIMAL MATH

Find worksheets, teacher tools, and more at animalmath.com

© 2026 Eggroll Games

Number Pairs to 10

Exit Ticket 8.5: Write a number sentence

Name _____ **Exit Ticket 8.5**

1. Write how many in all, then each group.

☐ = ☐ + ☐

2. Write how many in all, then each group.

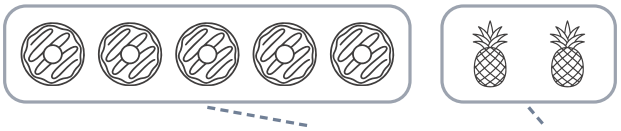

☐ = ☐ + ☐

I can write a number pair as a number sentence.

Name _____ **Exit Ticket 8.5**

1. Write how many in all, then each group.

☐ = ☐ + ☐

2. Write how many in all, then each group.

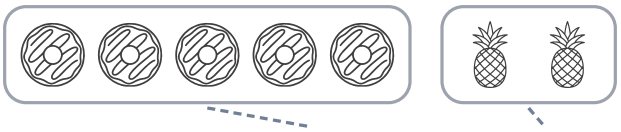

☐ = ☐ + ☐

I can write a number pair as a number sentence.

© 2026 Eggroll Games

Number Pairs to 10

Exit Ticket 8.6: How many more make 10

Name _____ **Exit Ticket 8.6**

1. How many more dots make 10? Write the number.

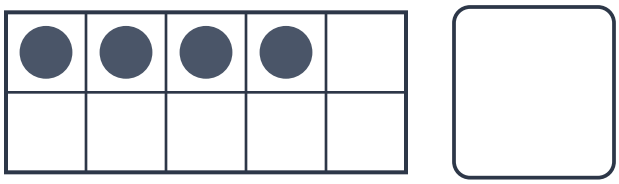

2. Draw more dots to make 10.

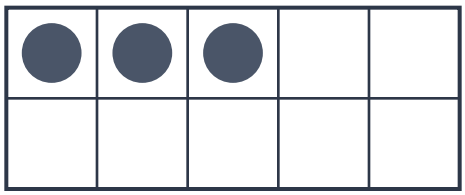

I can find how many more make **10**.

Name _____ **Exit Ticket 8.6**

1. How many more dots make 10? Write the number.

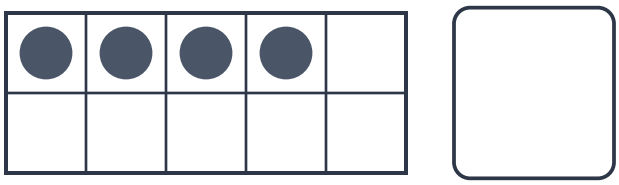

2. Draw more dots to make 10.

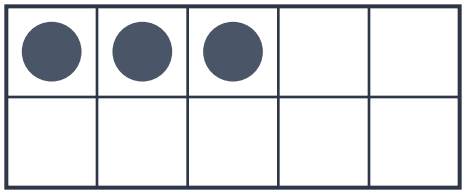

I can find how many more make **10**.

© 2026 Eggroll Games

Number Pairs to 10

Exit Ticket 8.7: Partners of 10

Name _____ **Exit Ticket 8.7**

1. Write the number that makes 10.

8	+		=	10
	+	5	=	10

I can write the partner that makes **10**.

Name _____ **Exit Ticket 8.7**

1. Write the number that makes 10.

8	+		=	10
	+	5	=	10

I can write the partner that makes **10**.

© 2026 Eggroll Games

Number Pairs to 10

Exit Ticket 8.8: Make Ten game

Name _____ **Exit Ticket 8.8**

1. Circle the two cards that make 10.

3	5	8
5	1	4

2. You have a 7. Circle the card that makes 10 with it.

	7	
4	3	2

I can find two numbers that make 10.

Name _____ **Exit Ticket 8.8**

1. Circle the two cards that make 10.

3	5	8
5	1	4

2. You have a 7. Circle the card that makes 10 with it.

	7	
4	3	2

I can find two numbers that make 10.

© 2026 Eggroll Games

Number Pairs to 10

Exit Ticket 8.9: The equal sign

Name _____ **Exit Ticket 8.9**

1. Circle the one that is the same as 5 + 1.

5 + 1	=	2 + 3	3 + 3	4 + 3
●●●●●+●		●●+●●●	●●●+●●●	●●●●+●●●

I can tell when both sides are the same.

Name _____ **Exit Ticket 8.9**

1. Circle the one that is the same as 5 + 1.

5 + 1	=	2 + 3	3 + 3	4 + 3
●●●●●+●		●●+●●●	●●●+●●●	●●●●+●●●

I can tell when both sides are the same.

© 2026 Eggroll Games

Number Pairs to 10

Exit Ticket 8.10: Number pair stories

Name _____ **Exit Ticket 8.10**

1. **There are 5 peppers. 3 are in the bowl. The rest are next to the bowl. How many are next to the bowl?**

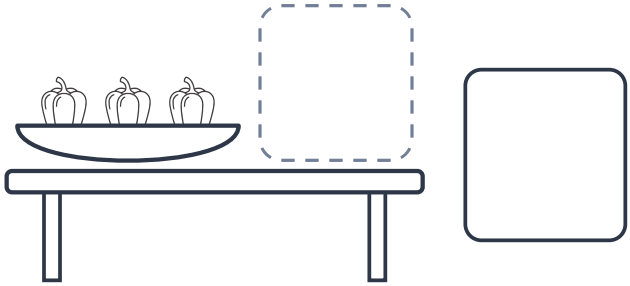

2. **There are 8 tomatoes. 2 are in the bowl. The rest are next to the bowl. How many are next to the bowl?**

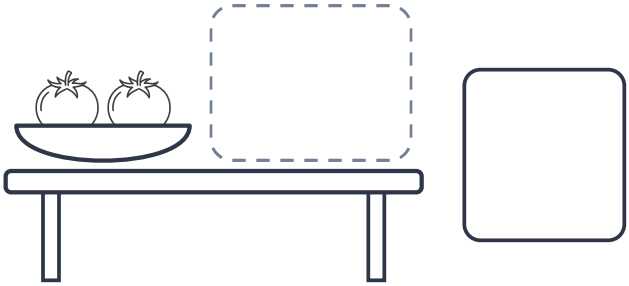

I can solve a number pair story.

Name _____ **Exit Ticket 8.10**

1. **There are 5 peppers. 3 are in the bowl. The rest are next to the bowl. How many are next to the bowl?**

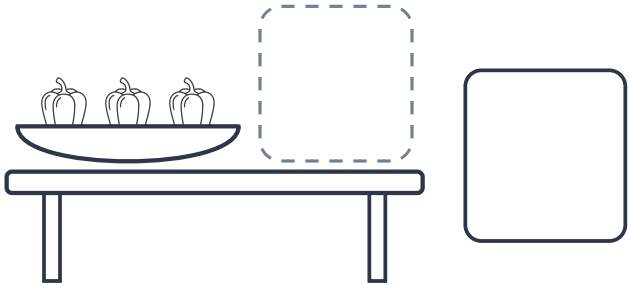

2. **There are 8 tomatoes. 2 are in the bowl. The rest are next to the bowl. How many are next to the bowl?**

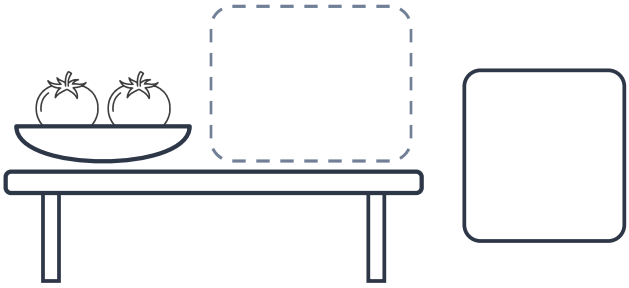

I can solve a number pair story.

© 2026 Eggroll Games

ANSWER KEY

Number Pairs to 10

Exit Ticket 8.1: Ways to make 5

Name _____ **Exit Ticket 8.1**

1. How many more dots make 5? Write the number.

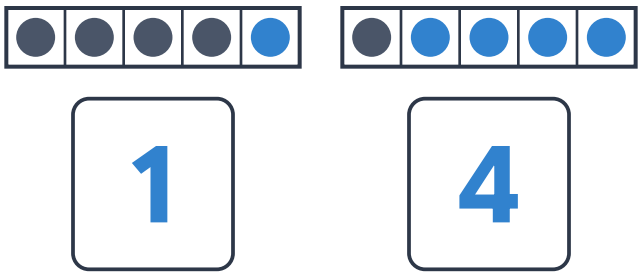

2. There are 5 pineapples. Some are in the box. How many are in the box?

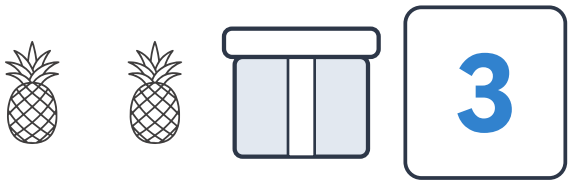

I can find ways to make 5.

Name _____ Exit Ticket 8.1

1. How many more dots make 5? Write the number.

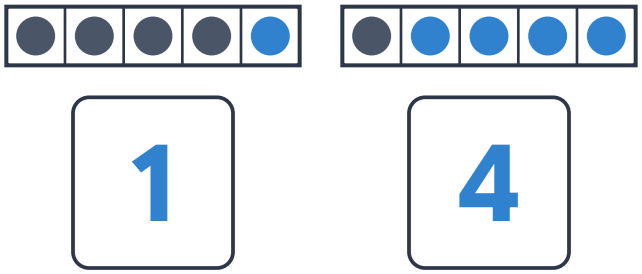

2. There are 5 pineapples. Some are in the box. How many are in the box?

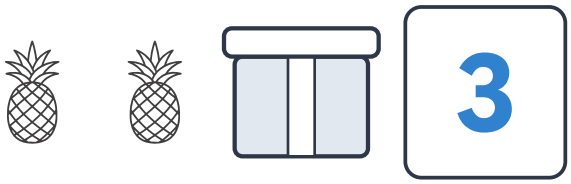

I can find ways to make 5.

ANIMAL MATH

Find worksheets, teacher tools, and more at animalmath.com

© 2026 Eggroll Games

ANSWER KEY

Number Pairs to 10

Exit Ticket 8.2: Number bonds to 5

Name _____ **Exit Ticket 8.2**

1. Write the missing part in the number bond.

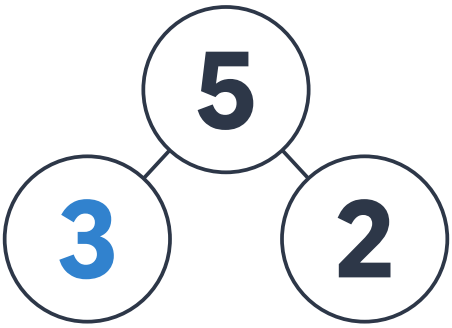

2. Write the whole in the number bond.

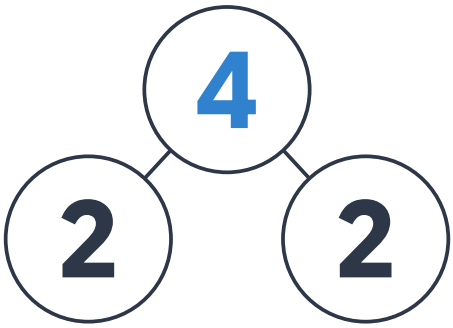

I can find a missing part or the whole.

Name _____ **Exit Ticket 8.2**

1. Write the missing part in the number bond.

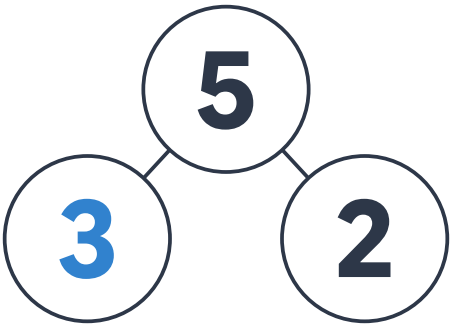

2. Write the whole in the number bond.

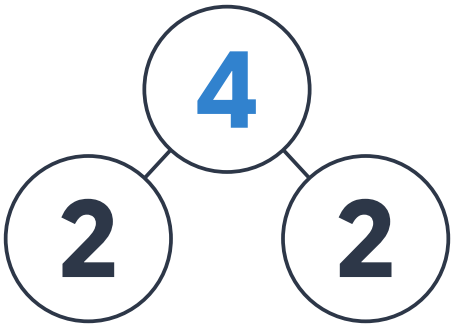

I can find a missing part or the whole.

© 2026 Eggroll Games

Number Pairs to 10

Exit Ticket 8.3: Ways to make 6, 7 and 8

Name _____ **Exit Ticket 8.3**

1. Count the dots. Circle the domino that makes 8.

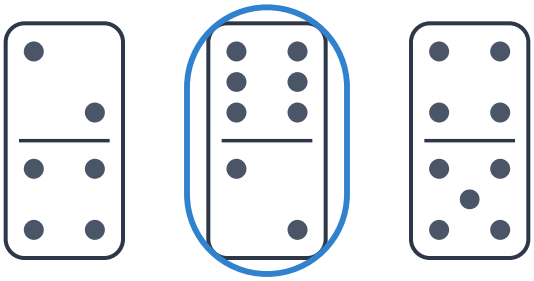

2. 7 counters. How many are gray? How many are white? Write each number.

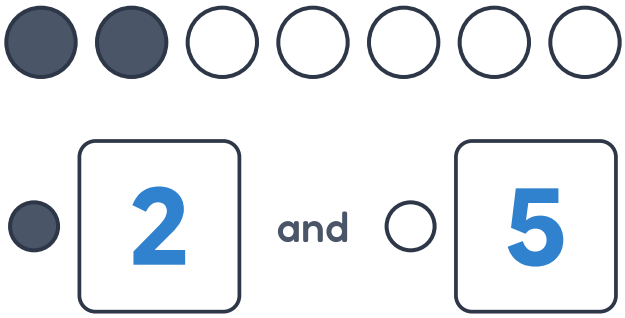

I can find ways to make **6, 7** and **8.**

Name _____ **Exit Ticket 8.3**

1. Count the dots. Circle the domino that makes 8.

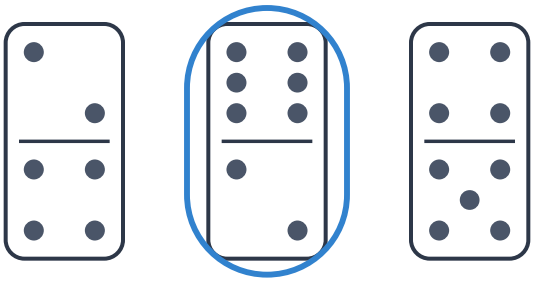

2. 7 counters. How many are gray? How many are white? Write each number.

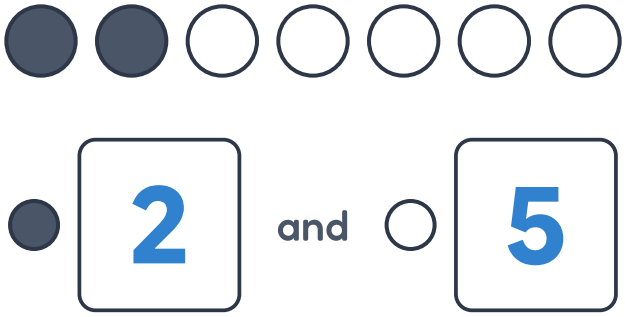

I can find ways to make **6, 7** and **8.**

© 2026 Eggroll Games

ANSWER KEY

Number Pairs to 10

Exit Ticket 8.4: Ways to make 9 and 10

Name _____ **Exit Ticket 8.4**

1. There are 10 carrots. Some are in the box. How many are in the box?

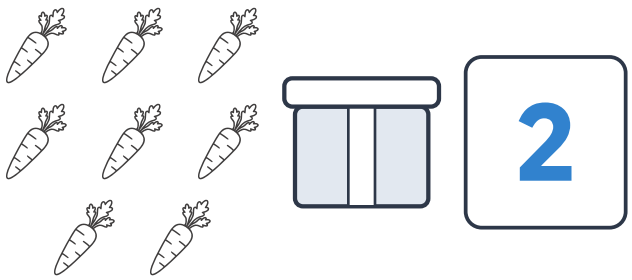

2. Write the missing part in the number bond.



I can find ways to make 9 and 10.

Name _____ **Exit Ticket 8.4**

1. There are 10 carrots. Some are in the box. How many are in the box?

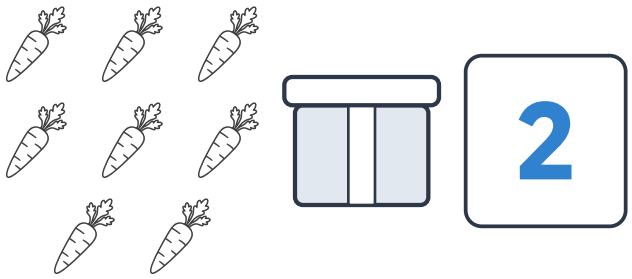

2. Write the missing part in the number bond.

I can find ways to make 9 and 10.

ANIMAL MATH

Find worksheets, teacher tools, and more at animalmath.com

© 2026 Eggroll Games

ANSWER KEY

Number Pairs to 10

Exit Ticket 8.5: Write a number sentence

Name _____ **Exit Ticket 8.5**

1. Write how many in all, then each group.

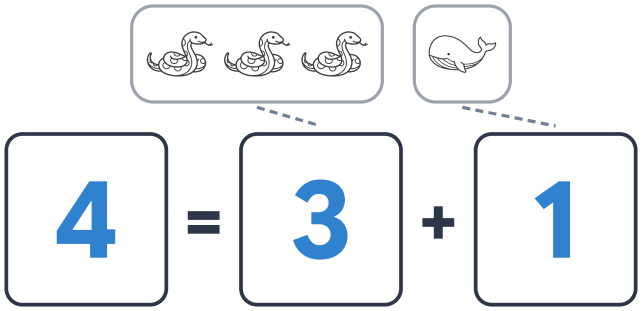

2. Write how many in all, then each group.

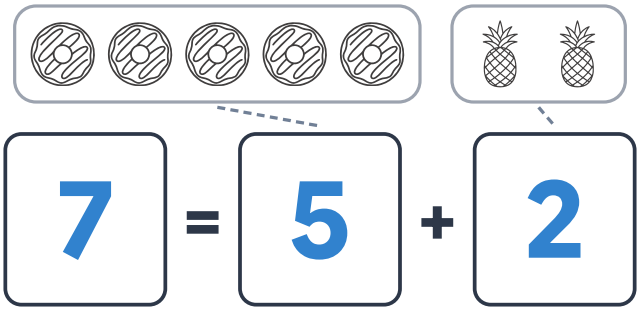

I can write a number pair as a number sentence.

Name _____ **Exit Ticket 8.5**

1. Write how many in all, then each group.

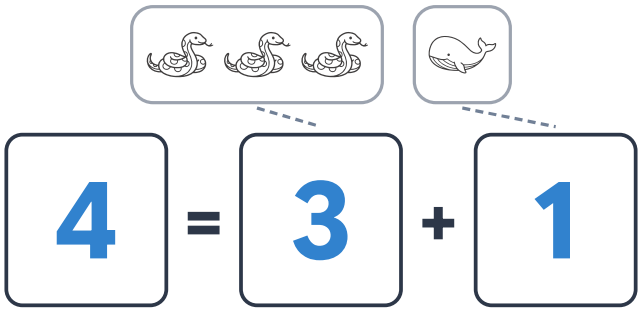

2. Write how many in all, then each group.

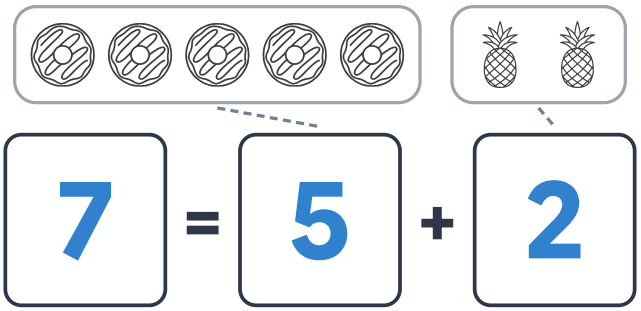

I can write a number pair as a number sentence.

© 2026 Eggroll Games

Number Pairs to 10

Exit Ticket 8.6: How many more make 10

Name _____ **Exit Ticket 8.6**

1. How many more dots make 10? Write the number.



6

2. Draw more dots to make 10.



I can find how many more make **10**.

Name _____ **Exit Ticket 8.6**

1. How many more dots make 10? Write the number.



6

2. Draw more dots to make 10.



I can find how many more make **10**.

© 2026 Eggroll Games

ANSWER KEY

Number Pairs to 10

Exit Ticket 8.7: Partners of 10

Name _____ **Exit Ticket 8.7**

1. Write the number that makes 10.

8	+	2	=	10
5	+	5	=	10

I can write the partner that makes **10**.

Name _____ **Exit Ticket 8.7**

1. Write the number that makes 10.

8	+	2	=	10
5	+	5	=	10

I can write the partner that makes **10**.

© 2026 Eggroll Games

ANSWER KEY

Number Pairs to 10

Exit Ticket 8.8: Make Ten game

Name _____ Exit Ticket 8.8

1. Circle the two cards that make 10.

3 5 8

5 1 4

2. You have a 7. Circle the card that makes 10 with it.

7

4 3 2

I can find two numbers that make 10.

Name _____ Exit Ticket 8.8

1. Circle the two cards that make 10.

3 5 8

5 1 4

2. You have a 7. Circle the card that makes 10 with it.

7

4 3 2

I can find two numbers that make 10.

© 2026 Eggroll Games

ANSWER KEY

Number Pairs to 10

Exit Ticket 8.9: The equal sign

Name _____ **Exit Ticket 8.9**

1. Circle the one that is the same as 5 + 1.

5 + 1 ●●●●●+● **=** **2 + 3** ●●+●●● **3 + 3** ●●●+●●● **4 + 3** ●●●●+●●●

I can tell when both sides are the same.

Name _____ Exit Ticket 8.9

1. Circle the one that is the same as 5 + 1.

5 + 1 ●●●●●+● = 2 + 3 ●●+●●● 3 + 3 ●●●+●●● 4 + 3 ●●●●+●●●

I can tell when both sides are the same.

© 2026 Eggroll Games

ANSWER KEY

Number Pairs to 10

Exit Ticket 8.10: Number pair stories

Name _____ **Exit Ticket 8.10**

1. **There are 5 peppers. 3 are in the bowl. The rest are next to the bowl. How many are next to the bowl?**

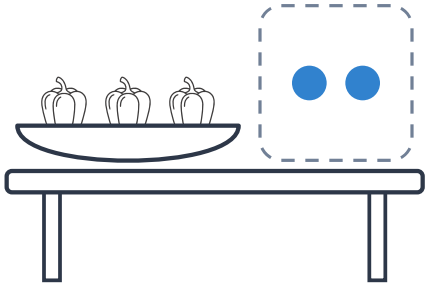

2

2. **There are 8 tomatoes. 2 are in the bowl. The rest are next to the bowl. How many are next to the bowl?**

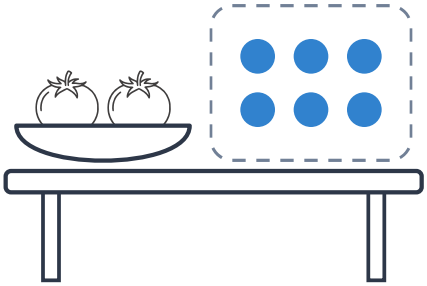

6

I can solve a number pair story.

Name _____ **Exit Ticket 8.10**

1. **There are 5 peppers. 3 are in the bowl. The rest are next to the bowl. How many are next to the bowl?**

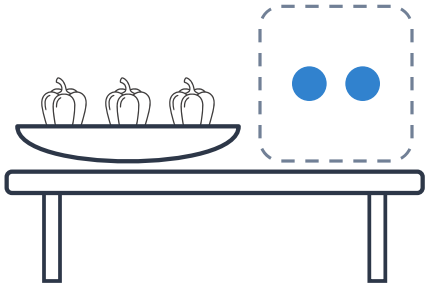

2

2. **There are 8 tomatoes. 2 are in the bowl. The rest are next to the bowl. How many are next to the bowl?**

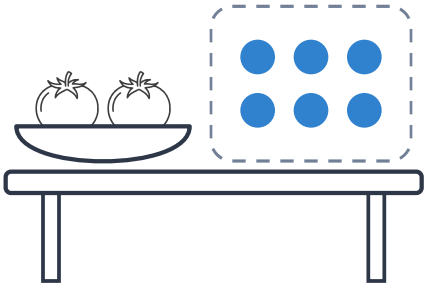

6

I can solve a number pair story.

© 2026 Eggroll Games