Money, Patterns, Calendar

Exit Ticket 13.1: Name the coins

Name _____ **Exit Ticket 13.1**

1. Circle every quarter.

2. Draw a line from each coin to its name.

penny | nickel | dime

I can name pennies, nickels, dimes and quarters.

Name _____ **Exit Ticket 13.1**

1. Circle every quarter.

2. Draw a line from each coin to its name.

penny | nickel | dime

I can name pennies, nickels, dimes and quarters.

© 2026 Eggroll Games

Money, Patterns, Calendar

Exit Ticket 13.2: Heads and tails

Name _____ **Exit Ticket 13.2**

1. How many quarters? Write the number.

2. How many coins show heads? Write the number.

I can find heads and tails and count coins.

Name _____ **Exit Ticket 13.2**

1. How many quarters? Write the number.

2. How many coins show heads? Write the number.

I can find heads and tails and count coins.

© 2026 Eggroll Games

Money, Patterns, Calendar

Exit Ticket 13.3: What coins are worth

Name _____ **Exit Ticket 13.3**

1. Circle the coin worth 5 cents.

2. Which coin is worth more? Circle it.

I can tell what a penny, a nickel and a dime are worth.

Name _____ **Exit Ticket 13.3**

1. Circle the coin worth 5 cents.

2. Which coin is worth more? Circle it.

I can tell what a penny, a nickel and a dime are worth.

© 2026 Eggroll Games

Money, Patterns, Calendar

Exit Ticket 13.4: Earning money

Name _____ **Exit Ticket 13.4**

1. Which one earns money: playing basketball, working as a firefighter or a birthday gift? Circle it.

playing basketball

working as a firefighter

a birthday gift

2. Which one earns money: a gift from Grandpa, riding a skateboard or selling lemonade? Circle it.

a gift from Grandpa


riding a skateboard

selling lemonade

I can tell how people earn money.

Name _____ **Exit Ticket 13.4**

1. Which one earns money: playing basketball, working as a firefighter or a birthday gift? Circle it.

playing basketball

working as a firefighter

a birthday gift

2. Which one earns money: a gift from Grandpa, riding a skateboard or selling lemonade? Circle it.

a gift from Grandpa


riding a skateboard

selling lemonade

I can tell how people earn money.

© 2026 Eggroll Games

Money, Patterns, Calendar

Exit Ticket 13.5: Needs and wants

Name _____ **Exit Ticket 13.5**

1. Which one is a need: water, a toy rocket or a movie ticket? Circle it.

water


a toy rocket

a movie ticket

2. Which one is a want: an apple, a basketball or a bed? Circle it.

an apple

a basketball

a bed

I can tell needs from wants.

Name _____ **Exit Ticket 13.5**

1. Which one is a need: water, a toy rocket or a movie ticket? Circle it.

water


a toy rocket

a movie ticket

2. Which one is a want: an apple, a basketball or a bed? Circle it.

an apple

a basketball

a bed

I can tell needs from wants.

© 2026 Eggroll Games

Money, Patterns, Calendar

Exit Ticket 13.6: Repeating patterns

Name _____ **Exit Ticket 13.6**

1. What comes next? Circle it.



2. Draw the shape that comes next.

I can tell what comes next in a pattern.

Name _____ **Exit Ticket 13.6**

1. What comes next? Circle it.



2. Draw the shape that comes next.

I can tell what comes next in a pattern.

© 2026 Eggroll Games

Money, Patterns, Calendar

Exit Ticket 13.7: The part that repeats

Name _____ **Exit Ticket 13.7**

1. Circle the part that repeats.

☆ □ ☆ □ ☆ □ ☆ □

2. Circle the part that repeats.

△ ♡ ♡ △ ♡ ♡ △ ♡ ♡

I can find the part of a pattern that repeats.

☺ 😐 ☹

Name _____ **Exit Ticket 13.7**

1. Circle the part that repeats.

☆ □ ☆ □ ☆ □ ☆ □

2. Circle the part that repeats.

△ ♡ ♡ △ ♡ ♡ △ ♡ ♡

I can find the part of a pattern that repeats.

☺ 😐 ☹

© 2026 Eggroll Games

Money, Patterns, Calendar

Exit Ticket 13.8: Growing patterns

Name _____ **Exit Ticket 13.8**

1. Draw the next step. How many cubes?

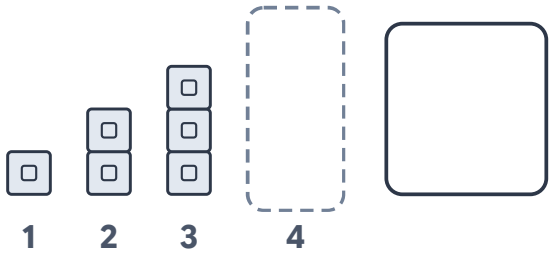

2. What comes next? Circle it.

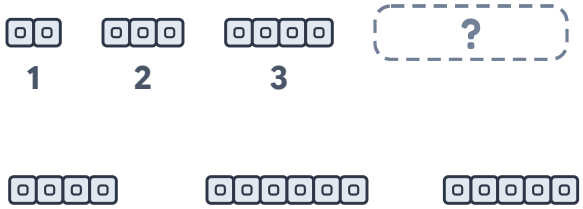

I can continue a growing pattern.

Name _____ **Exit Ticket 13.8**

1. Draw the next step. How many cubes?

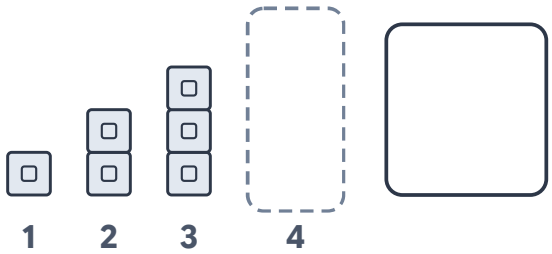

2. What comes next? Circle it.

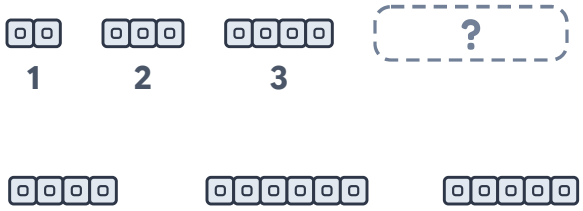

I can continue a growing pattern.

© 2026 Eggroll Games

Money, Patterns, Calendar

Exit Ticket 13.9: Share fairly

Name _____ **Exit Ticket 13.9**

1. Share the 6 cupcakes fairly. How many on each plate?



2. Are the pears shared fairly? Circle yes or no.

yes **no**

I can share things fairly.

Name _____ **Exit Ticket 13.9**

1. Share the 6 cupcakes fairly. How many on each plate?



2. Are the pears shared fairly? Circle yes or no.

yes **no**

I can share things fairly.

© 2026 Eggroll Games

Money, Patterns, Calendar

Exit Ticket 13.10: Days of the week

Name _____ **Exit Ticket 13.10**

1. Today is Tuesday, the day with the star. Circle yesterday.

S	M	T	W	T	F	S
Sun	Mon	Tue	Wed	Thu	Fri	Sat

2. Today is Thursday, the day with the star. Circle tomorrow.

S	M	T	W	T	F	S
Sun	Mon	Tue	Wed	Thu	Fri	Sat

I can use yesterday, today and tomorrow.

Name _____ **Exit Ticket 13.10**

1. Today is Tuesday, the day with the star. Circle yesterday.

S	M	T	W	T	F	S
Sun	Mon	Tue	Wed	Thu	Fri	Sat

2. Today is Thursday, the day with the star. Circle tomorrow.

S	M	T	W	T	F	S
Sun	Mon	Tue	Wed	Thu	Fri	Sat

I can use yesterday, today and tomorrow.

© 2026 Eggroll Games

Money, Patterns, Calendar

Exit Ticket 13.11: Months and the calendar

Name _____ **Exit Ticket 13.11**

1. How many Fridays are in this month?

November

S	M	T	W	T	F	S
1	2	3	4	5	6	7
8	9	10	11	12	13	14
15	16	17	18	19	20	21
22	23	24	25	26	27	28
29	30					

2. Which month comes after March? Circle it.



February

April

October

I can use the months and a calendar.

Name _____ **Exit Ticket 13.11**

1. How many Fridays are in this month?

November

S	M	T	W	T	F	S
1	2	3	4	5	6	7
8	9	10	11	12	13	14
15	16	17	18	19	20	21
22	23	24	25	26	27	28
29	30					

2. Which month comes after March? Circle it.

February

April

October

I can use the months and a calendar.

© 2026 Eggroll Games

Money, Patterns, Calendar

Exit Ticket 13.12: Morning, afternoon and night

Name _____ **Exit Ticket 13.12**

1. Write 1, 2 and 3 to put the day in order.

sleep

breakfast

after school

2. Which takes longer: a day at school or eat an apple? Circle it.

a day at school

eat an apple

I can put the parts of a day in order.

Name _____ **Exit Ticket 13.12**

1. Write 1, 2 and 3 to put the day in order.

sleep

breakfast

after school

2. Which takes longer: a day at school or eat an apple? Circle it.

a day at school

eat an apple

I can put the parts of a day in order.

© 2026 Eggroll Games

Money, Patterns, Calendar

Exit Ticket 13.1: Name the coins

Name _____ **Exit Ticket 13.1**

1. Circle every quarter.

2. Draw a line from each coin to its name.



penny | nickel | dime

I can name pennies, nickels, dimes and quarters.

Name _____ **Exit Ticket 13.1**

1. Circle every quarter.

2. Draw a line from each coin to its name.



penny | nickel | dime

I can name pennies, nickels, dimes and quarters.

© 2026 Eggroll Games

Money, Patterns, Calendar

Exit Ticket 13.2: Heads and tails

Name _____ **Exit Ticket 13.2**

1. How many quarters? Write the number.

3

2. How many coins show heads? Write the number.

4

I can find heads and tails and count coins.

Name _____ **Exit Ticket 13.2**

1. How many quarters? Write the number.

3

2. How many coins show heads? Write the number.

4

I can find heads and tails and count coins.

© 2026 Eggroll Games

Money, Patterns, Calendar

Exit Ticket 13.3: What coins are worth

Name _____ **Exit Ticket 13.3**

1. Circle the coin worth 5 cents.

2. Which coin is worth more? Circle it.

I can tell what a penny, a nickel and a dime are worth.

Name _____ **Exit Ticket 13.3**

1. Circle the coin worth 5 cents.

2. Which coin is worth more? Circle it.

I can tell what a penny, a nickel and a dime are worth.

© 2026 Eggroll Games

Money, Patterns, Calendar

Exit Ticket 13.4: Earning money

Name _____ Exit Ticket 13.4

1. Which one earns money: playing basketball, working as a firefighter or a birthday gift? Circle it.

playing basketball | **working as a firefighter** | a birthday gift

2. Which one earns money: a gift from Grandpa, riding a skateboard or selling lemonade? Circle it.

a gift from Grandpa | riding a skateboard | **selling lemonade**

I can tell how people earn money.

Name _____ Exit Ticket 13.4

1. Which one earns money: playing basketball, working as a firefighter or a birthday gift? Circle it.

playing basketball | **working as a firefighter** | a birthday gift

2. Which one earns money: a gift from Grandpa, riding a skateboard or selling lemonade? Circle it.

a gift from Grandpa | riding a skateboard | **selling lemonade**

I can tell how people earn money.

© 2026 Eggroll Games

Money, Patterns, Calendar

Exit Ticket 13.5: Needs and wants

Name _____ **Exit Ticket 13.5**

1. Which one is a need: water, a toy rocket or a movie ticket? Circle it.



2. Which one is a want: an apple, a basketball or a bed? Circle it.

I can tell needs from wants.

Name _____ **Exit Ticket 13.5**

1. Which one is a need: water, a toy rocket or a movie ticket? Circle it.



2. Which one is a want: an apple, a basketball or a bed? Circle it.

I can tell needs from wants.

© 2026 Eggroll Games

Money, Patterns, Calendar

Exit Ticket 13.6: Repeating patterns

Name _____ **Exit Ticket 13.6**

1. What comes next? Circle it.

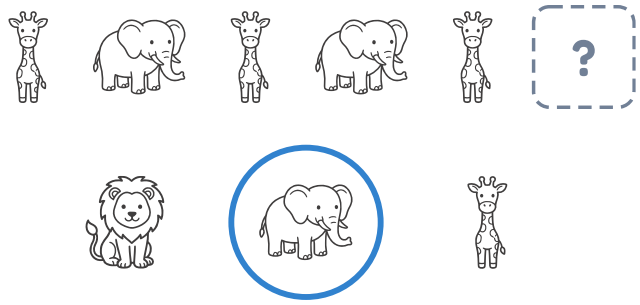

2. Draw the shape that comes next.

I can tell what comes next in a pattern.

Name _____ **Exit Ticket 13.6**

1. What comes next? Circle it.

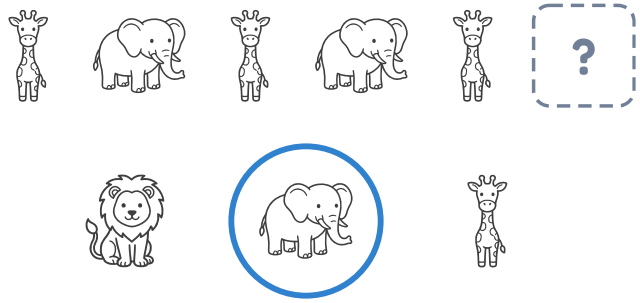

2. Draw the shape that comes next.

I can tell what comes next in a pattern.

© 2026 Eggroll Games

Money, Patterns, Calendar

Exit Ticket 13.7: The part that repeats

Name _____ Exit Ticket 13.7

1. Circle the part that repeats.

2. Circle the part that repeats.

I can find the part of a pattern that repeats.

Name _____ Exit Ticket 13.7

1. Circle the part that repeats.

2. Circle the part that repeats.

I can find the part of a pattern that repeats.

© 2026 Eggroll Games

Money, Patterns, Calendar

Exit Ticket 13.8: Growing patterns

Name _____ **Exit Ticket 13.8**

1. Draw the next step. How many cubes?

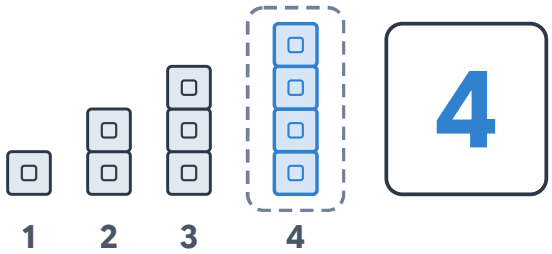

2. What comes next? Circle it.

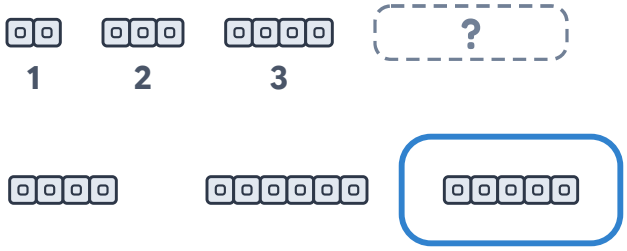

I can continue a growing pattern.

Name _____ **Exit Ticket 13.8**

1. Draw the next step. How many cubes?

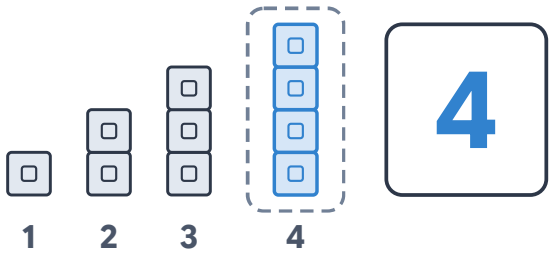

2. What comes next? Circle it.

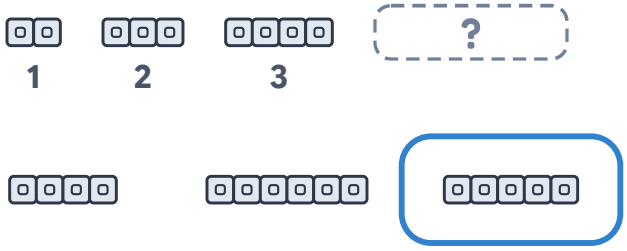

I can continue a growing pattern.

© 2026 Eggroll Games

Money, Patterns, Calendar

Exit Ticket 13.9: Share fairly

Name _____ **Exit Ticket 13.9**

1. Share the 6 cupcakes fairly. How many on each plate?

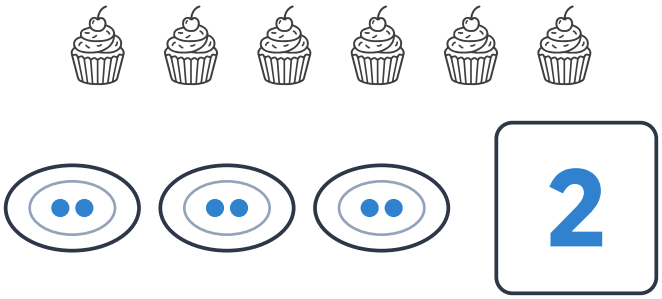

2. Are the pears shared fairly? Circle yes or no.

yes **no**

I can share things fairly.

Name _____ **Exit Ticket 13.9**

1. Share the 6 cupcakes fairly. How many on each plate?

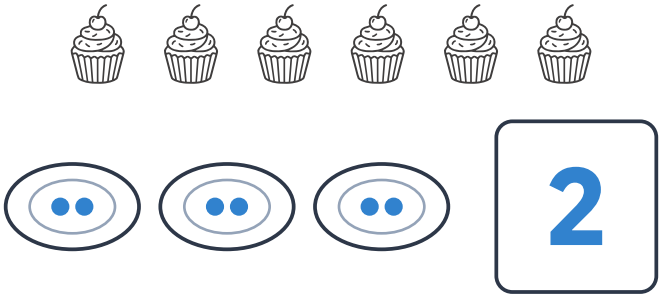

2. Are the pears shared fairly? Circle yes or no.

yes **no**

I can share things fairly.

© 2026 Eggroll Games

Money, Patterns, Calendar

Exit Ticket 13.10: Days of the week

Name _____ **Exit Ticket 13.10**

1. Today is Tuesday, the day with the star. Circle yesterday.

S	M	T	W	T	F	S
Sun	Mon	Tue	Wed	Thu	Fri	Sat

2. Today is Thursday, the day with the star. Circle tomorrow.

S	M	T	W	T	F	S
Sun	Mon	Tue	Wed	Thu	Fri	Sat

I can use yesterday, today and tomorrow.

Name _____ **Exit Ticket 13.10**

1. Today is Tuesday, the day with the star. Circle yesterday.

S	M	T	W	T	F	S
Sun	Mon	Tue	Wed	Thu	Fri	Sat

2. Today is Thursday, the day with the star. Circle tomorrow.

S	M	T	W	T	F	S
Sun	Mon	Tue	Wed	Thu	Fri	Sat

I can use yesterday, today and tomorrow.

© 2026 Eggroll Games

Money, Patterns, Calendar

Exit Ticket 13.11: Months and the calendar

Name _____ Exit Ticket 13.11

1. How many Fridays are in this month?

November

S	M	T	W	T	F	S
1	2	3	4	5	6	7
8	9	10	11	12	13	14
15	16	17	18	19	20	21
22	23	24	25	26	27	28
29	30					

4

2. Which month comes after March? Circle it.



February

April

October

I can use the months and a calendar.

Name _____ Exit Ticket 13.11

1. How many Fridays are in this month?

November

S	M	T	W	T	F	S
1	2	3	4	5	6	7
8	9	10	11	12	13	14
15	16	17	18	19	20	21
22	23	24	25	26	27	28
29	30					

4

2. Which month comes after March? Circle it.

February

April

October

I can use the months and a calendar.

© 2026 Eggroll Games

Money, Patterns, Calendar

Exit Ticket 13.12: Morning, afternoon and night

Name _____ Exit Ticket 13.12

1. Write 1, 2 and 3 to put the day in order.

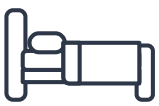
sleep

breakfast

after school

3 1 2

2. Which takes longer: a day at school or eat an apple? Circle it.

a day at school

eat an apple

I can put the parts of a day in order.

Name _____ Exit Ticket 13.12

1. Write 1, 2 and 3 to put the day in order.

sleep

breakfast

after school

3 1 2

2. Which takes longer: a day at school or eat an apple? Circle it.


a day at school

eat an apple

I can put the parts of a day in order.

© 2026 Eggroll Games