Numbers to 120

Exit Ticket 1.1: Count on from any number

Name _____ **Exit Ticket 1.1**

1. Count on. Fill in the boxes.

37	38			

2. Count on. Fill in the boxes.

68		70		

3. What comes next? Write it.

49		89		99	

I can count on from any number. ☺ 😐 ☹

Name _____ **Exit Ticket 1.1**

1. Count on. Fill in the boxes.

37	38			

2. Count on. Fill in the boxes.

68		70		

3. What comes next? Write it.

49		89		99	

I can count on from any number. ☺ 😐 ☹

Name _____ **Exit Ticket 1.1**

1. Count on. Fill in the boxes.

37	38			

2. Count on. Fill in the boxes.

68		70		

3. What comes next? Write it.

49		89		99	

I can count on from any number. ☺ 😐 ☹

Name _____ **Exit Ticket 1.1**

1. Count on. Fill in the boxes.

37	38			

2. Count on. Fill in the boxes.

68		70		

3. What comes next? Write it.

49		89		99	

I can count on from any number. ☺ 😐 ☹

© 2026 Eggroll Games

Numbers to 120

Exit Ticket 1.2: Count back from any number

Name _____ **Exit Ticket 1.2**

1. Count back. Fill in the boxes.

72	71			

2. Count back. Fill in the boxes.

31		29		

3. What comes just before? Write it.

	60		40		100

I can count back from any number. ☺ 😐 ☹

Name _____ **Exit Ticket 1.2**

1. Count back. Fill in the boxes.

72	71			

2. Count back. Fill in the boxes.

31		29		

3. What comes just before? Write it.

	60		40		100

I can count back from any number. ☺ 😐 ☹

Name _____ **Exit Ticket 1.2**

1. Count back. Fill in the boxes.

72	71			

2. Count back. Fill in the boxes.

31		29		

3. What comes just before? Write it.

	60		40		100

I can count back from any number. ☺ 😐 ☹

Name _____ **Exit Ticket 1.2**

1. Count back. Fill in the boxes.

72	71			

2. Count back. Fill in the boxes.

31		29		

3. What comes just before? Write it.

	60		40		100

I can count back from any number. ☺ 😐 ☹

© 2026 Eggroll Games

Numbers to 120

Exit Ticket 1.3: Count past 100 to 120

Name _____ **Exit Ticket 1.3**

1. Count on past **100**. Fill in the boxes.

99	100			

2. Count on past **100**. Fill in the boxes.

107		109		

3. Count back. Fill in the boxes.

102	101			

I can count past **100**.

Name _____ **Exit Ticket 1.3**

1. Count on past **100**. Fill in the boxes.

99	100			

2. Count on past **100**. Fill in the boxes.

107		109		

3. Count back. Fill in the boxes.

102	101			

I can count past **100**.

Name _____ **Exit Ticket 1.3**

1. Count on past **100**. Fill in the boxes.

99	100			

2. Count on past **100**. Fill in the boxes.

107		109		

3. Count back. Fill in the boxes.

102	101			

I can count past **100**.

Name _____ **Exit Ticket 1.3**

1. Count on past **100**. Fill in the boxes.

99	100			

2. Count on past **100**. Fill in the boxes.

107		109		

3. Count back. Fill in the boxes.

102	101			

I can count past **100**.

© 2026 Eggroll Games

Numbers to 120

Exit Ticket 1.4: Numbers on the 120 chart

Name _____ **Exit Ticket 1.4**

1. **Fill in this row of the 120 chart.**

111			114	

2. **This is a piece of the 120 chart. Write the missing numbers.**

	57	

I can read and write numbers on the 120 chart. ☺ 😐 ☹

Name _____ **Exit Ticket 1.4**

1. **Fill in this row of the 120 chart.**

111			114	

2. **This is a piece of the 120 chart. Write the missing numbers.**

	57	

I can read and write numbers on the 120 chart. ☺ 😐 ☹

Name _____ **Exit Ticket 1.4**

1. **Fill in this row of the 120 chart.**

111			114	

2. **This is a piece of the 120 chart. Write the missing numbers.**

	57	

I can read and write numbers on the 120 chart. ☺ 😐 ☹

Name _____ **Exit Ticket 1.4**

1. **Fill in this row of the 120 chart.**

111			114	

2. **This is a piece of the 120 chart. Write the missing numbers.**

	57	

I can read and write numbers on the 120 chart. ☺ 😐 ☹

© 2026 Eggroll Games

Numbers to 120

Exit Ticket 1.5: Before, after and between

Name _____ **Exit Ticket 1.5**

1. Write the numbers just before and after. Then write the number between.

	28	
80		82

2. Circle the number just after 59.

58 60 69

I can find the number before, after or between.

Name _____ **Exit Ticket 1.5**

1. Write the numbers just before and after. Then write the number between.

	28	
80		82

2. Circle the number just after 59.

58 60 69

I can find the number before, after or between.

Name _____ **Exit Ticket 1.5**

1. Write the numbers just before and after. Then write the number between.

	28	
80		82

2. Circle the number just after 59.

58 60 69

I can find the number before, after or between.

Name _____ **Exit Ticket 1.5**

1. Write the numbers just before and after. Then write the number between.

	28	
80		82

2. Circle the number just after 59.

58 60 69

I can find the number before, after or between.

ANIMAL MATH

Find worksheets, teacher tools, and more at animalmath.com

© 2026 Eggroll Games

Numbers to 120

Exit Ticket 1.6: Count big groups by tens

Name _____ **Exit Ticket 1.6**

1. Count by tens, then count on the ones. How many dots?

_____ **dots**

2. How many dots?



_____ **dots**

I can count big groups by tens. ☺ 😐 ☹

Name _____ **Exit Ticket 1.6**

1. Count by tens, then count on the ones. How many dots?

_____ **dots**

2. How many dots?



_____ **dots**

I can count big groups by tens. ☺ 😐 ☹

Name _____ **Exit Ticket 1.6**

1. Count by tens, then count on the ones. How many dots?

_____ **dots**

2. How many dots?



_____ **dots**

I can count big groups by tens. ☺ 😐 ☹

Name _____ **Exit Ticket 1.6**

1. Count by tens, then count on the ones. How many dots?

_____ **dots**

2. How many dots?



_____ **dots**

I can count big groups by tens. ☺ 😐 ☹

ANIMAL MATH

Find worksheets, teacher tools, and more at animalmath.com

© 2026 Eggroll Games

Numbers to 120

Exit Ticket 1.7: Numbers on a number line

Name _____ **Exit Ticket 1.7**

1. Write the missing numbers on the number line.

62 [ ] 64 65 [ ] 67 68

2. Write the missing numbers on the number line.

97 98 [ ] 100 101 [ ] 103

I can find numbers on a number line.

Name _____ **Exit Ticket 1.7**

1. Write the missing numbers on the number line.

62 [ ] 64 65 [ ] 67 68

2. Write the missing numbers on the number line.

97 98 [ ] 100 101 [ ] 103

I can find numbers on a number line.

Name _____ **Exit Ticket 1.7**

1. Write the missing numbers on the number line.

62 [ ] 64 65 [ ] 67 68

2. Write the missing numbers on the number line.

97 98 [ ] 100 101 [ ] 103

I can find numbers on a number line.

Name _____ **Exit Ticket 1.7**

1. Write the missing numbers on the number line.

62 [ ] 64 65 [ ] 67 68

2. Write the missing numbers on the number line.

97 98 [ ] 100 101 [ ] 103

I can find numbers on a number line.

© 2026 Eggroll Games

Numbers to 120

Exit Ticket 1.8: Skip count by 2s, 5s and 10s

Name _____ **Exit Ticket 1.8**

1. Skip count by 2s.

14	16			

2. Skip count by 5s.

35	40			

3. Skip count by 10s.

50	60			

I can skip count by 2s, 5s and 10s. ☺ 😐 ☹

Name _____ **Exit Ticket 1.8**

1. Skip count by 2s.

14	16			

2. Skip count by 5s.

35	40			

3. Skip count by 10s.

50	60			

I can skip count by 2s, 5s and 10s. ☺ 😐 ☹

Name _____ **Exit Ticket 1.8**

1. Skip count by 2s.

14	16			

2. Skip count by 5s.

35	40			

3. Skip count by 10s.

50	60			

I can skip count by 2s, 5s and 10s. ☺ 😐 ☹

Name _____ **Exit Ticket 1.8**

1. Skip count by 2s.

14	16			

2. Skip count by 5s.

35	40			

3. Skip count by 10s.

50	60			

I can skip count by 2s, 5s and 10s. ☺ 😐 ☹

© 2026 Eggroll Games

Numbers to 120

Exit Ticket 1.9: Number words to 20

Name _____ **Exit Ticket 1.9**

1. Write the number for the word. Then write the word for the number.

sixteen ☐

14 _____

2. Circle the word for **20**.

twelve twenty two

I can read and write number words. ☺ 😐 ☹

Name _____ **Exit Ticket 1.9**

1. Write the number for the word. Then write the word for the number.

sixteen ☐

14 _____

2. Circle the word for **20**.

twelve twenty two

I can read and write number words. ☺ 😐 ☹

Name _____ **Exit Ticket 1.9**

1. Write the number for the word. Then write the word for the number.

sixteen ☐

14 _____

2. Circle the word for **20**.

twelve twenty two

I can read and write number words. ☺ 😐 ☹

Name _____ **Exit Ticket 1.9**

1. Write the number for the word. Then write the word for the number.

sixteen ☐

14 _____

2. Circle the word for **20**.

twelve twenty two

I can read and write number words. ☺ 😐 ☹

© 2026 Eggroll Games

Numbers to 120

Exit Ticket 1.10: Ordinal numbers to tenth

Name _____ **Exit Ticket 1.10**

1. Circle the 2nd animal. Put an X on the 6th animal.

1st

2. Circle the 5th animal. Put an X on the 3rd animal.

1st

I can use 1st, 2nd, 3rd and more.

Name _____ **Exit Ticket 1.10**

1. Circle the 2nd animal. Put an X on the 6th animal.

1st

2. Circle the 5th animal. Put an X on the 3rd animal.

1st

I can use 1st, 2nd, 3rd and more.

Name _____ **Exit Ticket 1.10**

1. Circle the 2nd animal. Put an X on the 6th animal.

1st

2. Circle the 5th animal. Put an X on the 3rd animal.

1st

I can use 1st, 2nd, 3rd and more.

Name _____ **Exit Ticket 1.10**

1. Circle the 2nd animal. Put an X on the 6th animal.

1st

2. Circle the 5th animal. Put an X on the 3rd animal.

1st

I can use 1st, 2nd, 3rd and more.

© 2026 Eggroll Games

ANSWER KEY

Numbers to 120

Exit Ticket 1.1: Count on from any number

Name _____ **Exit Ticket 1.1**

1. Count on. Fill in the boxes.

37	38	39	40	41

2. Count on. Fill in the boxes.

68	69	70	71	72

3. What comes next? Write it.

49	50	89	90	99	100

I can count on from any number. ☺ 😐 ☹

Name _____ **Exit Ticket 1.1**

1. Count on. Fill in the boxes.

37	38	39	40	41

2. Count on. Fill in the boxes.

68	69	70	71	72

3. What comes next? Write it.

49	50	89	90	99	100

I can count on from any number. ☺ 😐 ☹

Name _____ **Exit Ticket 1.1**

1. Count on. Fill in the boxes.

37	38	39	40	41

2. Count on. Fill in the boxes.

68	69	70	71	72

3. What comes next? Write it.

49	50	89	90	99	100

I can count on from any number. ☺ 😐 ☹

Name _____ **Exit Ticket 1.1**

1. Count on. Fill in the boxes.

37	38	39	40	41

2. Count on. Fill in the boxes.

68	69	70	71	72

3. What comes next? Write it.

49	50	89	90	99	100

I can count on from any number. ☺ 😐 ☹

© 2026 Eggroll Games

Numbers to 120

Exit Ticket 1.2: Count back from any number

Name _____ **Exit Ticket 1.2**

1. Count back. Fill in the boxes.

72	71	70	69	68

2. Count back. Fill in the boxes.

31	30	29	28	27

3. What comes just before? Write it.

59	60	39	40	99	100

I can count back from any number. ☺ 😐 ☹

Name _____ **Exit Ticket 1.2**

1. Count back. Fill in the boxes.

72	71	70	69	68

2. Count back. Fill in the boxes.

31	30	29	28	27

3. What comes just before? Write it.

59	60	39	40	99	100

I can count back from any number. ☺ 😐 ☹

Name _____ **Exit Ticket 1.2**

1. Count back. Fill in the boxes.

72	71	70	69	68

2. Count back. Fill in the boxes.

31	30	29	28	27

3. What comes just before? Write it.

59	60	39	40	99	100

I can count back from any number. ☺ 😐 ☹

Name _____ **Exit Ticket 1.2**

1. Count back. Fill in the boxes.

72	71	70	69	68

2. Count back. Fill in the boxes.

31	30	29	28	27

3. What comes just before? Write it.

59	60	39	40	99	100

I can count back from any number. ☺ 😐 ☹

© 2026 Eggroll Games

Numbers to 120

Exit Ticket 1.3: Count past 100 to 120

Name _____ **Exit Ticket 1.3**

1. Count on past **100**. Fill in the boxes.

99	100	101	102	103

2. Count on past **100**. Fill in the boxes.

107	108	109	110	111

3. Count back. Fill in the boxes.

102	101	100	99	98

I can count past **100**. ☺ 😐 ☹

Name _____ **Exit Ticket 1.3**

1. Count on past **100**. Fill in the boxes.

99	100	101	102	103

2. Count on past **100**. Fill in the boxes.

107	108	109	110	111

3. Count back. Fill in the boxes.

102	101	100	99	98

I can count past **100**. ☺ 😐 ☹

Name _____ **Exit Ticket 1.3**

1. Count on past **100**. Fill in the boxes.

99	100	101	102	103

2. Count on past **100**. Fill in the boxes.

107	108	109	110	111

3. Count back. Fill in the boxes.

102	101	100	99	98

I can count past **100**. ☺ 😐 ☹

Name _____ **Exit Ticket 1.3**

1. Count on past **100**. Fill in the boxes.

99	100	101	102	103

2. Count on past **100**. Fill in the boxes.

107	108	109	110	111

3. Count back. Fill in the boxes.

102	101	100	99	98

I can count past **100**. ☺ 😐 ☹

© 2026 Eggroll Games

Numbers to 120

Exit Ticket 1.4: Numbers on the 120 chart

Name _____ **Exit Ticket 1.4**

1. Fill in this row of the **120** chart.

111	112	113	114	115

2. This is a piece of the **120** chart. Write the missing numbers.

	47	
56	57	58
	67	

I can read and write numbers on the **120** chart.

Name _____ **Exit Ticket 1.4**

1. Fill in this row of the **120** chart.

111	112	113	114	115

2. This is a piece of the **120** chart. Write the missing numbers.

	47	
56	57	58
	67	

I can read and write numbers on the **120** chart.

Name _____ **Exit Ticket 1.4**

1. Fill in this row of the **120** chart.

111	112	113	114	115

2. This is a piece of the **120** chart. Write the missing numbers.

	47	
56	57	58
	67	

I can read and write numbers on the **120** chart.

Name _____ **Exit Ticket 1.4**

1. Fill in this row of the **120** chart.

111	112	113	114	115

2. This is a piece of the **120** chart. Write the missing numbers.

	47	
56	57	58
	67	

I can read and write numbers on the **120** chart.

© 2026 Eggroll Games

Numbers to 120

Exit Ticket 1.5: Before, after and between

Name _____ **Exit Ticket 1.5**

1. Write the numbers just before and after. Then write the number between.

27	28	29
80	81	82

2. Circle the number just after 59.

58 **60** 69

I can find the number before, after or between. ☺ 😐 ☹

Name _____ **Exit Ticket 1.5**

1. Write the numbers just before and after. Then write the number between.

27	28	29
80	81	82

2. Circle the number just after 59.

58 **60** 69

I can find the number before, after or between. ☺ 😐 ☹

Name _____ **Exit Ticket 1.5**

1. Write the numbers just before and after. Then write the number between.

27	28	29
80	81	82

2. Circle the number just after 59.

58 **60** 69

I can find the number before, after or between. ☺ 😐 ☹

Name _____ **Exit Ticket 1.5**

1. Write the numbers just before and after. Then write the number between.

27	28	29
80	81	82

2. Circle the number just after 59.

58 **60** 69

I can find the number before, after or between. ☺ 😐 ☹

ANIMAL MATH

Find worksheets, teacher tools, and more at animalmath.com

© 2026 Eggroll Games

Numbers to 120

Exit Ticket 1.6: Count big groups by tens

Name _____ **Exit Ticket 1.6**

1. Count by tens, then count on the ones. How many dots?

36 dots

2. How many dots?



57 dots

I can count big groups by tens.

Name _____ **Exit Ticket 1.6**

1. Count by tens, then count on the ones. How many dots?

36 dots

2. How many dots?



57 dots

I can count big groups by tens.

Name _____ **Exit Ticket 1.6**

1. Count by tens, then count on the ones. How many dots?

36 dots

2. How many dots?



57 dots

I can count big groups by tens.

Name _____ **Exit Ticket 1.6**

1. Count by tens, then count on the ones. How many dots?

36 dots

2. How many dots?



57 dots

I can count big groups by tens.

© 2026 Eggroll Games

Numbers to 120

Exit Ticket 1.7: Numbers on a number line

Name _____ **Exit Ticket 1.7**

1. Write the missing numbers on the number line.

62 [63] 64 65 [66] 67 68

2. Write the missing numbers on the number line.

97 98 [99] 100 101 [102] 103

I can find numbers on a number line.

Name _____ **Exit Ticket 1.7**

1. Write the missing numbers on the number line.

62 [63] 64 65 [66] 67 68

2. Write the missing numbers on the number line.

97 98 [99] 100 101 [102] 103

I can find numbers on a number line.

Name _____ **Exit Ticket 1.7**

1. Write the missing numbers on the number line.

62 [63] 64 65 [66] 67 68

2. Write the missing numbers on the number line.

97 98 [99] 100 101 [102] 103

I can find numbers on a number line.

Name _____ **Exit Ticket 1.7**

1. Write the missing numbers on the number line.

62 [63] 64 65 [66] 67 68

2. Write the missing numbers on the number line.

97 98 [99] 100 101 [102] 103

I can find numbers on a number line.

© 2026 Eggroll Games

ANSWER KEY

Numbers to 120

Exit Ticket 1.8: Skip count by 2s, 5s and 10s

Name _____ **Exit Ticket 1.8**

1. Skip count by 2s.

14 16 18 20 22

2. Skip count by 5s.

35 40 45 50 55

3. Skip count by 10s.

50 60 70 80 90

I can skip count by 2s, 5s and 10s.

Name _____ **Exit Ticket 1.8**

1. Skip count by 2s.

14 16 18 20 22

2. Skip count by 5s.

35 40 45 50 55

3. Skip count by 10s.

50 60 70 80 90

I can skip count by 2s, 5s and 10s.

Name _____ **Exit Ticket 1.8**

1. Skip count by 2s.

14 16 18 20 22

2. Skip count by 5s.

35 40 45 50 55

3. Skip count by 10s.

50 60 70 80 90

I can skip count by 2s, 5s and 10s.

Name _____ **Exit Ticket 1.8**

1. Skip count by 2s.

14 16 18 20 22

2. Skip count by 5s.

35 40 45 50 55

3. Skip count by 10s.

50 60 70 80 90

I can skip count by 2s, 5s and 10s.

© 2026 Eggroll Games

Numbers to 120

Exit Ticket 1.9: Number words to 20

Name _____ **Exit Ticket 1.9**

1. Write the number for the word. Then write the word for the number.

sixteen **16**

14 fourteen

2. Circle the word for **20**.

twelve **twenty** two

I can read and write number words.

Name _____ **Exit Ticket 1.9**

1. Write the number for the word. Then write the word for the number.

sixteen **16**

14 fourteen

2. Circle the word for **20**.

twelve **twenty** two

I can read and write number words.

Name _____ **Exit Ticket 1.9**

1. Write the number for the word. Then write the word for the number.

sixteen **16**

14 fourteen

2. Circle the word for **20**.

twelve **twenty** two

I can read and write number words.

Name _____ **Exit Ticket 1.9**

1. Write the number for the word. Then write the word for the number.

sixteen **16**

14 fourteen

2. Circle the word for **20**.

twelve **twenty** two

I can read and write number words.

© 2026 Eggroll Games

Numbers to 120

Exit Ticket 1.10: Ordinal numbers to tenth

Name _____ **Exit Ticket 1.10**

1. Circle the 2nd animal. Put an X on the 6th animal.

1st

2. Circle the 5th animal. Put an X on the 3rd animal.

1st

I can use 1st, 2nd, 3rd and more. ☺ 😐 ☹

Name _____ **Exit Ticket 1.10**

1. Circle the 2nd animal. Put an X on the 6th animal.

1st

2. Circle the 5th animal. Put an X on the 3rd animal.

1st

I can use 1st, 2nd, 3rd and more. ☺ 😐 ☹

Name _____ **Exit Ticket 1.10**

1. Circle the 2nd animal. Put an X on the 6th animal.

1st

2. Circle the 5th animal. Put an X on the 3rd animal.

1st

I can use 1st, 2nd, 3rd and more. ☺ 😐 ☹

Name _____ **Exit Ticket 1.10**

1. Circle the 2nd animal. Put an X on the 6th animal.

1st

2. Circle the 5th animal. Put an X on the 3rd animal.

1st

I can use 1st, 2nd, 3rd and more. ☺ 😐 ☹

© 2026 Eggroll Games