Measuring Length

Exit Ticket 8.1: Longer and shorter

Name _____ **Exit Ticket 8.1**

1. Circle the longer one.



2. Circle the shorter one.

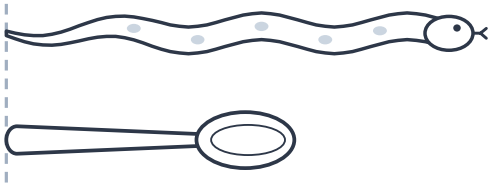

I can tell which one is longer or shorter.

Name _____ **Exit Ticket 8.1**

1. Circle the longer one.

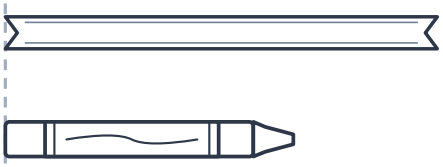

2. Circle the shorter one.

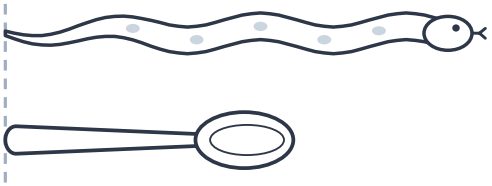

I can tell which one is longer or shorter.

Name _____ **Exit Ticket 8.1**

1. Circle the longer one.

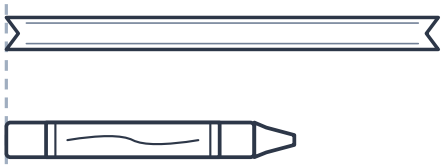

2. Circle the shorter one.

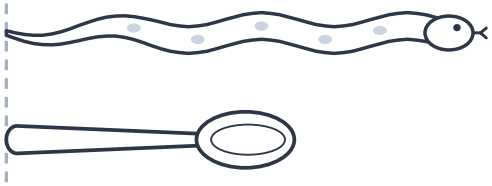

I can tell which one is longer or shorter.

Name _____ **Exit Ticket 8.1**

1. Circle the longer one.

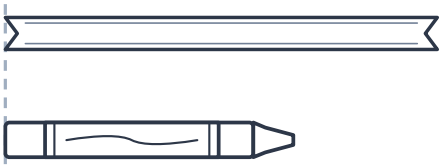

2. Circle the shorter one.

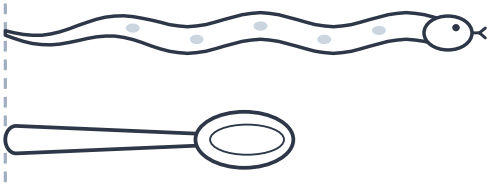

I can tell which one is longer or shorter.

© 2026 Eggroll Games

Measuring Length

Exit Ticket 8.2: Order three things by length

Name _____ **Exit Ticket 8.2**

1. Write 1, 2, 3 from shortest to longest.

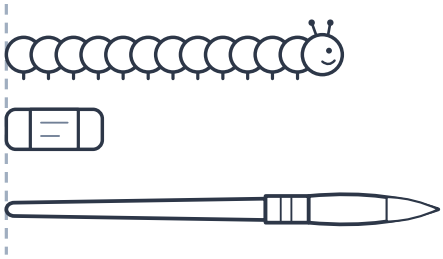

2. Circle the longest one.

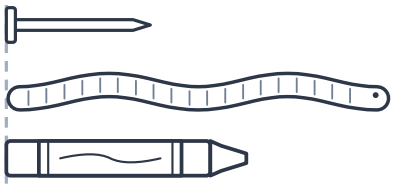

I can order things by length.

Name _____ **Exit Ticket 8.2**

1. Write 1, 2, 3 from shortest to longest.

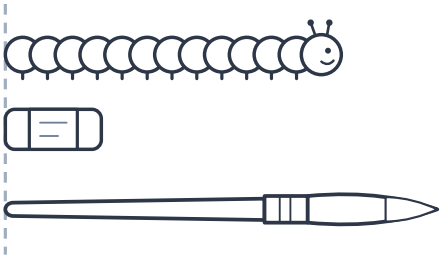

2. Circle the longest one.

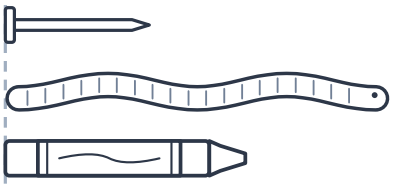

I can order things by length.

Name _____ **Exit Ticket 8.2**

1. Write 1, 2, 3 from shortest to longest.

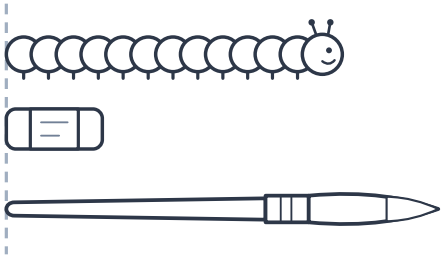

2. Circle the longest one.

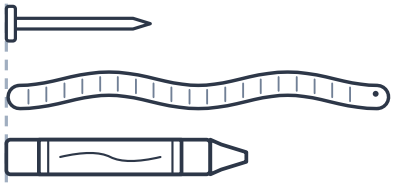

I can order things by length.

Name _____ **Exit Ticket 8.2**

1. Write 1, 2, 3 from shortest to longest.

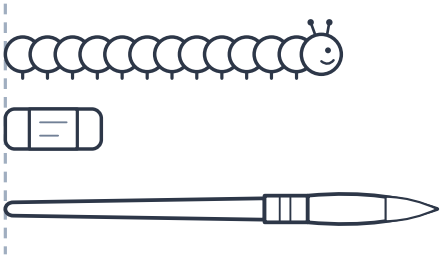

2. Circle the longest one.

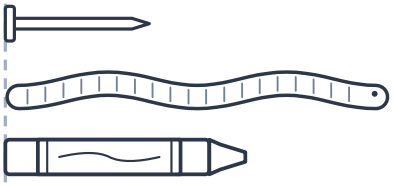

I can order things by length.

© 2026 Eggroll Games

Measuring Length

Exit Ticket 8.3: Compare two lengths using a third

Name _____ **Exit Ticket 8.3**

1. Use the string. Which is longer?

nail **marker**

2. Use the string. Which is shorter?

crayon **worm**

I can use a string to compare two lengths.

Name _____ **Exit Ticket 8.3**

1. Use the string. Which is longer?

nail **marker**

2. Use the string. Which is shorter?

crayon **worm**

I can use a string to compare two lengths.

Name _____ **Exit Ticket 8.3**

1. Use the string. Which is longer?

nail **marker**

2. Use the string. Which is shorter?

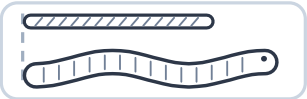

crayon **worm**

I can use a string to compare two lengths.

Name _____ **Exit Ticket 8.3**

1. Use the string. Which is longer?

nail **marker**

2. Use the string. Which is shorter?

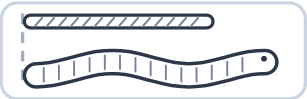

crayon **worm**

I can use a string to compare two lengths.

ANIMAL MATH

Find worksheets, teacher tools, and more at animalmath.com

© 2026 Eggroll Games

Measuring Length

Exit Ticket 8.4: Same-size units, no gaps, no overlaps

Name _____ **Exit Ticket 8.4**

1. Circle the right way to measure.

A

B

C

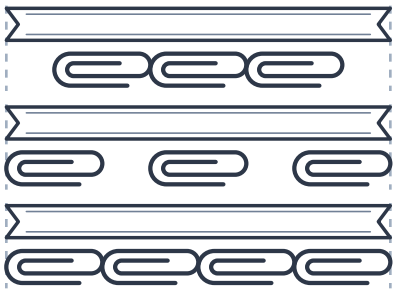

2. This is not right. What is wrong?

gaps overlaps

I can measure with no gaps and no overlaps.

Name _____ **Exit Ticket 8.4**

1. Circle the right way to measure.

A

B

C

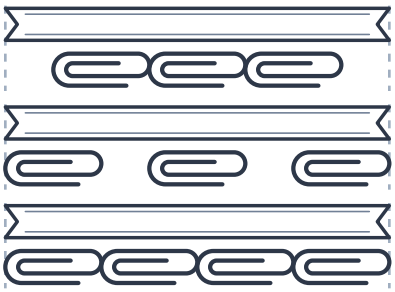

2. This is not right. What is wrong?

gaps overlaps

I can measure with no gaps and no overlaps.

Name _____ **Exit Ticket 8.4**

1. Circle the right way to measure.

A

B

C

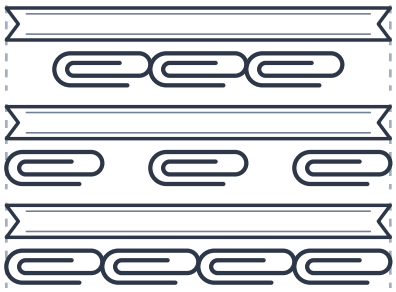

2. This is not right. What is wrong?

gaps overlaps

I can measure with no gaps and no overlaps.

Name _____ **Exit Ticket 8.4**

1. Circle the right way to measure.

A

B

C



2. This is not right. What is wrong?

gaps overlaps

I can measure with no gaps and no overlaps.

ANIMAL MATH

Find worksheets, teacher tools, and more at animalmath.com

© 2026 Eggroll Games

Measuring Length

Exit Ticket 8.5: Measure with cubes and paper clips

Name _____ **Exit Ticket 8.5**

1. How many cubes long is the worm?

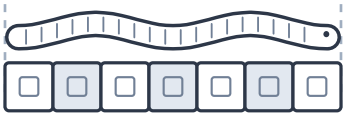

_____ **cubes**

2. How many paper clips long is the pencil?

_____ **paper clips**

I can measure with cubes and paper clips.

Name _____ **Exit Ticket 8.5**

1. How many cubes long is the worm?

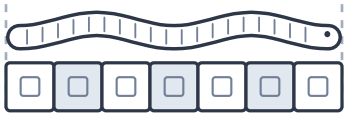

_____ **cubes**

2. How many paper clips long is the pencil?

_____ **paper clips**

I can measure with cubes and paper clips.

Name _____ **Exit Ticket 8.5**

1. How many cubes long is the worm?

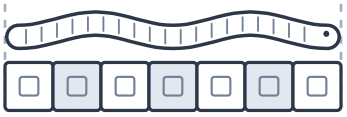

_____ **cubes**

2. How many paper clips long is the pencil?

_____ **paper clips**

I can measure with cubes and paper clips.

Name _____ **Exit Ticket 8.5**

1. How many cubes long is the worm?

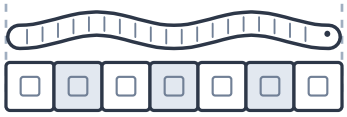

_____ **cubes**

2. How many paper clips long is the pencil?

_____ **paper clips**

I can measure with cubes and paper clips.

ANIMAL MATH

Find worksheets, teacher tools, and more at animalmath.com

© 2026 Eggroll Games

Measuring Length

Exit Ticket 8.6: Bigger unit, smaller count

Name _____ **Exit Ticket 8.6**

1. Write both lengths. Circle the unit you needed more of.

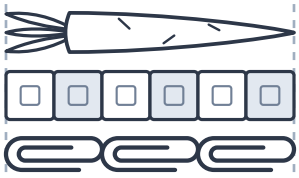

_____ cubes

_____ clips

I needed more **cubes** **clips**

2. To measure a shoe, which do you need fewer of?

cubes paper clips

I can tell that a bigger unit gives a smaller count.

Name _____ **Exit Ticket 8.6**

1. Write both lengths. Circle the unit you needed more of.

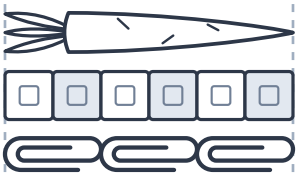

_____ cubes

_____ clips

I needed more **cubes** **clips**

2. To measure a shoe, which do you need fewer of?

cubes paper clips

I can tell that a bigger unit gives a smaller count.

Name _____ **Exit Ticket 8.6**

1. Write both lengths. Circle the unit you needed more of.

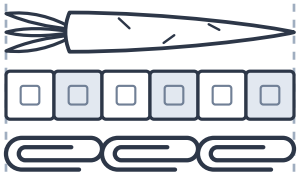

_____ cubes

_____ clips

I needed more **cubes** **clips**

2. To measure a shoe, which do you need fewer of?

cubes paper clips

I can tell that a bigger unit gives a smaller count.

Name _____ **Exit Ticket 8.6**

1. Write both lengths. Circle the unit you needed more of.

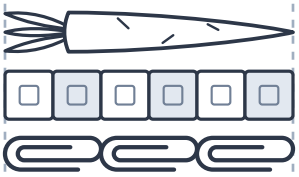

_____ cubes

_____ clips

I needed more **cubes** **clips**

2. To measure a shoe, which do you need fewer of?

cubes paper clips

I can tell that a bigger unit gives a smaller count.

ANIMAL MATH

Find worksheets, teacher tools, and more at animalmath.com

© 2026 Eggroll Games

Measuring Length

Exit Ticket 8.7: Measure with an inch ruler

Name _____ **Exit Ticket 8.7**

1. How many inches long is the leaf?

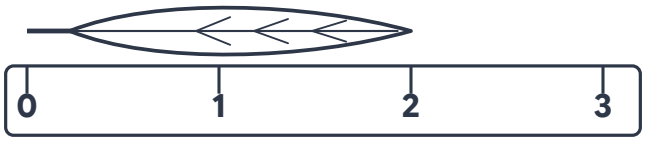

_____ **inches**

2. How many inches long is the key?



_____ **inches**

I can measure with an inch ruler. ☺ 😐 ☹

Name _____ **Exit Ticket 8.7**

1. How many inches long is the leaf?

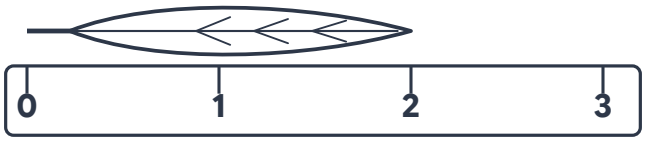

_____ **inches**

2. How many inches long is the key?



_____ **inches**

I can measure with an inch ruler. ☺ 😐 ☹

Name _____ **Exit Ticket 8.7**

1. How many inches long is the leaf?

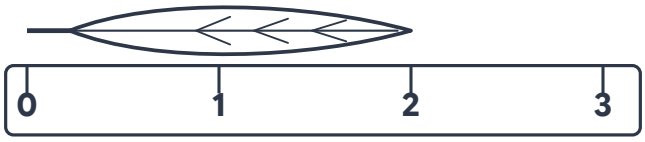

_____ **inches**

2. How many inches long is the key?

_____ **inches**

I can measure with an inch ruler. ☺ 😐 ☹

Name _____ **Exit Ticket 8.7**

1. How many inches long is the leaf?

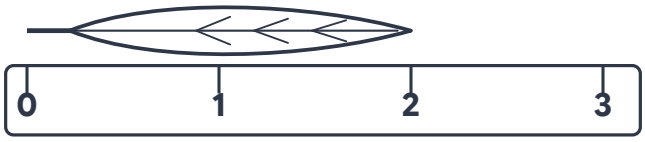

_____ **inches**

2. How many inches long is the key?

_____ **inches**

I can measure with an inch ruler. ☺ 😐 ☹

© 2026 Eggroll Games

Measuring Length

Exit Ticket 8.8: Compare weight and capacity

Name _____ **Exit Ticket 8.8**

1. Circle the heavier one.

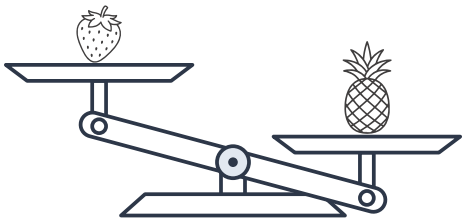

2. Circle the one that holds more.

pitcher

cup

I can tell which is heavier and which holds more.

Name _____ **Exit Ticket 8.8**

1. Circle the heavier one.

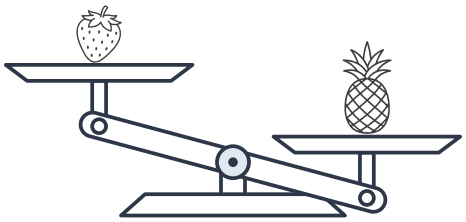

2. Circle the one that holds more.

pitcher

cup

I can tell which is heavier and which holds more.

Name _____ **Exit Ticket 8.8**

1. Circle the heavier one.

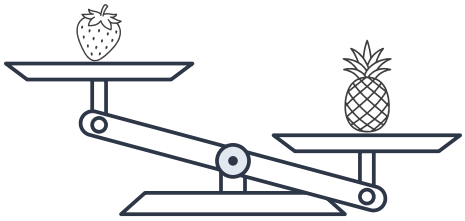

2. Circle the one that holds more.

pitcher

cup

I can tell which is heavier and which holds more.

Name _____ **Exit Ticket 8.8**

1. Circle the heavier one.

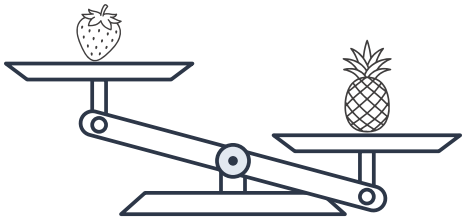

2. Circle the one that holds more.

pitcher

cup

I can tell which is heavier and which holds more.

© 2026 Eggroll Games

ANSWER KEY

Measuring Length

Exit Ticket 8.1: Longer and shorter

Name _____ **Exit Ticket 8.1**

1. Circle the longer one.

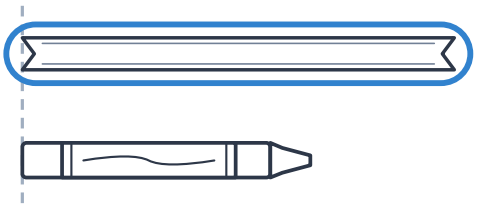

2. Circle the shorter one.

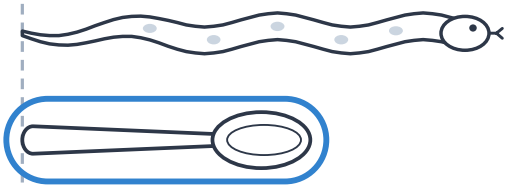

I can tell which one is longer or shorter.

Name _____ **Exit Ticket 8.1**

1. Circle the longer one.

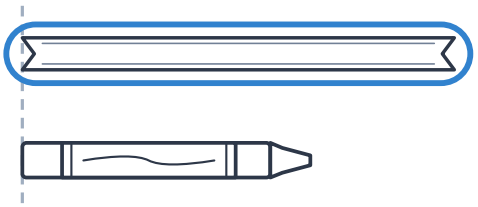

2. Circle the shorter one.

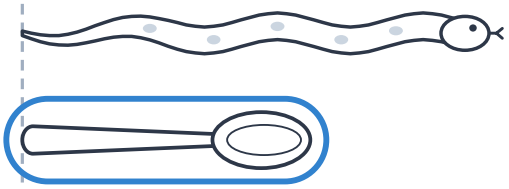

I can tell which one is longer or shorter.

Name _____ **Exit Ticket 8.1**

1. Circle the longer one.

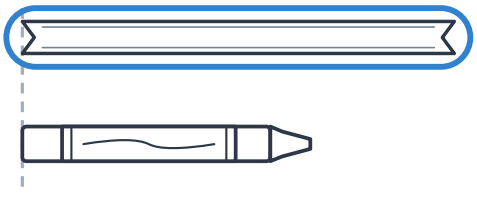

2. Circle the shorter one.

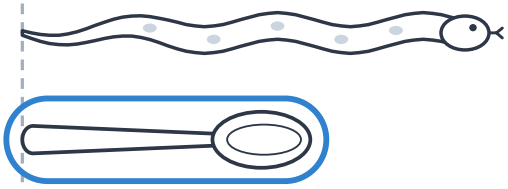

I can tell which one is longer or shorter.

Name _____ **Exit Ticket 8.1**

1. Circle the longer one.

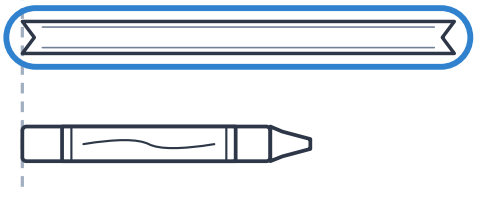

2. Circle the shorter one.

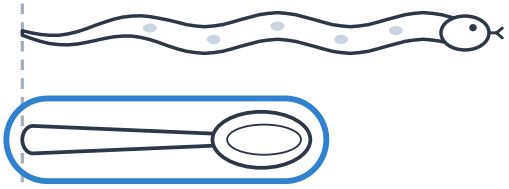

I can tell which one is longer or shorter.

© 2026 Eggroll Games

ANSWER KEY

Measuring Length

Exit Ticket 8.2: Order three things by length

Name _____ **Exit Ticket 8.2**

1. Write 1, 2, 3 from shortest to longest.

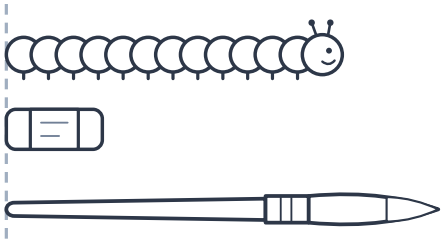

2
1
3

2. Circle the longest one.

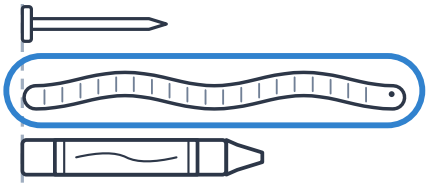

I can order things by length.

Name _____ **Exit Ticket 8.2**

1. Write 1, 2, 3 from shortest to longest.

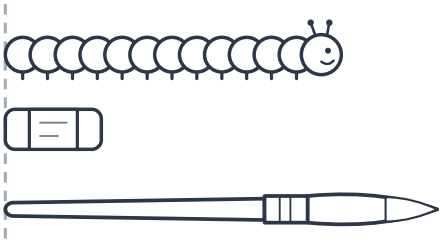

2
1
3

2. Circle the longest one.

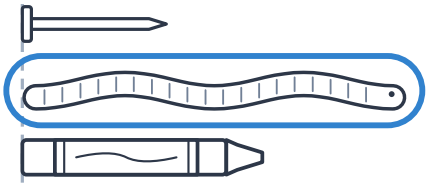

I can order things by length.

Name _____ **Exit Ticket 8.2**

1. Write 1, 2, 3 from shortest to longest.

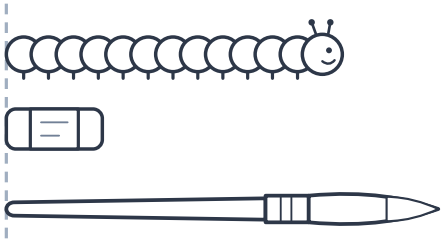

2
1
3

2. Circle the longest one.

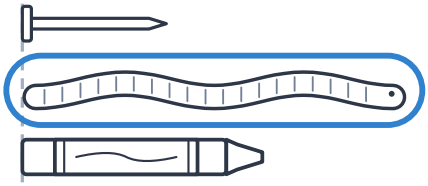

I can order things by length.

Name _____ **Exit Ticket 8.2**

1. Write 1, 2, 3 from shortest to longest.

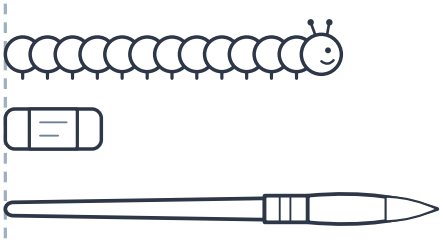

2
1
3

2. Circle the longest one.

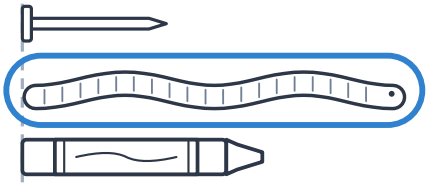

I can order things by length.

ANIMAL MATH

Find worksheets, teacher tools, and more at animalmath.com

© 2026 Eggroll Games

Measuring Length

Exit Ticket 8.3: Compare two lengths using a third

Name _____ **Exit Ticket 8.3**

1. Use the string. Which is longer?

nail **marker**

2. Use the string. Which is shorter?

crayon worm

I can use a string to compare two lengths.

Name _____ **Exit Ticket 8.3**

1. Use the string. Which is longer?

nail **marker**

2. Use the string. Which is shorter?

crayon worm

I can use a string to compare two lengths.

Name _____ **Exit Ticket 8.3**

1. Use the string. Which is longer?

nail **marker**

2. Use the string. Which is shorter?

crayon worm

I can use a string to compare two lengths.

Name _____ **Exit Ticket 8.3**

1. Use the string. Which is longer?

nail **marker**

2. Use the string. Which is shorter?

crayon worm

I can use a string to compare two lengths.

© 2026 Eggroll Games

ANSWER KEY

Measuring Length

Exit Ticket 8.4: Same-size units, no gaps, no overlaps

Name _____ **Exit Ticket 8.4**

1. Circle the right way to measure.

A

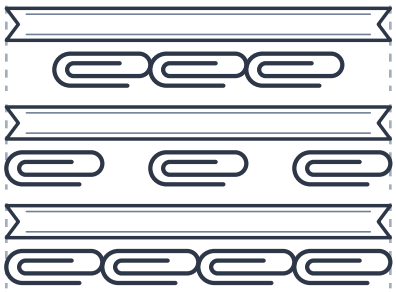

B

C

2. This is not right. What is wrong?

gaps **overlaps**

I can measure with no gaps and no overlaps.

Name _____ **Exit Ticket 8.4**

1. Circle the right way to measure.

A

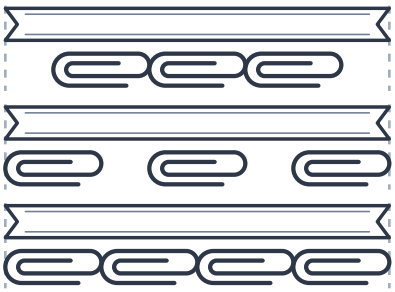

B

C

2. This is not right. What is wrong?

gaps **overlaps**

I can measure with no gaps and no overlaps.

Name _____ **Exit Ticket 8.4**

1. Circle the right way to measure.

A

B

C

2. This is not right. What is wrong?

gaps **overlaps**

I can measure with no gaps and no overlaps.

Name _____ **Exit Ticket 8.4**

1. Circle the right way to measure.

A

B

C

2. This is not right. What is wrong?

gaps **overlaps**

I can measure with no gaps and no overlaps.

ANIMAL MATH

Find worksheets, teacher tools, and more at animalmath.com

© 2026 Eggroll Games

Measuring Length

Exit Ticket 8.5: Measure with cubes and paper clips

Name _____ **Exit Ticket 8.5**

1. How many cubes long is the worm?

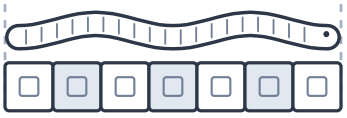

7 cubes

2. How many paper clips long is the pencil?

5 paper clips

I can measure with cubes and paper clips.

Name _____ **Exit Ticket 8.5**

1. How many cubes long is the worm?

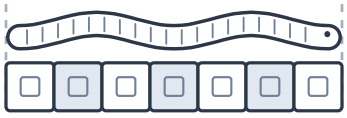

7 cubes

2. How many paper clips long is the pencil?

5 paper clips

I can measure with cubes and paper clips.

Name _____ **Exit Ticket 8.5**

1. How many cubes long is the worm?

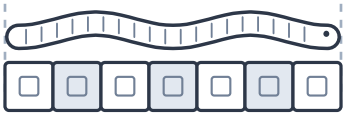

7 cubes

2. How many paper clips long is the pencil?

5 paper clips

I can measure with cubes and paper clips.

Name _____ **Exit Ticket 8.5**

1. How many cubes long is the worm?

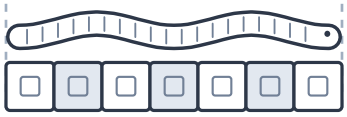

7 cubes

2. How many paper clips long is the pencil?

5 paper clips

I can measure with cubes and paper clips.

© 2026 Eggroll Games

Measuring Length

Exit Ticket 8.6: Bigger unit, smaller count

Name _____ **Exit Ticket 8.6**

1. Write both lengths. Circle the unit you needed more of.

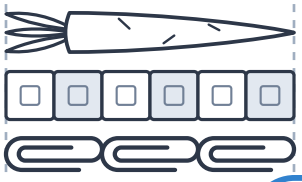

6 cubes

3 clips

I needed more **cubes** clips

2. To measure a shoe, which do you need fewer of?

cubes **paper clips**

I can tell that a bigger unit gives a smaller count.

Name _____ **Exit Ticket 8.6**

1. Write both lengths. Circle the unit you needed more of.

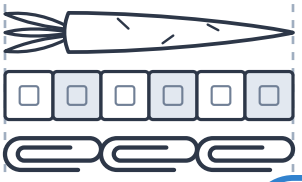

6 cubes

3 clips

I needed more **cubes** clips

2. To measure a shoe, which do you need fewer of?

cubes **paper clips**

I can tell that a bigger unit gives a smaller count.

Name _____ **Exit Ticket 8.6**

1. Write both lengths. Circle the unit you needed more of.

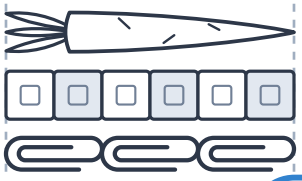

6 cubes

3 clips

I needed more **cubes** clips

2. To measure a shoe, which do you need fewer of?

cubes **paper clips**

I can tell that a bigger unit gives a smaller count.

Name _____ **Exit Ticket 8.6**

1. Write both lengths. Circle the unit you needed more of.

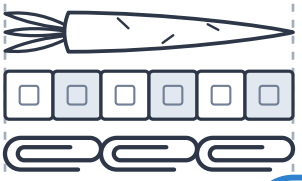

6 cubes

3 clips

I needed more **cubes** clips

2. To measure a shoe, which do you need fewer of?

cubes **paper clips**

I can tell that a bigger unit gives a smaller count.

© 2026 Eggroll Games

Measuring Length

Exit Ticket 8.7: Measure with an inch ruler

Name _____ **Exit Ticket 8.7**

1. How many inches long is the leaf?

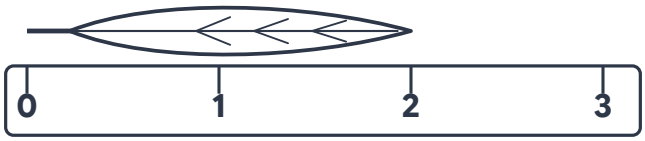

2 inches

2. How many inches long is the key?



3 inches

I can measure with an inch ruler.

Name _____ **Exit Ticket 8.7**

1. How many inches long is the leaf?

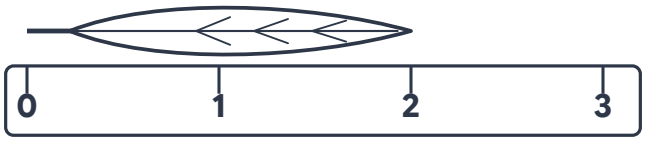

2 inches

2. How many inches long is the key?



3 inches

I can measure with an inch ruler.

Name _____ **Exit Ticket 8.7**

1. How many inches long is the leaf?

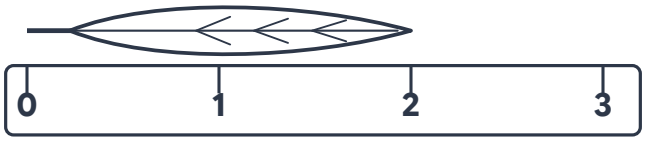

2 inches

2. How many inches long is the key?

3 inches

I can measure with an inch ruler.

Name _____ **Exit Ticket 8.7**

1. How many inches long is the leaf?

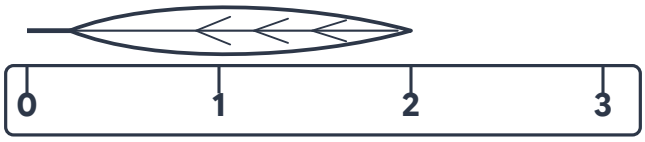

2 inches

2. How many inches long is the key?

3 inches

I can measure with an inch ruler.

© 2026 Eggroll Games

Measuring Length

Exit Ticket 8.8: Compare weight and capacity

Name _____ **Exit Ticket 8.8**

1. Circle the heavier one.

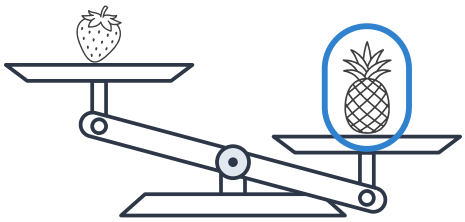

2. Circle the one that holds more.

pitcher

cup

I can tell which is heavier and which holds more.

Name _____ **Exit Ticket 8.8**

1. Circle the heavier one.

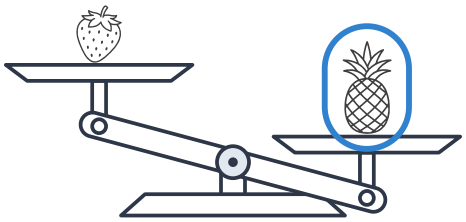

2. Circle the one that holds more.

pitcher

cup

I can tell which is heavier and which holds more.

Name _____ **Exit Ticket 8.8**

1. Circle the heavier one.

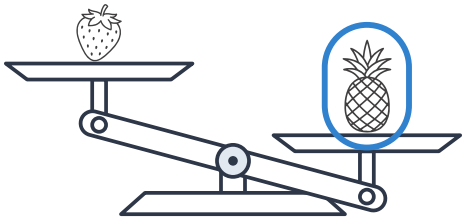

2. Circle the one that holds more.

pitcher

cup

I can tell which is heavier and which holds more.

Name _____ **Exit Ticket 8.8**

1. Circle the heavier one.

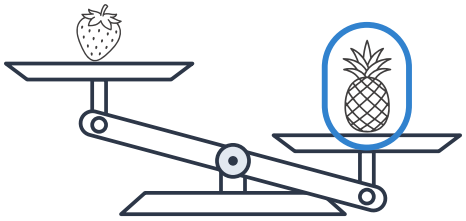

2. Circle the one that holds more.

pitcher

cup

I can tell which is heavier and which holds more.

© 2026 Eggroll Games