Adding to 20

Exit Ticket 4.1: Count on from the bigger number

Name _____ **Exit Ticket 4.1**

1. Circle the bigger number. Count on.

[ ] + 9 = ____

Count on: [ ] [ ]

2. Circle the bigger number. Then add.

3 + 14 = ____

I can count on from the bigger number. ☺ 😐 ☹

Name _____ **Exit Ticket 4.1**

1. Circle the bigger number. Count on.

[ ] + 9 = ____

Count on: [ ] [ ]

2. Circle the bigger number. Then add.

3 + 14 = ____

I can count on from the bigger number. ☺ 😐 ☹

Name _____ **Exit Ticket 4.1**

1. Circle the bigger number. Count on.

[ ] + 9 = ____

Count on: [ ] [ ]

2. Circle the bigger number. Then add.

3 + 14 = ____

I can count on from the bigger number. ☺ 😐 ☹

Name _____ **Exit Ticket 4.1**

1. Circle the bigger number. Count on.

[ ] + 9 = ____

Count on: [ ] [ ]

2. Circle the bigger number. Then add.

3 + 14 = ____

I can count on from the bigger number. ☺ 😐 ☹

© 2026 Eggroll Games

Adding to 20

Exit Ticket 4.2: Turn-around facts

Name _____ **Exit Ticket 4.2**

1. Write the turn-around fact.

8 + 3 = 11

_____ + _____ = _____

2. Circle the turn-around fact for **6 + 9**.

6 + 6 **9 + 6** **9 + 3**

3. You know **9 + 8 = 17**. Add **8 + 9**.

8 + 9 = _____

I can use turn-around facts. ☺ 😐 ☹

Name _____ **Exit Ticket 4.2**

1. Write the turn-around fact.

8 + 3 = 11

_____ + _____ = _____

2. Circle the turn-around fact for **6 + 9**.

6 + 6 **9 + 6** **9 + 3**

3. You know **9 + 8 = 17**. Add **8 + 9**.

8 + 9 = _____

I can use turn-around facts. ☺ 😐 ☹

Name _____ **Exit Ticket 4.2**

1. Write the turn-around fact.

8 + 3 = 11

_____ + _____ = _____

2. Circle the turn-around fact for **6 + 9**.

6 + 6 **9 + 6** **9 + 3**

3. You know **9 + 8 = 17**. Add **8 + 9**.

8 + 9 = _____

I can use turn-around facts. ☺ 😐 ☹

Name _____ **Exit Ticket 4.2**

1. Write the turn-around fact.

8 + 3 = 11

_____ + _____ = _____

2. Circle the turn-around fact for **6 + 9**.

6 + 6 **9 + 6** **9 + 3**

3. You know **9 + 8 = 17**. Add **8 + 9**.

8 + 9 = _____

I can use turn-around facts. ☺ 😐 ☹

© 2026 Eggroll Games

Adding to 20

Exit Ticket 4.3: Adding zero; is it true?

Name _____ **Exit Ticket 4.3**

1. Is it true? Circle True or False.

14 = 0 + 14 True False

16 + 0 = 17 True False

2. Write the missing numbers.

0 + 18 = ____

11 + ____ **= 11**

I can add zero and tell if a sentence is true.

Name _____ **Exit Ticket 4.3**

1. Is it true? Circle True or False.

14 = 0 + 14 True False

16 + 0 = 17 True False

2. Write the missing numbers.

0 + 18 = ____

11 + ____ **= 11**

I can add zero and tell if a sentence is true.

Name _____ **Exit Ticket 4.3**

1. Is it true? Circle True or False.

14 = 0 + 14 True False

16 + 0 = 17 True False

2. Write the missing numbers.

0 + 18 = ____

11 + ____ **= 11**

I can add zero and tell if a sentence is true.

Name _____ **Exit Ticket 4.3**

1. Is it true? Circle True or False.

14 = 0 + 14 True False

16 + 0 = 17 True False

2. Write the missing numbers.

0 + 18 = ____

11 + ____ **= 11**

I can add zero and tell if a sentence is true.

© 2026 Eggroll Games

Adding to 20

Exit Ticket 4.4: Doubles to 20

Name _____ **Exit Ticket 4.4**

1. Add the double.

6 + 6 = _____

2. Write a double for each sum.

_____ + _____ = 10

_____ + _____ = 20

I can add doubles to **20**.

Name _____ **Exit Ticket 4.4**

1. Add the double.

6 + 6 = _____

2. Write a double for each sum.

_____ + _____ = 10

_____ + _____ = 20

I can add doubles to **20**.

Name _____ **Exit Ticket 4.4**

1. Add the double.

6 + 6 = _____

2. Write a double for each sum.

_____ + _____ = 10

_____ + _____ = 20

I can add doubles to **20**.

Name _____ **Exit Ticket 4.4**

1. Add the double.

6 + 6 = _____

2. Write a double for each sum.

_____ + _____ = 10

_____ + _____ = 20

I can add doubles to **20**.

ANIMAL MATH

Find worksheets, teacher tools, and more at animalmath.com

© 2026 Eggroll Games

Adding to 20

Exit Ticket 4.5: Near doubles

Name _____ **Exit Ticket 4.5**

1. Use a double to help you add.

5 + 6 = _____

Double: _____ + _____ = _____

2. Circle the double that helps you add 9 + 10.

9 + 9 8 + 8 5 + 5

I can use a double to add a near double.

Name _____ **Exit Ticket 4.5**

1. Use a double to help you add.

5 + 6 = _____

Double: _____ + _____ = _____

2. Circle the double that helps you add 9 + 10.

9 + 9 8 + 8 5 + 5

I can use a double to add a near double.

Name _____ **Exit Ticket 4.5**

1. Use a double to help you add.

5 + 6 = _____

Double: _____ + _____ = _____

2. Circle the double that helps you add 9 + 10.

9 + 9 8 + 8 5 + 5

I can use a double to add a near double.

Name _____ **Exit Ticket 4.5**

1. Use a double to help you add.

5 + 6 = _____

Double: _____ + _____ = _____

2. Circle the double that helps you add 9 + 10.

9 + 9 8 + 8 5 + 5

I can use a double to add a near double.

ANIMAL MATH

Find worksheets, teacher tools, and more at animalmath.com

© 2026 Eggroll Games

Adding to 20

Exit Ticket 4.6: Make a ten to add

Name _____ **Exit Ticket 4.6**

1. Make a ten to add.

7 + 5 = _____

7 + _____ = 10

10 + _____ = _____

2. Make a ten. Fill in the blanks.

9 + 7 = 10 + _____ = _____

I can make a ten to add.

Name _____ **Exit Ticket 4.6**

1. Make a ten to add.

7 + 5 = _____

7 + _____ = 10

10 + _____ = _____

2. Make a ten. Fill in the blanks.

9 + 7 = 10 + _____ = _____

I can make a ten to add.

Name _____ **Exit Ticket 4.6**

1. Make a ten to add.

7 + 5 = _____

7 + _____ = 10

10 + _____ = _____

2. Make a ten. Fill in the blanks.

9 + 7 = 10 + _____ = _____

I can make a ten to add.

Name _____ **Exit Ticket 4.6**

1. Make a ten to add.

7 + 5 = _____

7 + _____ = 10

10 + _____ = _____

2. Make a ten. Fill in the blanks.

9 + 7 = 10 + _____ = _____

I can make a ten to add.

© 2026 Eggroll Games

Adding to 20

Exit Ticket 4.7: Number bonds to 20

Name _____ **Exit Ticket 4.7**

1. Write the missing number in each number bond.

2. Write the missing part.

6 + _____ = 15

I can find the missing number in a number bond.

Name _____ **Exit Ticket 4.7**

1. Write the missing number in each number bond.

2. Write the missing part.

6 + _____ = 15

I can find the missing number in a number bond.

Name _____ **Exit Ticket 4.7**

1. Write the missing number in each number bond.

2. Write the missing part.

6 + _____ = 15

I can find the missing number in a number bond.

Name _____ **Exit Ticket 4.7**

1. Write the missing number in each number bond.

2. Write the missing part.

6 + _____ = 15

I can find the missing number in a number bond.

© 2026 Eggroll Games

Adding to 20

Exit Ticket 4.8: Add three numbers

Name _____ **Exit Ticket 4.8**

1. Circle the ten or double. Then add.

3 + 7 + 5 = ____

First ____ + ____ = ____

Then ____ + ____ = ____

2. Add the three dice.

+ + = ____

I can add three numbers. ☺ 😐 ☹

Name _____ **Exit Ticket 4.8**

1. Circle the ten or double. Then add.

3 + 7 + 5 = ____

First ____ + ____ = ____

Then ____ + ____ = ____

2. Add the three dice.

+ + = ____

I can add three numbers. ☺ 😐 ☹

Name _____ **Exit Ticket 4.8**

1. Circle the ten or double. Then add.

3 + 7 + 5 = ____

First ____ + ____ = ____

Then ____ + ____ = ____

2. Add the three dice.

+ + = ____

I can add three numbers. ☺ 😐 ☹

Name _____ **Exit Ticket 4.8**

1. Circle the ten or double. Then add.

3 + 7 + 5 = ____

First ____ + ____ = ____

Then ____ + ____ = ____

2. Add the three dice.

+ + = ____

I can add three numbers. ☺ 😐 ☹

ANIMAL MATH

Find worksheets, teacher tools, and more at animalmath.com

© 2026 Eggroll Games

Adding to 20

Exit Ticket 4.9: Ways to make 20

Name _____ **Exit Ticket 4.9**

1. Draw dots to make 20. Then write the missing numbers.

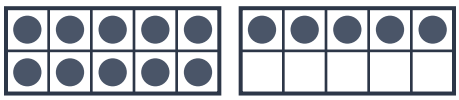

15 + ____ = 20

____ + 3 = 20

2. Circle 2 numbers that make 20.

2 13 18 5

I can find ways to make **20**.

Name _____ **Exit Ticket 4.9**

1. Draw dots to make 20. Then write the missing numbers.

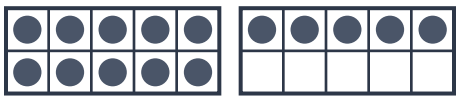

15 + ____ = 20

____ + 3 = 20

2. Circle 2 numbers that make 20.

2 13 18 5

I can find ways to make **20**.

Name _____ **Exit Ticket 4.9**

1. Draw dots to make 20. Then write the missing numbers.

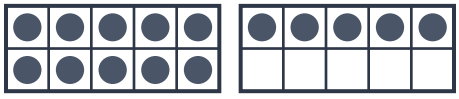

15 + ____ = 20

____ + 3 = 20

2. Circle 2 numbers that make 20.

2 13 18 5

I can find ways to make **20**.

Name _____ **Exit Ticket 4.9**

1. Draw dots to make 20. Then write the missing numbers.

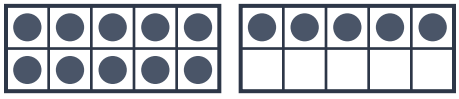

15 + ____ = 20

____ + 3 = 20

2. Circle 2 numbers that make 20.

2 13 18 5

I can find ways to make **20**.

ANIMAL MATH

Find worksheets, teacher tools, and more at animalmath.com

© 2026 Eggroll Games

Adding to 20

Exit Ticket 4.10: Addition facts to 20, fast

Name _____ **Exit Ticket 4.10**

1. Add.

9	8	7	15
+ 2	+ 4	+ 3	+ 4
___	___	___	___

2. Add.

6 + 8 = ___ 9 + 4 = ___

5 + 8 = ___ 3 + 9 = ___

I can add facts to **20** quickly. ☺ 😐 ☹

Name _____ **Exit Ticket 4.10**

1. Add.

9	8	7	15
+ 2	+ 4	+ 3	+ 4
___	___	___	___

2. Add.

6 + 8 = ___ 9 + 4 = ___

5 + 8 = ___ 3 + 9 = ___

I can add facts to **20** quickly. ☺ 😐 ☹

Name _____ **Exit Ticket 4.10**

1. Add.

9	8	7	15
+ 2	+ 4	+ 3	+ 4
___	___	___	___

2. Add.

6 + 8 = ___ 9 + 4 = ___

5 + 8 = ___ 3 + 9 = ___

I can add facts to **20** quickly. ☺ 😐 ☹

Name _____ **Exit Ticket 4.10**

1. Add.

9	8	7	15
+ 2	+ 4	+ 3	+ 4
___	___	___	___

2. Add.

6 + 8 = ___ 9 + 4 = ___

5 + 8 = ___ 3 + 9 = ___

I can add facts to **20** quickly. ☺ 😐 ☹

© 2026 Eggroll Games

Adding to 20

Exit Ticket 4.11: Adding the same number again

Name _____ **Exit Ticket 4.11**

1. Add 6 to each number.

	8	9	4	12
+ 6	↓	↓	↓	↓

2. Add 8.

4 + 8 = ____ 8 + 8 = ____

I can add the same number to many numbers. ☺ 😐 ☹

Name _____ **Exit Ticket 4.11**

1. Add 6 to each number.

	8	9	4	12
+ 6	↓	↓	↓	↓

2. Add 8.

4 + 8 = ____ 8 + 8 = ____

I can add the same number to many numbers. ☺ 😐 ☹

Name _____ **Exit Ticket 4.11**

1. Add 6 to each number.

	8	9	4	12
+ 6	↓	↓	↓	↓

2. Add 8.

4 + 8 = ____ 8 + 8 = ____

I can add the same number to many numbers. ☺ 😐 ☹

Name _____ **Exit Ticket 4.11**

1. Add 6 to each number.

	8	9	4	12
+ 6	↓	↓	↓	↓

2. Add 8.

4 + 8 = ____ 8 + 8 = ____

I can add the same number to many numbers. ☺ 😐 ☹

© 2026 Eggroll Games

Adding to 20

Exit Ticket 4.12: Puzzles and games

Name _____ **Exit Ticket 4.12**

1. **Fill in the boxes. Each row and column adds up to its number.**

	9	15
8		12
14	13	

2. **I am 5 more than 9. What am I?**

I am _____

I can solve number puzzles. ☺ 😐 ☹

Name _____ **Exit Ticket 4.12**

1. **Fill in the boxes. Each row and column adds up to its number.**

	9	15
8		12
14	13	

2. **I am 5 more than 9. What am I?**

I am _____

I can solve number puzzles. ☺ 😐 ☹

Name _____ **Exit Ticket 4.12**

1. **Fill in the boxes. Each row and column adds up to its number.**

	9	15
8		12
14	13	

2. **I am 5 more than 9. What am I?**

I am _____

I can solve number puzzles. ☺ 😐 ☹

Name _____ **Exit Ticket 4.12**

1. **Fill in the boxes. Each row and column adds up to its number.**

	9	15
8		12
14	13	

2. **I am 5 more than 9. What am I?**

I am _____

I can solve number puzzles. ☺ 😐 ☹

© 2026 Eggroll Games

ANSWER KEY

Adding to 20

Exit Ticket 4.1: Count on from the bigger number

Name _____ **Exit Ticket 4.1**

1. Circle the bigger number. Count on.

Count on: 10 11

2. Circle the bigger number. Then add.

3 + 14 = 17

I can count on from the bigger number.

Name _____ **Exit Ticket 4.1**

1. Circle the bigger number. Count on.

Count on: 10 11

2. Circle the bigger number. Then add.

3 + 14 = 17

I can count on from the bigger number.

Name _____ **Exit Ticket 4.1**

1. Circle the bigger number. Count on.

Count on: 10 11

2. Circle the bigger number. Then add.

3 + 14 = 17

I can count on from the bigger number.

Name _____ **Exit Ticket 4.1**

1. Circle the bigger number. Count on.

Count on: 10 11

2. Circle the bigger number. Then add.

3 + 14 = 17

I can count on from the bigger number.

ANIMAL MATH

Find worksheets, teacher tools, and more at animalmath.com

© 2026 Eggroll Games

Adding to 20

Exit Ticket 4.2: Turn-around facts

Name _____ **Exit Ticket 4.2**

1. Write the turn-around fact.

8 + 3 = 11

3 + 8 = 11

2. Circle the turn-around fact for 6 + 9.

6 + 6 (9 + 6) 9 + 3

3. You know 9 + 8 = 17. Add 8 + 9.

8 + 9 = 17

I can use turn-around facts.

Name _____ **Exit Ticket 4.2**

1. Write the turn-around fact.

8 + 3 = 11

3 + 8 = 11

2. Circle the turn-around fact for 6 + 9.

6 + 6 (9 + 6) 9 + 3

3. You know 9 + 8 = 17. Add 8 + 9.

8 + 9 = 17

I can use turn-around facts.

Name _____ **Exit Ticket 4.2**

1. Write the turn-around fact.

8 + 3 = 11

3 + 8 = 11

2. Circle the turn-around fact for 6 + 9.

6 + 6 (9 + 6) 9 + 3

3. You know 9 + 8 = 17. Add 8 + 9.

8 + 9 = 17

I can use turn-around facts.

Name _____ **Exit Ticket 4.2**

1. Write the turn-around fact.

8 + 3 = 11

3 + 8 = 11

2. Circle the turn-around fact for 6 + 9.

6 + 6 (9 + 6) 9 + 3

3. You know 9 + 8 = 17. Add 8 + 9.

8 + 9 = 17

I can use turn-around facts.

ANIMAL MATH

Find worksheets, teacher tools, and more at animalmath.com

© 2026 Eggroll Games

Adding to 20

Exit Ticket 4.3: Adding zero; is it true?

Name _____ **Exit Ticket 4.3**

1. Is it true? Circle True or False.

14 = 0 + 14 (True) False

16 + 0 = 17 True (False)

2. Write the missing numbers.

0 + 18 = 18

11 + 0 = 11

I can add zero and tell if a sentence is true.

Name _____ **Exit Ticket 4.3**

1. Is it true? Circle True or False.

14 = 0 + 14 (True) False

16 + 0 = 17 True (False)

2. Write the missing numbers.

0 + 18 = 18

11 + 0 = 11

I can add zero and tell if a sentence is true.

Name _____ **Exit Ticket 4.3**

1. Is it true? Circle True or False.

14 = 0 + 14 (True) False

16 + 0 = 17 True (False)

2. Write the missing numbers.

0 + 18 = 18

11 + 0 = 11

I can add zero and tell if a sentence is true.

Name _____ **Exit Ticket 4.3**

1. Is it true? Circle True or False.

14 = 0 + 14 (True) False

16 + 0 = 17 True (False)

2. Write the missing numbers.

0 + 18 = 18

11 + 0 = 11

I can add zero and tell if a sentence is true.

© 2026 Eggroll Games

ANSWER KEY

Adding to 20

Exit Ticket 4.4: Doubles to 20

Name _____ **Exit Ticket 4.4**

1. Add the double.

6 + 6 = 12

2. Write a double for each sum.

5 + 5 = 10

10 + 10 = 20

I can add doubles to **20**.

Name _____ **Exit Ticket 4.4**

1. Add the double.

6 + 6 = 12

2. Write a double for each sum.

5 + 5 = 10

10 + 10 = 20

I can add doubles to **20**.

Name _____ **Exit Ticket 4.4**

1. Add the double.

6 + 6 = 12

2. Write a double for each sum.

5 + 5 = 10

10 + 10 = 20

I can add doubles to **20**.

Name _____ **Exit Ticket 4.4**

1. Add the double.

6 + 6 = 12

2. Write a double for each sum.

5 + 5 = 10

10 + 10 = 20

I can add doubles to **20**.

© 2026 Eggroll Games

Adding to 20

Exit Ticket 4.5: Near doubles

Name _____ **Exit Ticket 4.5**

1. Use a double to help you add.

5 + 6 = 11

Double: 5 + 5 = 10

2. Circle the double that helps you add 9 + 10.

9 + 9 8 + 8 5 + 5

I can use a double to add a near double. ☺ 😐 ☹

Name _____ **Exit Ticket 4.5**

1. Use a double to help you add.

5 + 6 = 11

Double: 5 + 5 = 10

2. Circle the double that helps you add 9 + 10.

9 + 9 8 + 8 5 + 5

I can use a double to add a near double. ☺ 😐 ☹

Name _____ **Exit Ticket 4.5**

1. Use a double to help you add.

5 + 6 = 11

Double: 5 + 5 = 10

2. Circle the double that helps you add 9 + 10.

9 + 9 8 + 8 5 + 5

I can use a double to add a near double. ☺ 😐 ☹

Name _____ **Exit Ticket 4.5**

1. Use a double to help you add.

5 + 6 = 11

Double: 5 + 5 = 10

2. Circle the double that helps you add 9 + 10.

9 + 9 8 + 8 5 + 5

I can use a double to add a near double. ☺ 😐 ☹

© 2026 Eggroll Games

Adding to 20

Exit Ticket 4.6: Make a ten to add

Name _____ **Exit Ticket 4.6**

1. Make a ten to add.

7 + 5 = 12

3 2

7 + 3 = 10

10 + 2 = 12

2. Make a ten. Fill in the blanks.

9 + 7 = 10 + 6 = 16

I can make a ten to add. ☺ 😐 ☹

Name _____ **Exit Ticket 4.6**

1. Make a ten to add.

7 + 5 = 12

3 2

7 + 3 = 10

10 + 2 = 12

2. Make a ten. Fill in the blanks.

9 + 7 = 10 + 6 = 16

I can make a ten to add. ☺ 😐 ☹

Name _____ **Exit Ticket 4.6**

1. Make a ten to add.

7 + 5 = 12

3 2

7 + 3 = 10

10 + 2 = 12

2. Make a ten. Fill in the blanks.

9 + 7 = 10 + 6 = 16

I can make a ten to add. ☺ 😐 ☹

Name _____ **Exit Ticket 4.6**

1. Make a ten to add.

7 + 5 = 12

3 2

7 + 3 = 10

10 + 2 = 12

2. Make a ten. Fill in the blanks.

9 + 7 = 10 + 6 = 16

I can make a ten to add. ☺ 😐 ☹

ANIMAL MATH

Find worksheets, teacher tools, and more at animalmath.com

© 2026 Eggroll Games

Adding to 20

Exit Ticket 4.7: Number bonds to 20

Name _____ **Exit Ticket 4.7**

1. Write the missing number in each number bond.

2. Write the missing part.

6 + 9 = 15

I can find the missing number in a number bond.

Name _____ **Exit Ticket 4.7**

1. Write the missing number in each number bond.

2. Write the missing part.

6 + 9 = 15

I can find the missing number in a number bond.

Name _____ **Exit Ticket 4.7**

1. Write the missing number in each number bond.

2. Write the missing part.

6 + 9 = 15

I can find the missing number in a number bond.

Name _____ **Exit Ticket 4.7**

1. Write the missing number in each number bond.

2. Write the missing part.

6 + 9 = 15

I can find the missing number in a number bond.

ANIMAL MATH

Find worksheets, teacher tools, and more at animalmath.com

© 2026 Eggroll Games

ANSWER KEY

Adding to 20

Exit Ticket 4.8: Add three numbers

Name _____ **Exit Ticket 4.8**

1. Circle the ten or double. Then add.

3 + 7 + 5 = 15

First 3 + 7 = 10

Then 10 + 5 = 15

2. Add the three dice.

= 12

I can add three numbers.

Name _____ **Exit Ticket 4.8**

1. Circle the ten or double. Then add.

3 + 7 + 5 = 15

First 3 + 7 = 10

Then 10 + 5 = 15

2. Add the three dice.

= 12

I can add three numbers.

Name _____ **Exit Ticket 4.8**

1. Circle the ten or double. Then add.

3 + 7 + 5 = 15

First 3 + 7 = 10

Then 10 + 5 = 15

2. Add the three dice.

= 12

I can add three numbers.

Name _____ **Exit Ticket 4.8**

1. Circle the ten or double. Then add.

3 + 7 + 5 = 15

First 3 + 7 = 10

Then 10 + 5 = 15

2. Add the three dice.

= 12

I can add three numbers.

ANIMAL MATH

Find worksheets, teacher tools, and more at animalmath.com

© 2026 Eggroll Games

Adding to 20

Exit Ticket 4.9: Ways to make 20

Name _____ **Exit Ticket 4.9**

1. Draw dots to make **20**. Then write the missing numbers.



15 + 5 = 20

17 + 3 = 20

2. Circle **2** numbers that make **20**.

2 **13** **18** **5**

I can find ways to make **20**.

Name _____ **Exit Ticket 4.9**

1. Draw dots to make **20**. Then write the missing numbers.



15 + 5 = 20

17 + 3 = 20

2. Circle **2** numbers that make **20**.

2 **13** **18** **5**

I can find ways to make **20**.

Name _____ **Exit Ticket 4.9**

1. Draw dots to make **20**. Then write the missing numbers.



15 + 5 = 20

17 + 3 = 20

2. Circle **2** numbers that make **20**.

2 **13** **18** **5**

I can find ways to make **20**.

Name _____ **Exit Ticket 4.9**

1. Draw dots to make **20**. Then write the missing numbers.



15 + 5 = 20

17 + 3 = 20

2. Circle **2** numbers that make **20**.

2 **13** **18** **5**

I can find ways to make **20**.

ANIMAL MATH

Find worksheets, teacher tools, and more at animalmath.com

© 2026 Eggroll Games

Adding to 20

Exit Ticket 4.10: Addition facts to 20, fast

Name _____ **Exit Ticket 4.10**

1. Add.

9	8	7	15
+ 2	+ 4	+ 3	+ 4
11	12	10	19

2. Add.

6 + 8 = 14 9 + 4 = 13

5 + 8 = 13 3 + 9 = 12

I can add facts to **20** quickly. ☺ 😐 ☹

Name _____ **Exit Ticket 4.10**

1. Add.

9	8	7	15
+ 2	+ 4	+ 3	+ 4
11	12	10	19

2. Add.

6 + 8 = 14 9 + 4 = 13

5 + 8 = 13 3 + 9 = 12

I can add facts to **20** quickly. ☺ 😐 ☹

Name _____ **Exit Ticket 4.10**

1. Add.

9	8	7	15
+ 2	+ 4	+ 3	+ 4
11	12	10	19

2. Add.

6 + 8 = 14 9 + 4 = 13

5 + 8 = 13 3 + 9 = 12

I can add facts to **20** quickly. ☺ 😐 ☹

Name _____ **Exit Ticket 4.10**

1. Add.

9	8	7	15
+ 2	+ 4	+ 3	+ 4
11	12	10	19

2. Add.

6 + 8 = 14 9 + 4 = 13

5 + 8 = 13 3 + 9 = 12

I can add facts to **20** quickly. ☺ 😐 ☹

© 2026 Eggroll Games

Adding to 20

Exit Ticket 4.11: Adding the same number again

Name _____ **Exit Ticket 4.11**

1. Add 6 to each number.

	8	9	4	12
+ 6	↓	↓	↓	↓
	14	15	10	18

2. Add 8.

4 + 8 = 12 8 + 8 = 16

I can add the same number to many numbers. ☺ 😐 ☹

Name _____ **Exit Ticket 4.11**

1. Add 6 to each number.

	8	9	4	12
+ 6	↓	↓	↓	↓
	14	15	10	18

2. Add 8.

4 + 8 = 12 8 + 8 = 16

I can add the same number to many numbers. ☺ 😐 ☹

Name _____ **Exit Ticket 4.11**

1. Add 6 to each number.

	8	9	4	12
+ 6	↓	↓	↓	↓
	14	15	10	18

2. Add 8.

4 + 8 = 12 8 + 8 = 16

I can add the same number to many numbers. ☺ 😐 ☹

Name _____ **Exit Ticket 4.11**

1. Add 6 to each number.

	8	9	4	12
+ 6	↓	↓	↓	↓
	14	15	10	18

2. Add 8.

4 + 8 = 12 8 + 8 = 16

I can add the same number to many numbers. ☺ 😐 ☹

© 2026 Eggroll Games

Adding to 20

Exit Ticket 4.12: Puzzles and games

Name _____ **Exit Ticket 4.12**

1. Fill in the boxes. Each row and column adds up to its number.

6	9	15
8	4	12
14	13	

2. I am 5 more than 9. What am I?

I am 14

I can solve number puzzles. ☺ 😐 ☹

Name _____ **Exit Ticket 4.12**

1. Fill in the boxes. Each row and column adds up to its number.

6	9	15
8	4	12
14	13	

2. I am 5 more than 9. What am I?

I am 14

I can solve number puzzles. ☺ 😐 ☹

Name _____ **Exit Ticket 4.12**

1. Fill in the boxes. Each row and column adds up to its number.

6	9	15
8	4	12
14	13	

2. I am 5 more than 9. What am I?

I am 14

I can solve number puzzles. ☺ 😐 ☹

Name _____ **Exit Ticket 4.12**

1. Fill in the boxes. Each row and column adds up to its number.

6	9	15
8	4	12
14	13	

2. I am 5 more than 9. What am I?

I am 14

I can solve number puzzles. ☺ 😐 ☹

© 2026 Eggroll Games