Within 100

Exit Ticket 9.1: 10 more and 10 less on a hundreds chart

Name _____ **Exit Ticket 9.1**

1. Fill in these hundreds chart pieces.

53	

28	

2. On the hundreds chart, which number is under 36? Circle it.

37 **46** **26**

I can find **10** more and **10** less on a chart.

Name _____ **Exit Ticket 9.1**

1. Fill in these hundreds chart pieces.

53	

28	

2. On the hundreds chart, which number is under 36? Circle it.

37 **46** **26**

I can find **10** more and **10** less on a chart.

Name _____ **Exit Ticket 9.1**

1. Fill in these hundreds chart pieces.

53	

28	

2. On the hundreds chart, which number is under 36? Circle it.

37 **46** **26**

I can find **10** more and **10** less on a chart.

Name _____ **Exit Ticket 9.1**

1. Fill in these hundreds chart pieces.

53	

28	

2. On the hundreds chart, which number is under 36? Circle it.

37 **46** **26**

I can find **10** more and **10** less on a chart.

ANIMAL MATH

Find worksheets, teacher tools, and more at animalmath.com

© 2026 Eggroll Games

Within 100

Exit Ticket 9.2: 10 more and 10 less in your head

Name _____ **Exit Ticket 9.2**

1. Write 10 less and 10 more.

10 less	Number	10 more
	56	
	89	

2. Circle the number 10 less than 73.

63 83 72

I can find 10 more and 10 less in my head.

Name _____ **Exit Ticket 9.2**

1. Write 10 less and 10 more.

10 less	Number	10 more
	56	
	89	

2. Circle the number 10 less than 73.

63 83 72

I can find 10 more and 10 less in my head.

Name _____ **Exit Ticket 9.2**

1. Write 10 less and 10 more.

10 less	Number	10 more
	56	
	89	

2. Circle the number 10 less than 73.

63 83 72

I can find 10 more and 10 less in my head.

Name _____ **Exit Ticket 9.2**

1. Write 10 less and 10 more.

10 less	Number	10 more
	56	
	89	

2. Circle the number 10 less than 73.

63 83 72

I can find 10 more and 10 less in my head.

ANIMAL MATH

Find worksheets, teacher tools, and more at animalmath.com

© 2026 Eggroll Games

Within 100

Exit Ticket 9.3: Add and subtract tens

Name _____ **Exit Ticket 9.3**

1. Cross out tens. Write the answer.

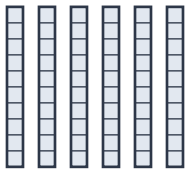

60 – 20 = _____

2. Add or subtract the tens.

20 + 70 = _____

80 – 30 = _____

I can add and subtract tens. ☺ 😐 ☹

Name _____ **Exit Ticket 9.3**

1. Cross out tens. Write the answer.

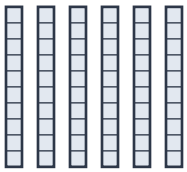

60 – 20 = _____

2. Add or subtract the tens.

20 + 70 = _____

80 – 30 = _____

I can add and subtract tens. ☺ 😐 ☹

Name _____ **Exit Ticket 9.3**

1. Cross out tens. Write the answer.

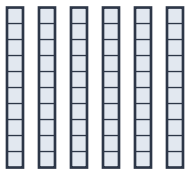

60 – 20 = _____

2. Add or subtract the tens.

20 + 70 = _____

80 – 30 = _____

I can add and subtract tens. ☺ 😐 ☹

Name _____ **Exit Ticket 9.3**

1. Cross out tens. Write the answer.

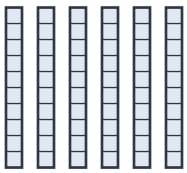

60 – 20 = _____

2. Add or subtract the tens.

20 + 70 = _____

80 – 30 = _____

I can add and subtract tens. ☺ 😐 ☹

© 2026 Eggroll Games

Within 100

Exit Ticket 9.4: Add tens to any number

Name _____ **Exit Ticket 9.4**

1. Add the tens. Write the sum.

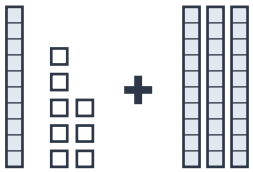

18 + 30 = _____

2. Add the tens. Write each sum.

56 + 20 = _____

30 + 61 = _____

I can add tens to any number. ☺ 😐 ☹

Name _____ **Exit Ticket 9.4**

1. Add the tens. Write the sum.

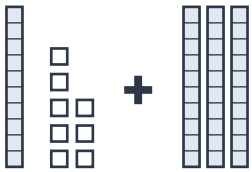

18 + 30 = _____

2. Add the tens. Write each sum.

56 + 20 = _____

30 + 61 = _____

I can add tens to any number. ☺ 😐 ☹

Name _____ **Exit Ticket 9.4**

1. Add the tens. Write the sum.

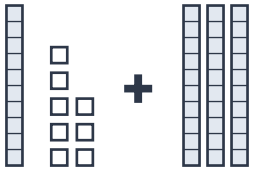

18 + 30 = _____

2. Add the tens. Write each sum.

56 + 20 = _____

30 + 61 = _____

I can add tens to any number. ☺ 😐 ☹

Name _____ **Exit Ticket 9.4**

1. Add the tens. Write the sum.

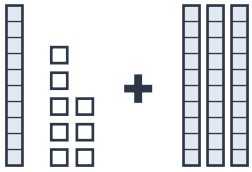

18 + 30 = _____

2. Add the tens. Write each sum.

56 + 20 = _____

30 + 61 = _____

I can add tens to any number. ☺ 😐 ☹

ANIMAL MATH

Find worksheets, teacher tools, and more at animalmath.com

© 2026 Eggroll Games

Within 100

Exit Ticket 9.5: Add a one-digit number, no new ten

Name _____ **Exit Ticket 9.5**

1. Add. Write each sum.

81 + 7 = _____

3 + 64 = _____

2. Circle the sum.

24 + 5 = 74 29 28

3. Write the missing number.

41 + _____ = 48

I can add ones with no new ten. ☺ 😐 ☹

Name _____ **Exit Ticket 9.5**

1. Add. Write each sum.

81 + 7 = _____

3 + 64 = _____

2. Circle the sum.

24 + 5 = 74 29 28

3. Write the missing number.

41 + _____ = 48

I can add ones with no new ten. ☺ 😐 ☹

Name _____ **Exit Ticket 9.5**

1. Add. Write each sum.

81 + 7 = _____

3 + 64 = _____

2. Circle the sum.

24 + 5 = 74 29 28

3. Write the missing number.

41 + _____ = 48

I can add ones with no new ten. ☺ 😐 ☹

Name _____ **Exit Ticket 9.5**

1. Add. Write each sum.

81 + 7 = _____

3 + 64 = _____

2. Circle the sum.

24 + 5 = 74 29 28

3. Write the missing number.

41 + _____ = 48

I can add ones with no new ten. ☺ 😐 ☹

© 2026 Eggroll Games

Within 100

Exit Ticket 9.6: Add a one-digit number, making a new ten

Name _____ **Exit Ticket 9.6**

1. Draw the new dots. Fill a ten first. Write the sum.

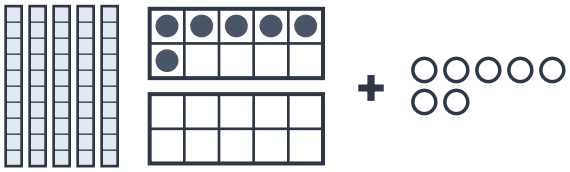

56 + 7 = _____

2. Circle the sum.

58 + 4 = 52 98 62

I can make a new ten to add.

Name _____ **Exit Ticket 9.6**

1. Draw the new dots. Fill a ten first. Write the sum.

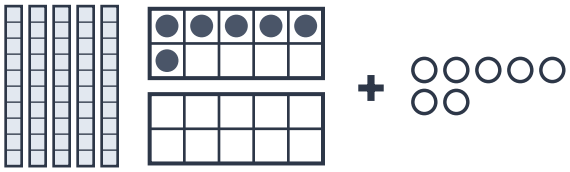

56 + 7 = _____

2. Circle the sum.

58 + 4 = 52 98 62

I can make a new ten to add.

Name _____ **Exit Ticket 9.6**

1. Draw the new dots. Fill a ten first. Write the sum.

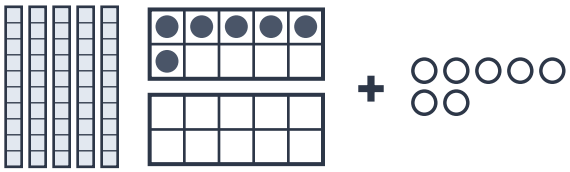

56 + 7 = _____

2. Circle the sum.

58 + 4 = 52 98 62

I can make a new ten to add.

Name _____ **Exit Ticket 9.6**

1. Draw the new dots. Fill a ten first. Write the sum.

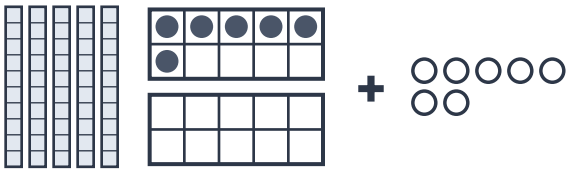

56 + 7 = _____

2. Circle the sum.

58 + 4 = 52 98 62

I can make a new ten to add.

© 2026 Eggroll Games

Within 100

Exit Ticket 9.7: Add with base-ten drawings

Name _____ **Exit Ticket 9.7**

1. Draw tens and ones to add.

62 + 4 = _____

2. What is the sum? Write it.

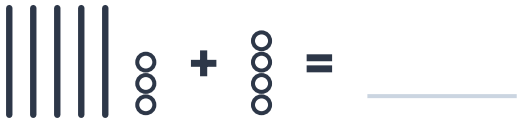

+ = _____

I can draw tens and ones to add.

Name _____ **Exit Ticket 9.7**

1. Draw tens and ones to add.

62 + 4 = _____

2. What is the sum? Write it.

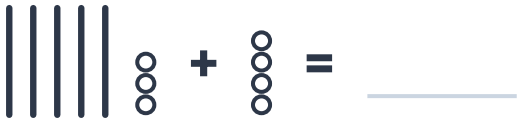

+ = _____

I can draw tens and ones to add.

Name _____ **Exit Ticket 9.7**

1. Draw tens and ones to add.

62 + 4 = _____

2. What is the sum? Write it.

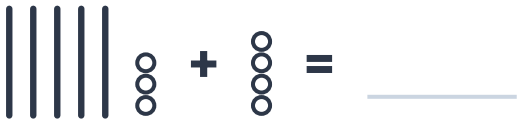

+ = _____

I can draw tens and ones to add.

Name _____ **Exit Ticket 9.7**

1. Draw tens and ones to add.

62 + 4 = _____

2. What is the sum? Write it.

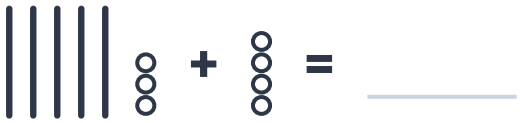

+ = _____

I can draw tens and ones to add.

ANIMAL MATH

Find worksheets, teacher tools, and more at animalmath.com

© 2026 Eggroll Games

Within 100

Exit Ticket 9.8: Add on a number line

Name _____ **Exit Ticket 9.8**

1. Hop to the next ten first.

65 + 8 = _____

2. Hop by tens. Write the sum.

24 + 30 = _____

I can add on a number line.

Name _____ **Exit Ticket 9.8**

1. Hop to the next ten first.

65 + 8 = _____

2. Hop by tens. Write the sum.

24 + 30 = _____

I can add on a number line.

Name _____ **Exit Ticket 9.8**

1. Hop to the next ten first.

65 + 8 = _____

2. Hop by tens. Write the sum.

24 + 30 = _____

I can add on a number line.

Name _____ **Exit Ticket 9.8**

1. Hop to the next ten first.

65 + 8 = _____

2. Hop by tens. Write the sum.

24 + 30 = _____

I can add on a number line.

ANIMAL MATH

Find worksheets, teacher tools, and more at animalmath.com

© 2026 Eggroll Games

Within 100

Exit Ticket 9.9: Subtract tens by breaking apart

Name _____ **Exit Ticket 9.9**

1. Break apart 58. Take away the tens.

58 – 30 = _____



_____ – 30 = _____

2. Circle the answer.

67 – 20 = 47 65 87

I can take away tens by breaking a number apart.

Name _____ **Exit Ticket 9.9**

1. Break apart 58. Take away the tens.

58 – 30 = _____



_____ – 30 = _____

2. Circle the answer.

67 – 20 = 47 65 87

I can take away tens by breaking a number apart.

Name _____ **Exit Ticket 9.9**

1. Break apart 58. Take away the tens.

58 – 30 = _____



_____ – 30 = _____

2. Circle the answer.

67 – 20 = 47 65 87

I can take away tens by breaking a number apart.

Name _____ **Exit Ticket 9.9**

1. Break apart 58. Take away the tens.

58 – 30 = _____



_____ – 30 = _____

2. Circle the answer.

67 – 20 = 47 65 87

I can take away tens by breaking a number apart.

© 2026 Eggroll Games

Within 100

Exit Ticket 9.10: Story problems within 100

Name _____ **Exit Ticket 9.10**

1. Owl has **39** pears. Owl picks **4** more. How many pears now?

Show your work.

_____ **pears**

2. Bear has **76** grapes. Bear eats **30**. How many grapes are left?

Show your work.

_____ **grapes**

I can solve story problems within **100**.

Name _____ **Exit Ticket 9.10**

1. Owl has **39** pears. Owl picks **4** more. How many pears now?

Show your work.

_____ **pears**

2. Bear has **76** grapes. Bear eats **30**. How many grapes are left?

Show your work.

_____ **grapes**

I can solve story problems within **100**.

Name _____ **Exit Ticket 9.10**

1. Owl has **39** pears. Owl picks **4** more. How many pears now?

Show your work.

_____ **pears**

2. Bear has **76** grapes. Bear eats **30**. How many grapes are left?

Show your work.

_____ **grapes**

I can solve story problems within **100**.

Name _____ **Exit Ticket 9.10**

1. Owl has **39** pears. Owl picks **4** more. How many pears now?

Show your work.

_____ **pears**

2. Bear has **76** grapes. Bear eats **30**. How many grapes are left?

Show your work.

_____ **grapes**

I can solve story problems within **100**.

© 2026 Eggroll Games

Within 100

Exit Ticket 9.11: Hundreds chart puzzles

Name _____ **Exit Ticket 9.11**

1. Fill in the hundreds chart piece.

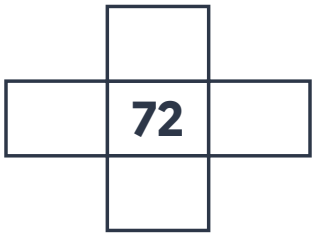

2. Fill in this piece too.

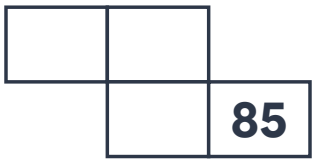

I can fill in pieces of the hundreds chart.

Name _____ **Exit Ticket 9.11**

1. Fill in the hundreds chart piece.

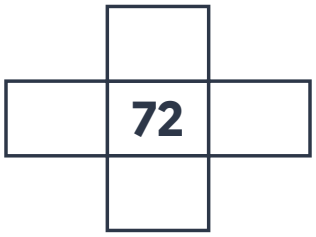

2. Fill in this piece too.

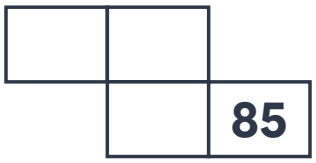

I can fill in pieces of the hundreds chart.

Name _____ **Exit Ticket 9.11**

1. Fill in the hundreds chart piece.

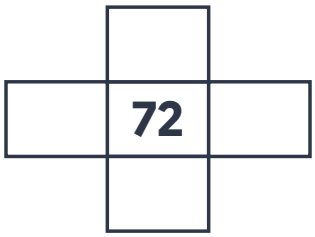

2. Fill in this piece too.

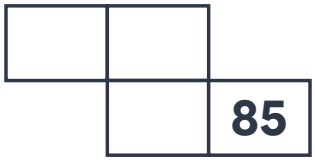

I can fill in pieces of the hundreds chart.

Name _____ **Exit Ticket 9.11**

1. Fill in the hundreds chart piece.

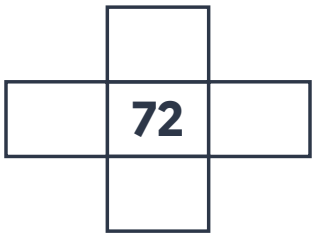

2. Fill in this piece too.

I can fill in pieces of the hundreds chart.

© 2026 Eggroll Games

Within 100

Exit Ticket 9.12: Explain how you added

Name _____ **Exit Ticket 9.12**

1. Who is right? Circle the animal.

35 + 8 = 43

35 + 8 = 33

2. Make a ten to add 28 + 6.

28 + _____ = _____

_____ + _____ = _____

I can explain how I added.

Name _____ **Exit Ticket 9.12**

1. Who is right? Circle the animal.

35 + 8 = 43

35 + 8 = 33

2. Make a ten to add 28 + 6.

28 + _____ = _____

_____ + _____ = _____

I can explain how I added.

Name _____ **Exit Ticket 9.12**

1. Who is right? Circle the animal.

35 + 8 = 43

35 + 8 = 33

2. Make a ten to add 28 + 6.

28 + _____ = _____

_____ + _____ = _____

I can explain how I added.

Name _____ **Exit Ticket 9.12**

1. Who is right? Circle the animal.

35 + 8 = 43

35 + 8 = 33

2. Make a ten to add 28 + 6.

28 + _____ = _____

_____ + _____ = _____

I can explain how I added.

ANIMAL MATH

Find worksheets, teacher tools, and more at animalmath.com

© 2026 Eggroll Games

ANSWER KEY

Within 100

Exit Ticket 9.1: 10 more and 10 less on a hundreds chart

Name _____ **Exit Ticket 9.1**

1. Fill in these hundreds chart pieces.

43	18
53	28
63	38

2. On the hundreds chart, which number is under 36? Circle it.

37 **46** 26

I can find 10 more and 10 less on a chart. ☺ 😐 ☹

Name _____ Exit Ticket 9.1

1. Fill in these hundreds chart pieces.

43	18
53	28
63	38

2. On the hundreds chart, which number is under 36? Circle it.

37 46 26

I can find 10 more and 10 less on a chart. ☺ 😐 ☹

Name _____ Exit Ticket 9.1

1. Fill in these hundreds chart pieces.

43	18
53	28
63	38

2. On the hundreds chart, which number is under 36? Circle it.

37 46 26

I can find 10 more and 10 less on a chart. ☺ 😐 ☹

Name _____ Exit Ticket 9.1

1. Fill in these hundreds chart pieces.

43	18
53	28
63	38

2. On the hundreds chart, which number is under 36? Circle it.

37 46 26

I can find 10 more and 10 less on a chart. ☺ 😐 ☹

ANIMAL MATH

Find worksheets, teacher tools, and more at animalmath.com

© 2026 Eggroll Games

Within 100

Exit Ticket 9.2: 10 more and 10 less in your head

Name _____ **Exit Ticket 9.2**

1. Write 10 less and 10 more.

10 less	Number	10 more
46	56	66
79	89	99

2. Circle the number 10 less than 73.

(63) 83 72

I can find 10 more and 10 less in my head. ☺ 😐 ☹

Name _____ **Exit Ticket 9.2**

1. Write 10 less and 10 more.

10 less	Number	10 more
46	56	66
79	89	99

2. Circle the number 10 less than 73.

(63) 83 72

I can find 10 more and 10 less in my head. ☺ 😐 ☹

Name _____ **Exit Ticket 9.2**

1. Write 10 less and 10 more.

10 less	Number	10 more
46	56	66
79	89	99

2. Circle the number 10 less than 73.

(63) 83 72

I can find 10 more and 10 less in my head. ☺ 😐 ☹

Name _____ **Exit Ticket 9.2**

1. Write 10 less and 10 more.

10 less	Number	10 more
46	56	66
79	89	99

2. Circle the number 10 less than 73.

(63) 83 72

I can find 10 more and 10 less in my head. ☺ 😐 ☹

© 2026 Eggroll Games

Within 100

Exit Ticket 9.3: Add and subtract tens

Name _____ **Exit Ticket 9.3**

1. Cross out tens. Write the answer.

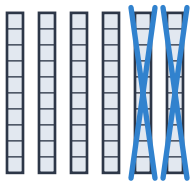

60 – 20 = 40

2. Add or subtract the tens.

20 + 70 = 90

80 – 30 = 50

I can add and subtract tens.

Name _____ **Exit Ticket 9.3**

1. Cross out tens. Write the answer.

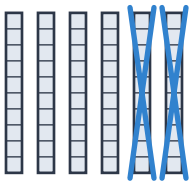

60 – 20 = 40

2. Add or subtract the tens.

20 + 70 = 90

80 – 30 = 50

I can add and subtract tens.

Name _____ **Exit Ticket 9.3**

1. Cross out tens. Write the answer.

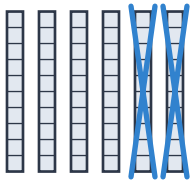

60 – 20 = 40

2. Add or subtract the tens.

20 + 70 = 90

80 – 30 = 50

I can add and subtract tens.

Name _____ **Exit Ticket 9.3**

1. Cross out tens. Write the answer.

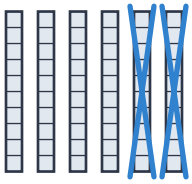

60 – 20 = 40

2. Add or subtract the tens.

20 + 70 = 90

80 – 30 = 50

I can add and subtract tens.

ANIMAL MATH

Find worksheets, teacher tools, and more at animalmath.com

© 2026 Eggroll Games

Within 100

Exit Ticket 9.4: Add tens to any number

Name _____ **Exit Ticket 9.4**

1. Add the tens. Write the sum.

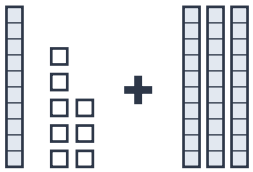

18 + 30 = 48

2. Add the tens. Write each sum.

56 + 20 = 76

30 + 61 = 91

I can add tens to any number. ☺ 😐 ☹

Name _____ **Exit Ticket 9.4**

1. Add the tens. Write the sum.

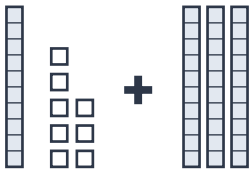

18 + 30 = 48

2. Add the tens. Write each sum.

56 + 20 = 76

30 + 61 = 91

I can add tens to any number. ☺ 😐 ☹

Name _____ **Exit Ticket 9.4**

1. Add the tens. Write the sum.

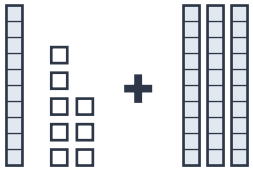

18 + 30 = 48

2. Add the tens. Write each sum.

56 + 20 = 76

30 + 61 = 91

I can add tens to any number. ☺ 😐 ☹

Name _____ **Exit Ticket 9.4**

1. Add the tens. Write the sum.

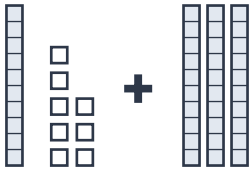

18 + 30 = 48

2. Add the tens. Write each sum.

56 + 20 = 76

30 + 61 = 91

I can add tens to any number. ☺ 😐 ☹

© 2026 Eggroll Games

Within 100

Exit Ticket 9.5: Add a one-digit number, no new ten

Name _____ **Exit Ticket 9.5**

1. Add. Write each sum.

81 + 7 = 88

3 + 64 = 67

2. Circle the sum.

24 + 5 = 74 (29) 28

3. Write the missing number.

41 + 7 = 48

I can add ones with no new ten. ☺ 😐 ☹

Name _____ Exit Ticket 9.5

1. Add. Write each sum.

81 + 7 = 88

3 + 64 = 67

2. Circle the sum.

24 + 5 = 74 (29) 28

3. Write the missing number.

41 + 7 = 48

I can add ones with no new ten. ☺ 😐 ☹

Name _____ Exit Ticket 9.5

1. Add. Write each sum.

81 + 7 = 88

3 + 64 = 67

2. Circle the sum.

24 + 5 = 74 (29) 28

3. Write the missing number.

41 + 7 = 48

I can add ones with no new ten. ☺ 😐 ☹

Name _____ Exit Ticket 9.5

1. Add. Write each sum.

81 + 7 = 88

3 + 64 = 67

2. Circle the sum.

24 + 5 = 74 (29) 28

3. Write the missing number.

41 + 7 = 48

I can add ones with no new ten. ☺ 😐 ☹

ANIMAL MATH

Find worksheets, teacher tools, and more at animalmath.com

© 2026 Eggroll Games

Within 100

Exit Ticket 9.6: Add a one-digit number, making a new ten

Name _____ **Exit Ticket 9.6**

1. Draw the new dots. Fill a ten first. Write the sum.

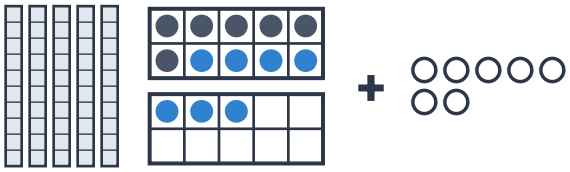

56 + 7 = 63

2. Circle the sum.

58 + 4 = 52 98 62

I can make a new ten to add.

Name _____ **Exit Ticket 9.6**

1. Draw the new dots. Fill a ten first. Write the sum.

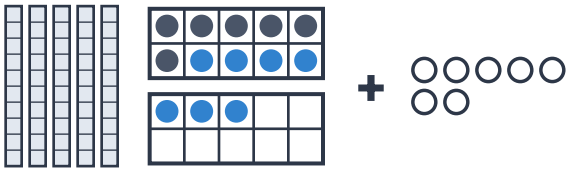

56 + 7 = 63

2. Circle the sum.

58 + 4 = 52 98 62

I can make a new ten to add.

Name _____ **Exit Ticket 9.6**

1. Draw the new dots. Fill a ten first. Write the sum.

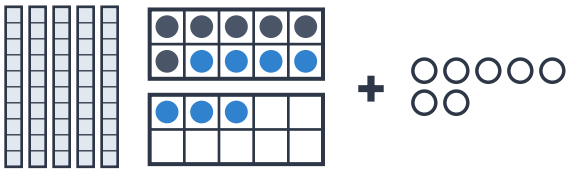

56 + 7 = 63

2. Circle the sum.

58 + 4 = 52 98 62

I can make a new ten to add.

Name _____ **Exit Ticket 9.6**

1. Draw the new dots. Fill a ten first. Write the sum.

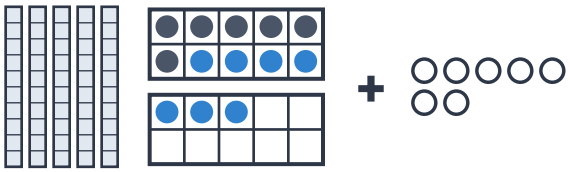

56 + 7 = 63

2. Circle the sum.

58 + 4 = 52 98 62

I can make a new ten to add.

© 2026 Eggroll Games

Within 100

Exit Ticket 9.7: Add with base-ten drawings

Name _____ **Exit Ticket 9.7**

1. Draw tens and ones to add.

62 + 4 = 66

2. What is the sum? Write it.

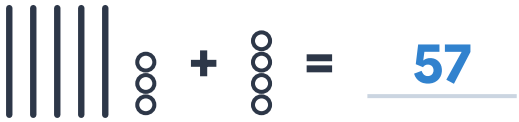

57

I can draw tens and ones to add.

Name _____ **Exit Ticket 9.7**

1. Draw tens and ones to add.

62 + 4 = 66

2. What is the sum? Write it.

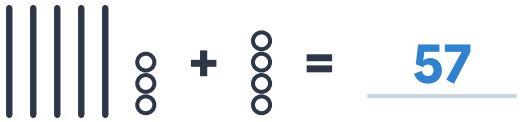

57

I can draw tens and ones to add.

Name _____ **Exit Ticket 9.7**

1. Draw tens and ones to add.

62 + 4 = 66

2. What is the sum? Write it.

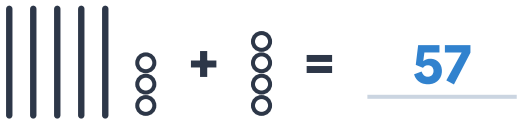

57

I can draw tens and ones to add.

Name _____ **Exit Ticket 9.7**

1. Draw tens and ones to add.

62 + 4 = 66

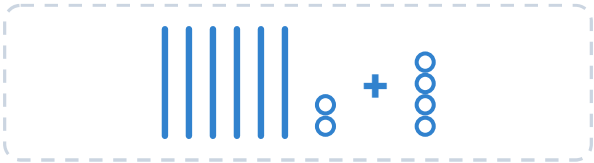

2. What is the sum? Write it.

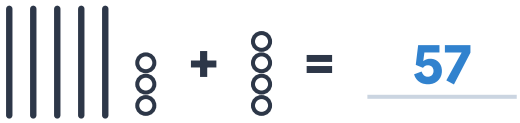

57

I can draw tens and ones to add.

© 2026 Eggroll Games

Within 100

Exit Ticket 9.8: Add on a number line

Name _____ **Exit Ticket 9.8**

1. Hop to the next ten first.

65 + 8 = 73

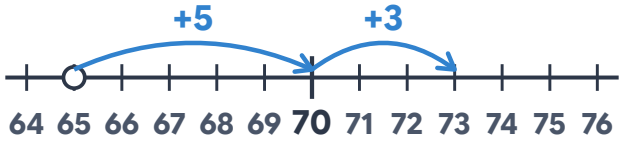

2. Hop by tens. Write the sum.

24 + 30 = 54

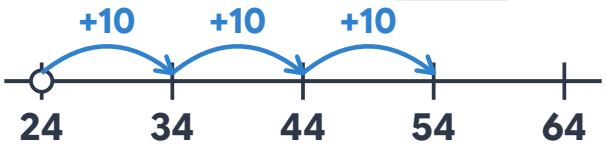

I can add on a number line.

Name _____ **Exit Ticket 9.8**

1. Hop to the next ten first.

65 + 8 = 73

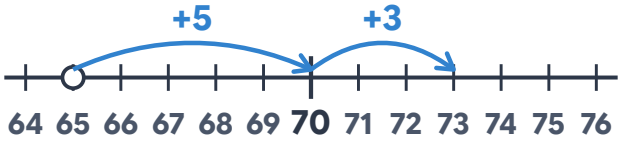

2. Hop by tens. Write the sum.

24 + 30 = 54

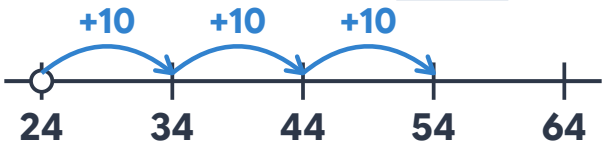

I can add on a number line.

Name _____ **Exit Ticket 9.8**

1. Hop to the next ten first.

65 + 8 = 73

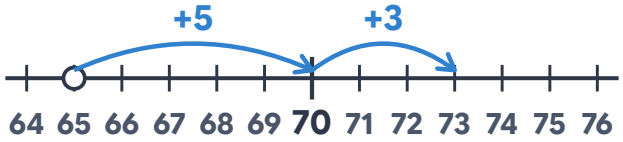

2. Hop by tens. Write the sum.

24 + 30 = 54

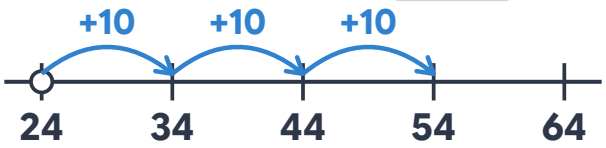

I can add on a number line.

Name _____ **Exit Ticket 9.8**

1. Hop to the next ten first.

65 + 8 = 73

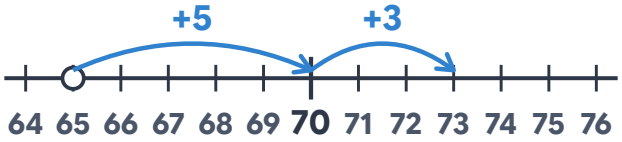

2. Hop by tens. Write the sum.

24 + 30 = 54

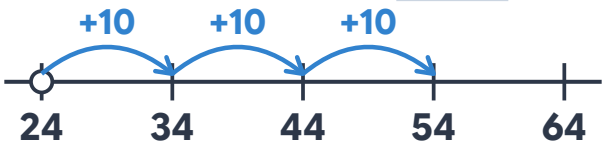

I can add on a number line.

© 2026 Eggroll Games

Within 100

Exit Ticket 9.9: Subtract tens by breaking apart

Name _____ **Exit Ticket 9.9**

1. Break apart **58**. Take away the tens.

58 – 30 = 28

50 8

50 – 30 = 20

2. Circle the answer.

67 – 20 = 47 65 87

I can take away tens by breaking a number apart.

Name _____ **Exit Ticket 9.9**

1. Break apart **58**. Take away the tens.

58 – 30 = 28

50 8

50 – 30 = 20

2. Circle the answer.

67 – 20 = 47 65 87

I can take away tens by breaking a number apart.

Name _____ **Exit Ticket 9.9**

1. Break apart **58**. Take away the tens.

58 – 30 = 28

50 8

50 – 30 = 20

2. Circle the answer.

67 – 20 = 47 65 87

I can take away tens by breaking a number apart.

Name _____ **Exit Ticket 9.9**

1. Break apart **58**. Take away the tens.

58 – 30 = 28

50 8

50 – 30 = 20

2. Circle the answer.

67 – 20 = 47 65 87

I can take away tens by breaking a number apart.

ANIMAL MATH

Find worksheets, teacher tools, and more at animalmath.com

© 2026 Eggroll Games

Within 100

Exit Ticket 9.10: Story problems within 100

Name _____ **Exit Ticket 9.10**

1. Owl has **39** pears. Owl picks **4** more. How many pears now?

Show your work.

39 + 4 = 43

43 pears

2. Bear has **76** grapes. Bear eats **30**. How many grapes are left?

Show your work.

76 − 30 = 46

46 grapes

I can solve story problems within **100**.

Name _____ **Exit Ticket 9.10**

1. Owl has **39** pears. Owl picks **4** more. How many pears now?

Show your work.

39 + 4 = 43

43 pears

2. Bear has **76** grapes. Bear eats **30**. How many grapes are left?

Show your work.

76 − 30 = 46

46 grapes

I can solve story problems within **100**.

Name _____ **Exit Ticket 9.10**

1. Owl has **39** pears. Owl picks **4** more. How many pears now?

Show your work.

39 + 4 = 43

43 pears

2. Bear has **76** grapes. Bear eats **30**. How many grapes are left?

Show your work.

76 − 30 = 46

46 grapes

I can solve story problems within **100**.

Name _____ **Exit Ticket 9.10**

1. Owl has **39** pears. Owl picks **4** more. How many pears now?

Show your work.

39 + 4 = 43

43 pears

2. Bear has **76** grapes. Bear eats **30**. How many grapes are left?

Show your work.

76 − 30 = 46

46 grapes

I can solve story problems within **100**.

© 2026 Eggroll Games

Within 100

Exit Ticket 9.11: Hundreds chart puzzles

Name _____ **Exit Ticket 9.11**

1. Fill in the hundreds chart piece.

	62	
71	72	73
	82	

2. Fill in this piece too.

73	74	
	84	85

I can fill in pieces of the hundreds chart.

Name _____ **Exit Ticket 9.11**

1. Fill in the hundreds chart piece.

	62	
71	72	73
	82	

2. Fill in this piece too.

73	74	
	84	85

I can fill in pieces of the hundreds chart.

Name _____ **Exit Ticket 9.11**

1. Fill in the hundreds chart piece.

	62	
71	72	73
	82	

2. Fill in this piece too.

73	74	
	84	85

I can fill in pieces of the hundreds chart.

Name _____ **Exit Ticket 9.11**

1. Fill in the hundreds chart piece.

	62	
71	72	73
	82	

2. Fill in this piece too.

73	74	
	84	85

I can fill in pieces of the hundreds chart.

© 2026 Eggroll Games

Within 100

Exit Ticket 9.12: Explain how you added

Name _____ **Exit Ticket 9.12**

1. Who is right? Circle the animal.

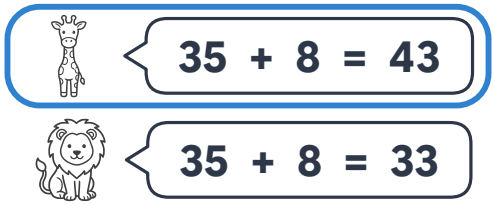

2. Make a ten to add 28 + 6.

28 + 2 = 30

30 + 4 = 34

I can explain how I added. ☺ 😐 ☹

Name _____ **Exit Ticket 9.12**

1. Who is right? Circle the animal.

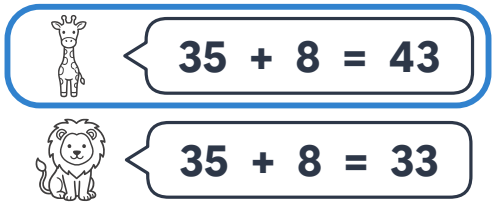

2. Make a ten to add 28 + 6.

28 + 2 = 30

30 + 4 = 34

I can explain how I added. ☺ 😐 ☹

Name _____ **Exit Ticket 9.12**

1. Who is right? Circle the animal.

2. Make a ten to add 28 + 6.

28 + 2 = 30

30 + 4 = 34

I can explain how I added. ☺ 😐 ☹

Name _____ **Exit Ticket 9.12**

1. Who is right? Circle the animal.

2. Make a ten to add 28 + 6.

28 + 2 = 30

30 + 4 = 34

I can explain how I added. ☺ 😐 ☹

ANIMAL MATH

Find worksheets, teacher tools, and more at animalmath.com

© 2026 Eggroll Games